Introductory Algebra 13th edition Bittinger Solutions Manual

SKU: 9780134689630-SOLUTIONS

Chapter 2

Solving Equations and Inequalities

Exercise Set 2.1

RC2. $2+3=5$ and $9-4=5$, so the equation $2+3=9-4$ is a true equation. Answer (a) is correct.

RC4. A replacement that makes an equation true is a solution of the equation. Answer (d) is correct.

CC2. The correct answer is (c).

CC4. The correct answer is (a).

2.
$$\begin{array}{r|l} t+17=53 & \\ \hline 35+17 \;?\; 53 & \\ 52 & \text{FALSE} \end{array}$$
35 is not a solution.

4.
$$\begin{array}{r|l} a-19=17 & \\ \hline 36-19 \;?\; 17 & \\ 17 & \text{TRUE} \end{array}$$
36 is a solution.

6.
$$\begin{array}{r|l} 8y=-72 & \\ \hline 8(-9) \;?\; -72 & \\ -72 & \text{TRUE} \end{array}$$
-9 is a solution.

8.
$$\begin{array}{r|l} \frac{y}{8}=6 & \\ \hline \frac{49}{8} \;?\; 6 & \\ 6\frac{1}{8} & \text{FALSE} \end{array}$$
49 is not a solution.

10.
$$\begin{array}{r|l} 9x+5=86 & \\ \hline 9\cdot 9+5 \;?\; 86 & \\ 86 & \text{TRUE} \end{array}$$
9 is a solution.

12.
$$\begin{array}{r|l} 6(y-2)=18 & \\ \hline 6(-5-2) \;?\; 18 & \\ 6(-7) & \\ -42 & \text{FALSE} \end{array}$$
-5 is not a solution.

14. 7

16. 34

18. -23

20. -31

22. 23

24. -11

26. 4

28. 25

30. -16

32. $24\frac{7}{10}$

34. 8.2

36. $\frac{1}{4}$

38.
$$\begin{aligned} x+\frac{2}{3} &= -\frac{5}{6} \\ x &= -\frac{5}{6}-\frac{4}{6}=-\frac{9}{6} \\ x &= -\frac{3}{2} \end{aligned}$$

40.
$$\begin{aligned} y-\frac{3}{4} &= \frac{5}{6} \\ y &= \frac{10}{12}+\frac{9}{12} \\ y &= \frac{19}{12} \end{aligned}$$

42.
$$\begin{aligned} -\frac{1}{8}+y &= -\frac{3}{4} \\ y &= -\frac{6}{8}+\frac{1}{8} \\ y &= -\frac{5}{8} \end{aligned}$$

44. 2.7

46. 16

48. -10.6

50.
$$\begin{aligned} 5\frac{1}{4} &= 4\frac{2}{3}+x \\ 5\frac{3}{12}-4\frac{8}{12} &= x \\ 4\frac{15}{12}-4\frac{8}{12} &= x \\ \frac{7}{12} &= x \end{aligned}$$

52. $136\frac{3}{8}$

54. -5.2

56. 172, 72

Copyright © 2019 Pearson Education, Inc.

Introductory Algebra 13th edition Bittinger Solutions Manual

58. $65t$ miles

60.
$$\begin{aligned} x + x &= x \\ 2x &= x \\ x &= 0 \end{aligned}$$

62.
$$\begin{aligned} x + 4 &= 5 + x \\ 4 &= 5 \end{aligned}$$
No solution

64.
$$\begin{aligned} |x| + 6 &= 19 \\ |x| + 6 - 6 &= 19 - 6 \\ |x| &= 13 \end{aligned}$$
x represents a number whose distance from 0 is 13. Thus $x = -13$ or $x = 13$.

The solutions are -13 and 13.

Exercise Set 2.2

RC2. Answer (c) is correct.

RC4. Answer (b) is correct.

CC2. The correct answer is (d).

CC4. The correct answer is (b).

2. 17

4. 9

6. 7

8. -53

10. 47

12. -7

14. -7

16. 8

18. -30

20. -88

22.
$$\begin{aligned} \frac{4}{5}x &= 16 \\ \frac{5}{4} \cdot \frac{4}{5}x &= \frac{5}{4} \cdot 16 \\ x &= 20 \end{aligned}$$

24.
$$\begin{aligned} -\frac{3}{8}x &= 12 \\ -\frac{8}{3}\left(-\frac{3}{8}x\right) &= -\frac{8}{3} \cdot 12 \\ x &= -32 \end{aligned}$$

26.
$$\begin{aligned} \frac{-x}{6} &= 9 \\ -x &= 54 \\ x &= -54 \end{aligned}$$

28.
$$\begin{aligned} \frac{1}{8} &= -\frac{y}{5} \\ \frac{5}{8} &= -y \\ -\frac{5}{8} &= y \end{aligned}$$

30.
$$\begin{aligned} \frac{2}{5}y &= -\frac{4}{15} \\ \frac{5}{2} \cdot \frac{2}{5}y &= \frac{5}{2} \cdot \left(-\frac{4}{15}\right) \\ y &= -\frac{20}{30} \\ y &= -\frac{2}{3} \end{aligned}$$

32.
$$\begin{aligned} -\frac{3}{8}x &= -\frac{15}{16} \\ -\frac{8}{3} \cdot \left(-\frac{3}{8}x\right) &= -\frac{8}{3} \cdot \left(-\frac{15}{16}\right) \\ x &= \frac{120}{48} \\ x &= \frac{5}{2} \end{aligned}$$

34. 20

36. -2

38. 8

40.
$$\begin{aligned} -\frac{9}{7}y &= 12.06 \\ -\frac{7}{9} \cdot \left(-\frac{9}{7}y\right) &= -\frac{7}{9} \cdot (12.06) \\ y &= -\frac{84.42}{9} \\ y &= -9.38 \end{aligned}$$

42.
$$\begin{aligned} \frac{-x}{8} &= -16 \\ 8\left(\frac{-x}{8}\right) &= 8 \cdot (-16) \\ -x &= -128 \\ -1 \cdot (-x) &= -1 \cdot (-128) \\ x &= 128 \end{aligned}$$

44.
$$\begin{aligned} \frac{m}{-3} &= 10 \\ -3 \cdot \left(\frac{m}{-3}\right) &= -3 \cdot 10 \\ m &= -30 \end{aligned}$$

46. $-x + 5$

48. $-32y$

50. $2 - 5(x + 5) = 2 - 5x - 25 = -5x - 23$

52. $-2a - 4(5a - 1) = -2a - 20a + 4 = -22a + 4$

54. $\frac{1}{2} \cdot b \cdot 10 \text{ m}^2$, or $5b \text{ m}^2$

56. All real numbers

Copyright © 2019 Pearson Education, Inc.

Introductory Algebra 13th edition Bittinger Solutions Manual

58. $4|x| = 48$
$|x| = 12$

The distance of x from 0 is 12. Thus, $x = 12$ or $x = -12$.

60. 5

62. $\dfrac{a^2+1}{c}$

64. To "undo" the last step, divide 22.5 by 0.3.

$22.5 \div 0.3 = 75$

Now divide 75 by 0.3.

$75 \div 0.3 = 250$

The answer should be 250 not 22.5.

Exercise Set 2.3

RC2. When solving equations, we may wish to clear fractions.

RC4. We use the multiplication principle when dividing both sides of an equation by -1.

CC2. The correct answer is (a).

CC4. The correct answer is (e).

2. $7x + 6 = 13$
$7x = 7$
$x = 1$

4. $4y + 10 = 46$
$4y = 36$
$y = 9$

6. $5y - 2 = 53$
$5y = 55$
$y = 11$

8. $4x - 19 = 5$
$4x = 24$
$x = 6$

10. $5x + 4 = -41$
$5x = -45$
$x = -9$

12. $-91 = 9t + 8$
$-99 = 9t$
$-11 = t$

14. $-5x - 7 = 108$
$-5x = 115$
$x = -23$

16. $\frac{3}{2}x - 24 = -36$
$\frac{3}{2}x = -12$
$\frac{2}{3} \cdot \frac{3}{2}x = \frac{2}{3}(-12)$
$x = -8$

18. $8x + 3x = 55$
$11x = 55$
$x = 5$

20. $8x + 5x = 104$
$13x = 104$
$x = 8$

22. $7x + 18x = 125$
$25x = 125$
$x = 5$

24. $-5y - 7y = 144$
$-12y = 144$
$y = -12$

26. $-10y - 3y = -39$
$-13y = -39$
$y = 3$

28. $x + \frac{1}{4}x = 10$
$\frac{5}{4}x = 10$
$x = \frac{4}{5} \cdot 10$
$x = 8$

30. $6.8y - 2.4y = -88$
$4.4y = -88$
$y = -20$

32. $4x - 6 = 6x$
$-6 = 2x$
$-3 = x$

34. $5y - 2 = 28 - y$
$6y = 30$
$y = 5$

36. $4 - 3x = 6 - 7x$
$4x = 2$
$x = \frac{1}{2}$

38. $14 - 6a = -2a + 3$
$11 = 4a$
$\frac{11}{4} = a$

40. $-7z + 2z - 3z - 7 = 17$
$-8z - 7 = 17$
$-8z = 24$
$z = -3$

42. $5 + 4x - 7 = 4x - 2 - x$
$4x - 2 = 3x - 2$
$x = 0$

44. $5y - 7 + y = 7y + 21 - 5y$
$6y - 7 = 2y + 21$
$4y = 28$
$y = 7$

Copyright © 2019 Pearson Education, Inc.

Introductory Algebra 13th edition Bittinger Solutions Manual

46. $\frac{7}{8}x - \frac{1}{4} + \frac{3}{4}x = \frac{1}{16} + x$, LCM is 16

$$\begin{aligned} 14x - 4 + 12x &= 1 + 16x \\ 26x - 4 &= 1 + 16x \\ 10x &= 5 \\ x &= \frac{1}{2} \end{aligned}$$

48. $-\frac{3}{2} + x = -\frac{5}{6} - \frac{4}{3}$, LCM is 6

$$\begin{aligned} -9 + 6x &= -5 - 8 \\ -9 + 6x &= -13 \\ 6x &= -4 \\ x &= -\frac{2}{3} \end{aligned}$$

50. $\frac{1}{2} + 4m = 3m - \frac{5}{2}$, LCM is 2

$$\begin{aligned} 1 + 8m &= 6m - 5 \\ 2m &= -6 \\ m &= -3 \end{aligned}$$

52. $1 - \frac{2}{3}y = \frac{9}{5} - \frac{y}{5} + \frac{3}{5}$, LCM is 15

$$\begin{aligned} 15 - 10y &= 27 - 3y + 9 \\ 15 - 10y &= 36 - 3y \\ -7y &= 21 \\ y &= -3 \end{aligned}$$

54.

$$\begin{aligned} 0.96y - 0.79 &= 0.21y + 0.46 \\ 96y - 79 &= 21y + 46 \\ 75y &= 125 \\ y &= \frac{125}{75} = \frac{5}{3} \end{aligned}$$

56.

$$\begin{aligned} 1.7t + 8 - 1.62t &= 0.4t - 0.32 + 8 \\ 170t + 800 - 162t &= 40t - 32 + 800 \\ 8t + 800 &= 40t + 768 \\ -32t &= -32 \\ t &= 1 \end{aligned}$$

58. $\frac{5}{16}y + \frac{3}{8}y = 2 + \frac{1}{4}y$, LCM is 16

$$\begin{aligned} 5y + 6y &= 32 + 4y \\ 11y &= 32 + 4y \\ 7y &= 32 \\ y &= \frac{32}{7} \end{aligned}$$

60.

$$\begin{aligned} 8(3x + 2) &= 30 \\ 24x + 16 &= 30 \\ 24x &= 14 \\ x &= \frac{7}{12} \end{aligned}$$

62.

$$\begin{aligned} 9 &= 3(5x - 2) \\ 9 &= 15x - 6 \\ 15 &= 15x \\ 1 &= x \end{aligned}$$

64.

$$\begin{aligned} 17 - t &= -t + 68 \\ 17 &= 68 \qquad \text{FALSE} \end{aligned}$$

The equation has no solution.

66.

$$\begin{aligned} y - \frac{2}{3} &= -\frac{2}{3} + y \\ -\frac{2}{3} &= -\frac{2}{3} \qquad \text{TRUE} \end{aligned}$$

All real numbers are solutions.

68.

$$\begin{aligned} 5x + 5(4x - 1) &= 20 \\ 5x + 20x - 5 &= 20 \\ 25x - 5 &= 20 \\ 25x &= 25 \\ x &= 1 \end{aligned}$$

70.

$$\begin{aligned} 6b - (3b + 8) &= 16 \\ 6b - 3b - 8 &= 16 \\ 3b - 8 &= 16 \\ 3b &= 24 \\ b &= 8 \end{aligned}$$

72.

$$\begin{aligned} 10 - 3(2x - 1) &= 1 \\ 10 - 6x + 3 &= 1 \\ 13 - 6x &= 1 \\ -6x &= -12 \\ x &= 2 \end{aligned}$$

74.

$$\begin{aligned} 3(t - 2) &= 9(t + 2) \\ 3t - 6 &= 9t + 18 \\ -24 &= 6t \\ -4 &= t \end{aligned}$$

76.

$$\begin{aligned} 7(5x - 2) &= 6(6x - 1) \\ 35x - 14 &= 36x - 6 \\ -8 &= x \end{aligned}$$

78.

$$\begin{aligned} 3 - 7x + 10x - 14 &= 9 - 6x + 9x - 20 \\ 3x - 11 &= 3x - 11 \\ -11 &= -11 \qquad \text{TRUE} \end{aligned}$$

All real numbers are solutions.

80.

$$\begin{aligned} 11x - 6 - 4x + 1 &= 9x - 8 - 2x + 12 \\ 7x - 5 &= 7x + 4 \\ -5 &= 4 \qquad \text{FALSE} \end{aligned}$$

The equation has no solution.

82.

$$\begin{aligned} 5(t + 3) + 9 &= 3(t - 2) + 6 \\ 5t + 15 + 9 &= 3t - 6 + 6 \\ 5t + 24 &= 3t \\ 24 &= -2t \\ -12 &= t \end{aligned}$$

84.

$$\begin{aligned} 13 - (2c + 2) &= 2(c + 2) + 3c \\ 13 - 2c - 2 &= 2c + 4 + 3c \\ 11 - 2c &= 5c + 4 \\ 7 &= 7c \\ 1 &= c \end{aligned}$$

86.

$$\begin{aligned} 5[3(7 - t) - 4(8 + 2t)] - 20 &= -6[2(6 + 3t) - 4] \\ 5[21 - 3t - 32 - 8t] - 20 &= -6[12 + 6t - 4] \\ 5[-11 - 11t] - 20 &= -6[8 + 6t] \\ -55 - 55t - 20 &= -48 - 36t \\ -75 - 55t &= -48 - 36t \\ -27 &= 19t \\ -\frac{27}{19} &= t \end{aligned}$$

Copyright © 2019 Pearson Education, Inc.

Introductory Algebra 13th edition Bittinger Solutions Manual

88. $6(2x-1)-12 = 7+12(x-1)$
$12x-6-12 = 7+12x-12$
$12x-18 = 12x-5$
$-18 = -5$ FALSE
The equation has no solution.

90. $2+14x-9 = 7(2x+1)-14$
$2+14x-9 = 14x+7-14$
$14x-7 = 14x-7$
$-7 = -7$ TRUE
All real numbers are solutions.

92. $0.9(2x+8) = 20-(x+5)$
$1.8x+7.2 = 20-x-5$
$18x+72 = 200-10x-50$
$18x+72 = 150-10x$
$28x = 78$
$x = \frac{78}{28}$
$x = \frac{39}{14}$

94. -75.14

96. $8y-88x+8 = 8(y-11x+1)$

98. $3x+2[4-5(2x-1)] = 3x+2[4-10x+5]$
$= 3x+2[9-10x]$
$= 3x+18-20x$
$= -17x+18$

100. $256 \div 64 \div 4^2 = 256 \div 64 \div 16$
$= 4 \div 16$
$= \frac{1}{4}$, or 0.25

102. $\frac{1}{4}(8y+4)-17 = -\frac{1}{2}(4y-8)$
$2y+1-17 = -2y+4$
$2y-16 = -2y+4$
$4y = 20$
$y = 5$

104. $5(3x+2) = 75$
$15x+10 = 75$
$15x = 65$
$x = \frac{65}{15} = \frac{13}{3}$, or $4\frac{1}{3}$

Exercise Set 2.4

RC2. When we replace the variables in an equation with numbers and calculate the result, we are *evaluating* the formula. When we *solve a formula for a letter*, we write the formula with the letter isolated on one side. The given statement is false.

CC2. The letter n is not isolated on one side, so the formula is not solved for n.

2. $B = 30 \cdot 1800 = 54,000$ Btu's

4. $N = 7^2 - 7 = 49 - 7 = 42$ games

6. a) $A = 6s^2 = 6 \cdot 3^2 = 6 \cdot 9 = 54$ in^2
b) $\frac{A}{6} = s^2$, or $\frac{1}{6}A = s^2$

8. a) $P = I \cdot V = 12 \cdot 115 = 1380$ watts
b) $I = \frac{P}{V}$; $V = \frac{P}{I}$

10. $\frac{d}{55} = t$

12. $\frac{y}{m} = x$

14. $z - 21 = t$

16. $y + \frac{2}{3} = x$

18. $t - 6 = s$

20. $y - A = x$

22. $y = 10 - x$
$y - 10 = -x$
$-y + 10 = x$, or
$10 - y = x$

24. $y = q - x$
$y - q = -x$
$-y + q = x$, or
$q - y = x$

26. $y = -\frac{x}{2}$, or $-\frac{1}{2}x$

28. $y = \frac{Ax}{B}$

30. $W = mt - b$
$W + b = mt$
$\frac{W+b}{m} = t$

32. $y = bx - c$
$y + c = bx$
$\frac{y+c}{b} = x$

34. $d = rt$
$\frac{d}{t} = r$

36. $A = \pi r^2$
$\frac{A}{\pi} = r^2$

38. $A = \frac{1}{2}bh$
$2A = bh$
$\frac{2A}{h} = b$

Copyright © 2019 Pearson Education, Inc.

Introductory Algebra 13th edition Bittinger Solutions Manual

40.
$$\begin{aligned} A &= \frac{a+b+c}{3} \\ 3A &= a+b+c \\ 3A-a-b &= c \end{aligned}$$

42.
$$\begin{aligned} S &= rx+s \\ S-s &= rx \\ \frac{S-s}{r} &= x \end{aligned}$$

44.
$$\begin{aligned} Q &= \frac{p-q}{2} \\ 2Q &= p-q \\ 2Q+q &= p \end{aligned}$$

46.
$$\begin{aligned} I &= Prt \\ \frac{I}{rt} &= P \end{aligned}$$

48.
$$\begin{aligned} Ax+By &= c \\ By &= c-Ax \\ y &= \frac{c-Ax}{B} \end{aligned}$$

50.
$$\begin{aligned} P &= \frac{ab}{c} \\ Pc &= ab \\ c &= \frac{ab}{P} \end{aligned}$$

52. $4a-8b-5(5a-4b) = 4a-8b-25a+20b = -21a+12b$

54. $-\frac{2}{3}-\frac{5}{6} = -\frac{2}{3}+\left(-\frac{5}{6}\right) = -\frac{4}{6}+\left(-\frac{5}{6}\right) = -\frac{9}{6} = -\frac{3}{2}$

56. $-\frac{5}{12}+\frac{1}{4} = -\frac{5}{12}+\frac{3}{12} = -\frac{2}{12} = -\frac{1}{6}$

58. $-2\frac{1}{2}+6\frac{1}{4} = -\frac{5}{2}+\frac{25}{4} = -\frac{10}{4}+\frac{25}{4} = \frac{15}{4} = 3\frac{3}{4}$

60.
$$\begin{aligned} 10x+4 &= 3x-2+x \\ 10x+4 &= 4x-2 \\ 6x &= -6 \\ x &= -1 \end{aligned}$$

62.
$$\begin{aligned} 5a &= 3(6-3a) \\ 5a &= 18-9a \\ 14a &= 18 \\ a &= \frac{9}{7} \end{aligned}$$

64.
$$\begin{aligned} P &= 4m+7mn \\ P &= m(4+7n) \\ \frac{P}{4+7n} &= m \end{aligned}$$

66. Not necessarily; $6 = 2\cdot 2+2\cdot 1$, but $2\cdot 6$, or 12, can be expressed as $2\cdot 5+2\cdot 1$.

68.
$$\begin{aligned} D &= \frac{1}{E+F} \\ D(E+F) &= 1 \\ E+F &= \frac{1}{D} \\ F &= \frac{1}{D}-E, \text{ or } \frac{1-DE}{D} \end{aligned}$$

Chapter 2 Mid-Chapter Review

1. The solution of $3-x=4x$ is $\frac{3}{5}$; the solution of $5x=-3$ is $-\frac{3}{5}$. The equations have different solutions, so they are not equivalent. The given statement is false.

2. True; see page 112 in the text.

3. True; see page 116 in the text.

4. False; see page 128 in the text.

5.
$$\begin{aligned} x+5 &= -3 \\ x+5-5 &= -3-5 \\ x+0 &= -8 \\ x &= -8 \end{aligned}$$

6.
$$\begin{aligned} -6x &= 42 \\ \frac{-6x}{-6} &= \frac{42}{-6} \\ 1\cdot x &= -7 \\ x &= -7 \end{aligned}$$

7.
$$\begin{aligned} 5y+z &= t \\ 5y+z-z &= t-z \\ 5y &= t-z \\ \frac{5y}{5} &= \frac{t-z}{5} \\ y &= \frac{t-z}{5} \end{aligned}$$

8.
$$\begin{aligned} x+5 &= 11 \\ x+5-5 &= 11-5 \\ x &= 6 \end{aligned}$$
The solution is 6.

9.
$$\begin{aligned} x+9 &= -3 \\ x+9-9 &= -3-9 \\ x &= -12 \end{aligned}$$
The solution is -12.

10.
$$\begin{aligned} 8 &= t+1 \\ 8-1 &= t+1-1 \\ 7 &= t \end{aligned}$$
The solution is 7.

11.
$$\begin{aligned} -7 &= y+3 \\ -7-3 &= y+3-3 \\ -10 &= y \end{aligned}$$
The solution is -10.

12.
$$\begin{aligned} x-6 &= 14 \\ x-6+6 &= 14+6 \\ x &= 20 \end{aligned}$$
The solution is 20.

Copyright © 2019 Pearson Education, Inc.

Introductory Algebra 13th edition Bittinger Solutions Manual

13.
$$\begin{aligned} y-7&=-2\\ y-7+7&=-2+7\\ y&=5 \end{aligned}$$
The solution is 5.

14.
$$\begin{aligned} -\frac{3}{2}+z&=-\frac{3}{4}\\ -\frac{3}{2}+z+\frac{3}{2}&=-\frac{3}{4}+\frac{3}{2}\\ z&=-\frac{3}{4}+\frac{6}{4}\\ z&=\frac{3}{4} \end{aligned}$$
The solution is $\frac{3}{4}$.

15.
$$\begin{aligned} -3.3&=-1.9+t\\ -3.3+1.9&=-1.9+t+1.9\\ -1.4&=t \end{aligned}$$
The solution is -1.4.

16.
$$\begin{aligned} 7x&=42\\ \frac{7x}{7}&=\frac{42}{7}\\ x&=6 \end{aligned}$$
The solution is 6.

17.
$$\begin{aligned} 17&=-t\\ 17&=-1\cdot t\\ \frac{17}{-1}&=\frac{-1\cdot t}{-1}\\ -17&=t \end{aligned}$$
The solution is -17.

18.
$$\begin{aligned} 6x&=-54\\ \frac{6x}{6}&=\frac{-54}{6}\\ x&=-9 \end{aligned}$$
The solution is -9.

19.
$$\begin{aligned} -5y&=-85\\ \frac{-5y}{-5}&=\frac{-85}{-5}\\ y&=17 \end{aligned}$$
The solution is 17.

20.
$$\begin{aligned} \frac{x}{7}&=3\\ \frac{1}{7}\cdot x&=3\\ 7\cdot\frac{1}{7}x&=7\cdot 3\\ x&=21 \end{aligned}$$
The solution is 21.

21.
$$\begin{aligned} \frac{2}{3}x&=12\\ \frac{3}{2}\cdot\frac{2}{3}x&=\frac{3}{2}\cdot 12\\ x&=\frac{3\cdot\cancel{2}\cdot 6}{\cancel{2}\cdot 1}\\ x&=18 \end{aligned}$$
The solution is 18.

22.
$$\begin{aligned} -\frac{t}{5}&=3\\ -\frac{1}{5}\cdot t&=3\\ -5\left(-\frac{1}{5}\cdot t\right)&=-5\cdot 3\\ t&=-15 \end{aligned}$$
The solution is -15.

23.
$$\begin{aligned} \frac{3}{4}x&=-\frac{9}{8}\\ \frac{4}{3}\cdot\frac{3}{4}x&=\frac{4}{3}\left(-\frac{9}{8}\right)\\ x&=-\frac{\cancel{4}\cdot\cancel{3}\cdot 3}{\cancel{3}\cdot 2\cdot\cancel{4}}\\ x&=-\frac{3}{2} \end{aligned}$$
The solution is $-\frac{3}{2}$.

24.
$$\begin{aligned} 3x+2&=5\\ 3x+2-2&=5-2\\ 3x&=3\\ \frac{3x}{3}&=\frac{3}{3}\\ x&=1 \end{aligned}$$
The solution is 1.

25.
$$\begin{aligned} 5x+4&=-11\\ 5x+4-4&=-11-4\\ 5x&=-15\\ \frac{5x}{5}&=\frac{-15}{5}\\ x&=-3 \end{aligned}$$
The solution is -3.

26.
$$\begin{aligned} 6x-7&=2\\ 6x-7+7&=2+7\\ 6x&=9\\ \frac{6x}{6}&=\frac{9}{6}\\ x&=\frac{9}{6}=\frac{3\cdot\cancel{3}}{2\cdot\cancel{3}}\\ x&=\frac{3}{2} \end{aligned}$$
The solution is $\frac{3}{2}$.

Copyright © 2019 Pearson Education, Inc.

Introductory Algebra 13th edition Bittinger Solutions Manual

27.
$$\begin{aligned} -4x-9 &= -5 \\ -4x-9+9 &= -5+9 \\ -4x &= 4 \\ \frac{-4x}{-4} &= \frac{4}{-4} \\ x &= -1 \end{aligned}$$
The solution is -1.

28.
$$\begin{aligned} 6x+5x &= 33 \\ 11x &= 33 \\ \frac{11x}{11} &= \frac{33}{11} \\ x &= 3 \end{aligned}$$
The solution is 3.

29.
$$\begin{aligned} -3y-4y &= 49 \\ -7y &= 49 \\ \frac{-7y}{-7} &= \frac{49}{-7} \\ y &= -7 \end{aligned}$$
The solution is -7.

30.
$$\begin{aligned} 3x-4 &= 12-x \\ 3x-4+x &= 12-x+x \\ 4x-4 &= 12 \\ 4x-4+4 &= 12+4 \\ 4x &= 16 \\ \frac{4x}{4} &= \frac{16}{4} \\ x &= 4 \end{aligned}$$
The solution is 4.

31.
$$\begin{aligned} 5-6x &= 9-8x \\ 5-6x+8x &= 9-8x+8x \\ 5+2x &= 9 \\ 5+2x-5 &= 9-5 \\ 2x &= 4 \\ \frac{2x}{2} &= \frac{4}{2} \\ x &= 2 \end{aligned}$$
The solution is 2.

32.
$$\begin{aligned} 4y-\frac{3}{2} &= \frac{3}{4}+2y \\ 4\left(4y-\frac{3}{2}\right) &= 4\left(\frac{3}{4}+2y\right) \quad \text{Clearing fractions} \\ 4\cdot 4y-4\cdot\frac{3}{2} &= 4\cdot\frac{3}{4}+4\cdot 2y \\ 16y-6 &= 3+8y \\ 16y-6-8y &= 3+8y-8y \\ 8y-6 &= 3 \\ 8y-6+6 &= 3+6 \\ 8y &= 9 \\ \frac{8y}{8} &= \frac{9}{8} \end{aligned}$$
The solution is $\frac{9}{8}$.

33.
$$\begin{aligned} \frac{4}{5}+\frac{1}{6}t &= \frac{1}{10} \\ 30\left(\frac{4}{5}+\frac{1}{6}t\right) &= 30\cdot\frac{1}{10} \quad \text{Clearing fractions} \\ 30\cdot\frac{4}{5}+30\cdot\frac{1}{6}t &= \frac{30}{10} \\ 24+5t &= 3 \\ 24+5t-24 &= 3-24 \\ 5t &= -21 \\ \frac{5t}{5} &= \frac{-21}{5} \\ t &= -\frac{21}{5} \end{aligned}$$
The solution is $-\frac{21}{5}$.

34.
$$\begin{aligned} 0.21n-1.05 &= 2.1-0.14n \\ 100(0.21n-1.05) &= 100(2.1-0.14n) \\ & \qquad \text{Clearing decimals} \\ 100(0.21n)-100(1.05) &= 100(2.1)-100(0.14n) \\ 21n-105 &= 210-14n \\ 21n-105+14n &= 210-14n+14n \\ 35n-105 &= 210 \\ 35n-105+105 &= 210+105 \\ 35n &= 315 \\ \frac{35n}{35} &= \frac{315}{35} \\ n &= 9 \end{aligned}$$
The solution is 9.

35.
$$\begin{aligned} 5(3y-1) &= -35 \\ 15y-5 &= -35 \\ 15y-5+5 &= -35+5 \\ 15y &= -30 \\ \frac{15y}{15} &= \frac{-30}{15} \\ y &= -2 \end{aligned}$$
The solution is -2.

Copyright © 2019 Pearson Education, Inc.

Introductory Algebra 13th edition Bittinger Solutions Manual

36.
$$\begin{aligned} 7-2(5x+3) &= 1 \\ 7-10x-6 &= 1 \\ 1-10x &= 1 \\ 1-10x-1 &= 1-1 \\ -10x &= 0 \\ \frac{-10x}{-10} &= \frac{0}{-10} \\ x &= 0 \end{aligned}$$
The solution is 0.

37.
$$\begin{aligned} -8+t &= t-8 \\ -8+t-t &= t-8-t \\ -8 &= -8 \end{aligned}$$
We have an equation that is true for all real numbers. Thus, all real numbers are solutions.

38.
$$\begin{aligned} z+12 &= -12+z \\ z+12-z &= -12+z-z \\ 12 &= -12 \end{aligned}$$
We have a false equation. There are no solutions.

39.
$$\begin{aligned} 4(3x+2) &= 5(2x-1) \\ 12x+8 &= 10x-5 \\ 12x+8-10x &= 10x-5-10x \\ 2x+8 &= -5 \\ 2x+8-8 &= -5-8 \\ 2x &= -13 \\ \frac{2x}{2} &= \frac{-13}{2} \\ x &= -\frac{13}{2} \end{aligned}$$
The solution is $-\frac{13}{2}$.

40.
$$\begin{aligned} 8x-6-2x &= 3(2x-4)+6 \\ 6x-6 &= 6x-12+6 \\ 6x-6 &= 6x-6 \\ 6x-6-6x &= 6x-6-6x \\ -6 &= -6 \end{aligned}$$
We have an equation that is true for all real numbers. Thus, all real numbers are solutions.

41.
$$\begin{aligned} A &= 4b \\ \frac{A}{4} &= \frac{4b}{4} \\ \frac{A}{4} &= b \end{aligned}$$

42.
$$\begin{aligned} y &= x-1.5 \\ y+1.5 &= x-1.5+1.5 \\ y+1.5 &= x \end{aligned}$$

43.
$$\begin{aligned} n &= s-m \\ n-s &= s-m-s \\ n-s &= -m \\ -1(n-s) &= -1(-m) \\ -n+s &= m, \text{ or} \\ s-n &= m \end{aligned}$$

44.
$$\begin{aligned} 4t &= 9w \\ \frac{4t}{4} &= \frac{9w}{4} \\ t &= \frac{9w}{4} \end{aligned}$$

45.
$$\begin{aligned} B &= at-c \\ B+c &= at-c+c \\ B+c &= at \\ \frac{B+c}{a} &= \frac{at}{a} \\ \frac{B+c}{a} &= t \end{aligned}$$

46.
$$\begin{aligned} M &= \frac{x+y+z}{2} \\ 2\cdot M &= 2\left(\frac{x+y+z}{2}\right) \\ 2M &= x+y+z \\ 2M-x-z &= x+y+z-x-z \\ 2M-x-z &= y \end{aligned}$$

47. Equivalent expressions have the same value for all possible replacements for the variable(s). Equivalent equations have the same solution(s).

48. The equations are not equivalent because they do not have the same solutions. Although 5 is a solution of both equations, -5 is a solution of $x^2 = 25$ but not of $x = 5$.

49. For an equation $x + a = b$, add the opposite of a (or subtract a) on both sides of the equation.

50. It appears that the student added $\frac{1}{3}$ on the right side of the equation rather than subtracting $\frac{1}{3}$.

51. For an equation $ax = b$, multiply by $1/a$ (or divide by a) on both sides of the equation.

52. Answers may vary. A walker who knows how far and how long she walks each day wants to know her average speed each day.

Exercise Set 2.5

RC2. The word "of" often translates to multiplication.

RC4. When finding the percent number, we must remember to convert to percent notation.

CC2. The correct answer is (b).

Copyright © 2019 Pearson Education, Inc.

Introductory Algebra 13th edition Bittinger Solutions Manual

CC4. The correct answer is (a).

CC6. The correct answer is (c).

2. Solve: $p \cdot 76 = 19$
$p = 0.25 = 25\%$

4. Solve: $20.4 = 24\% \cdot a$
$85 = a$

6. Solve: $a = 50\% \cdot 50$
$a = 25$

8. Solve: $57 = p \cdot 300$
$0.19 = p$
$19\% = p$

10. Solve: $7 = 175\% \cdot b$
$4 = b$

12. Solve: $16 = p \cdot 40$
$p = 0.4 = 40\%$

14. Solve: $p \cdot 150 = 39$
$p = 0.26 = 26\%$

16. Solve: $a = 1\% \cdot 1,000,000$
$a = 10,000$

18. Solve: $p \cdot 60 = 75$
$p = 1.25 = 125\%$

20. Any number is 100% of itself, so 70 is 100% of 70. We could also do this exercise as follows:
Solve: $p \cdot 70 = 70$
$p = 1 = 100\%$

22. Solve: $54 = 24\% \cdot b$
$225 = b$

24. Solve: $a = 40\% \cdot 2$
$a = 0.8$

26. Solve: $40 = 2\% \cdot b$
$2000 = b$

28. Solve: $8 = 2\% \cdot b$
$400 = b$

30. Solve: $a = 7.0\% \cdot 8909$
$a \approx 624$ million

32. Solve: $a = 4.4\% \cdot 8909$
$a \approx 392$ million

34. Solve: $a = 0.5\% \cdot 8909$
$a \approx 45$ million

36. Solve: $a = 68.7\% \cdot \$15,870$
$a \approx \$10,903$ million

38. Solve: $a = 6.31\% \cdot \$5000$
$a = \$315.50$

40. Solve: $43 = p \cdot 116$
$0.37 \approx p$
$37\% \approx p$

42. a) Solve: $a = 20\% \cdot \$75$
$a = \$15$

b) $\$75 + \$15 = \$90$

44. a) Solve: $\$6.75 = 18\% \cdot b$
$\$37.50 = b$

b) $\$37.50 + \$6.75 = \$44.25$

46. Solve: $46.2 = 44\% \cdot b$
$b = 105$ billion pieces of junk mail

48. Increase: $2311 - 1651 = 660$

To find the percent increase, solve:

$660 = p \cdot 1651$
$0.400 \approx p$
$40.0\% \approx p$

50. Decrease: $55,000 - 32,900 = 22,100$

To find the percent decrease, solve:

$22,100 = p \cdot 55,000$
$0.402 \approx p$
$40.2\% \approx p$

52. Increase: $315 - 265 = 50$

To find the percent increase, solve:

$50 = p \cdot 265$
$0.189 \approx p$
$18.9\% \approx p$

54. Decrease, in millions: $7.37 - 5.75 = 1.62$

To find the percent decrease, solve:

$1.62 = p \cdot 7.37$
$0.220 \approx p$
$22.0\% \approx p$

56. $5x - 21$

58. $-\dfrac{18b}{12b} = -\dfrac{3 \cdot \cancel{6} \cdot \cancel{b}}{2 \cdot \cancel{6} \cdot \cancel{b}} = -\dfrac{3}{2}$

60.
$$\begin{aligned}&[3(x+4)-6]-[8+2(x-5)]\\ &= [3x+12-6]-[8+2x-10]\\ &= 3x+6-[2x-2]\\ &= 3x+6-2x+2\\ &= x+8\end{aligned}$$

62. Note: 4 ft 8 in. = 56 in.
Solve: $56 = 84.4\% \cdot b$
$66 \approx b$

Dana's final adult height will be about 66 in., or 5 ft 6 in.

Exercise Set 2.6

RC2. Translate the problem to an equation.

RC4. Check the answer in the original problem.

Copyright © 2019 Pearson Education, Inc.

Introductory Algebra 13th edition Bittinger Solutions Manual

CC2. Including a 6% sales tax, Jaykob paid \$36.57 for a sweatshirt. If x = the marked price, then $\underline{0.06x}$, or $\underline{6\%x}$ = the sales tax. The translation is $x + \underline{0.06x} = \underline{36.57}$.

2. Solve: $3a + 102,000 = 469,300$
$a = \$122,400$

4. Solve: $x + (x + 2) = 72$
$x = 35$

If $x = 35$, then $x + 2 = 37$.

The lengths of the pieces are 35 in. and 37 in.

6. Solve: $c - 89 = 60$
$c = 149$ calories

8. Solve: $m + 59 = 385$
$m = 326$ ft

10. Solve: $x + (x + 1) = 547$
$x = 273$

If $x = 273$, then $x + 1 = 274$.

The numbers are 273 and 274.

12. Solve: $a + (a + 1) + (a + 2) = 108$
$a = 35$

Whitney, Wesley, and Wanda's ages are 35, 36, and 37, respectively.

14. Solve: $x + \frac{1}{2}(x + 1) + 2(x + 2) - 7 = 2101$
$x = 601$

If $x = 601$, then $x + 1 = 602$ and $x + 2 = 603$.

The integers are 601, 602, and 603.

16. Solve: $2(w + 2) + 2w = 10$
$w = \frac{3}{2}$, or $1\frac{1}{2}$

If $w = 1\frac{1}{2}$, then $w + 2 = 1\frac{1}{2} + 2 = 3\frac{1}{2}$.

The length is $3\frac{1}{2}$ in. and the width is $1\frac{1}{2}$ in.

18. Solve: $p - 15\%p = 33.15$
$p = \$39$

20. Solve: $p + 6.5\%p = 117.15$
$p = \$110$

22. Solve: $84.45 + 0.55m = 250$
$m = 301$ mi

24. Solve: $x + 4x + (x + 4x) - 45 = 180$
$x = 22.5$

If $x = 22.5$, then $4x = 90$ and $(x + 4x) - 45 = 67.5$.

The measures of the angles are 22.5°, 90°, and 67.5°.

26. Solve: $x + 3x + (x - 15) = 180$
$x = 39$

If $x = 39$, then $3x = 117$ and $x - 15 = 24$.

The measures of the angles are 39°, 117°, and 24°.

28. Solve: $a + 0.06a = 6996$
$a = \$6600$

30. Solve: $b + 0.1b = 7194$
$b = \$6540$

32. Solve: $1.80 + 2.20m = 26$
$m = 11$ mi

34. Solve: $c + 20\%c = \$24.90$
$c = \$20.75$

36. Solve: $\frac{t + 2t + 27}{3} = 34$
$t = 25$

If $t = \$25$, then $2t = \$50$. The prices of the other two shirts were \$25 and \$50.

38. Solve: $2x + 85 = \frac{3}{4}x$
$x = -68$

40. $-\frac{4}{5} + \frac{3}{8} = -\frac{32}{40} + \frac{15}{40} = -\frac{17}{40}$

42. $-\frac{4}{5} \div \frac{3}{8} = -\frac{4}{5} \cdot \frac{8}{3} = -\frac{32}{15}$

44. $-25.6 \div (-16) = 1.6$

46. $-25.6 - (-16) = -25.6 + 16 = -9.6$

48. $(-0.02) \div (-0.2) = 0.1$

50. $c + (4 + d)$

52. Solve: $3 \cdot 7 + 3m = 78$
$m = 19$

The student answered 19 multiple-choice questions correctly.

54. Let d = the number of dimes. Then $2d$ = the number of quarters, and $d + 10$ = the number of nickels.

The value of d dimes is $0.10d$.

The value of $2d$ quarters is $0.25(2d)$.

The value of $d + 10$ nickels is $0.05(d + 10)$.

Solve: $0.10d + 0.25(2d) + 0.05(d + 10) = 20$
$d = 30$

If $d = 30$, then $2d = 60$ and $d + 10 = 40$.

Susanne got 60 quarters, 30 dimes, and 40 nickels.

Exercise Set 2.7

RC2. $3x - 5 \le -x + 1$
$4x \le 6$

We see that $3x - 5 \le -x + 1$ and $2x \le 6$ are not equivalent.

RC4. $2 - t > -3t + 4$
$2t > 2$

We see that $2 - t > -3t + 4$ and $2t > 2$ are equivalent.

Copyright © 2019 Pearson Education, Inc.

Introductory Algebra 13th edition Bittinger Solutions Manual

CC2. $4x < 20$
$x < 5$

CC4. $-\frac{1}{2}n > -5$
$n < 10$

2. a) Yes, b) yes, c) yes, d) yes, e) no

4. a) No, b) yes, c) yes, d) no, e) yes

6.
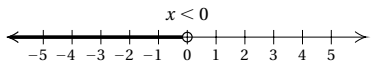

8.
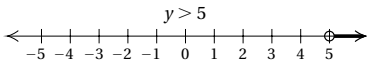

10.
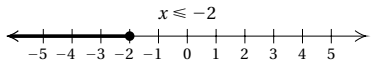

12.
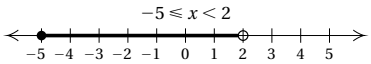

14.
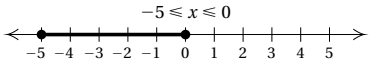

16. $x + 5 > 2$
$x > -3$
$\{x|x > -3\}$

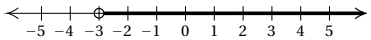

18. $x + 8 \le -11$
$x \le -19$
$\{x|x \le -19\}$

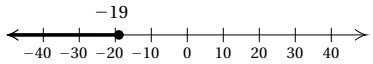

20. $y - 9 > -15$
$y > -6$
$\{y|y > -6\}$

22. $2x + 4 > x + 7$
$x > 3$
$\{x|x > 3\}$

24. $3x + 18 \le 2x + 16$
$x \le -2$
$\{x|x \le -2\}$

26. $9x - 8 < 8x - 9$
$x < -1$
$\{x|x < -1\}$

28. $-8 + p > 10$
$p > 18$
$\{p|p > 18\}$

30. $x - \frac{1}{3} < \frac{5}{6}$
$x \le \frac{7}{6}$
$\left\{x \middle| x \le \frac{7}{6}\right\}$

32. $x + \frac{1}{8} > \frac{1}{2}$
$x > \frac{3}{8}$
$\left\{x \middle| x > \frac{3}{8}\right\}$

34. $8x \ge 32$
$x \ge 4$
$\{x|x \ge 4\}$

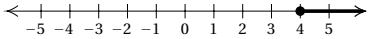

36. $-16x > -64$
$x < 4$
$\{x|x < 4\}$

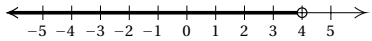

38. $3x < -4$
$x < -\frac{4}{3}$
$\left\{x \middle| x < -\frac{4}{3}\right\}$

40. $-3x \le 15$
$x \ge -5$
$\{x|x \ge -5\}$

42. $-7x < -21$
$x > 3$
$\{x|x > 3\}$

44. $-5y > -23$
$y < \frac{23}{5}$
$\left\{y \middle| y < \frac{23}{5}\right\}$

46. $-4x \le \frac{1}{9}$
$x \ge -\frac{1}{36}$
$\left\{x|x \ge -\frac{1}{36}\right\}$

48. $-\frac{7}{9} > 63x$
$\frac{1}{63}\left(-\frac{7}{9}\right) > x$
$-\frac{1}{81} > x$
$\left\{x \middle| x < -\frac{1}{81}\right\}$

Copyright © 2019 Pearson Education, Inc.

Introductory Algebra 13th edition Bittinger Solutions Manual

50. $3+4y<35$
$4y<32$
$y<8$
$\{y|y<8\}$

52. $5y-9\le 21$
$5y\le 30$
$y\le 6$
$\{y|y\le 6\}$

54. $8y-6<-54$
$8y<-48$
$y<-6$
$\{y|y<-6\}$

56. $48>13-7y$
$35>-7y$
$-5<y$
$\{y|y>-5\}$

58. $15x+5-14x\le 9$
$x+5\le 9$
$x\le 4$
$\{x|x\le 4\}$

60. $-8<9x+8-8x-3$
$-8<x+5$
$-13<x$
$\{x|x>-13\}$

62. $9-8y>5-7y+2$
$9-8y>7-7y$
$2>y$
$\{y|y<2\}$

64. $6-18x\le 4-12x-5x$
$6-18x\le 4-17x$
$2\le x$
$\{x|x\ge 2\}$

66. $18-6y-4y<63+5y$
$18-10y<63+5y$
$-45<15y$
$-3<y$
$\{y|y>-3\}$

68. $0.96y-0.79\le 0.21y+0.46$
$96y-79\le 21y+46$
$75y\le 125$
$y\le \frac{5}{3}$
$\left\{y\middle|y\le\frac{5}{3}\right\}$

70. $\frac{2}{3}+\frac{x}{5}<\frac{4}{15}$
$15\left(\frac{2}{3}+\frac{x}{5}\right)<15\cdot\frac{4}{15}$
$10+3x<4$
$3x<-6$
$x<-2$
$\{x|x<-2\}$

72. $\frac{3x}{4}-\frac{7}{8}\ge -15$
$8\left(\frac{3x}{4}-\frac{7}{8}\right)\ge 8(-15)$
$6x-7\ge -120$
$6x\ge -113$
$x\ge -\frac{113}{6}$
$\left\{x\middle|x\ge -\frac{113}{6}\right\}$

74. $4(2y-3)>28$
$8y-12>28$
$8y>40$
$y>5$
$\{y|y>5\}$

76. $3(5+3m)-8\le 88$
$15+9m-8\le 88$
$9m+7\le 88$
$9m\le 81$
$m\le 9$
$\{m|m\le 9\}$

78. $7(5y-2)>6(6y-1)$
$35y-14>36y-6$
$-8>y$
$\{y|y<-8\}$

80. $5(x+3)+9\le 3(x-2)+6$
$5x+15+9\le 3x-6+6$
$5x+24\le 3x$
$2x\le -24$
$x\le -12$
$\{x|x\le -12\}$

82. $0.4(2x+8)\ge 20-(x+5)$
$0.8x+3.2\ge 20-x-5$
$0.8x+3.2\ge 15-x$
$8x+32\ge 150-10x$
$18x\ge 118$
$x\ge \frac{118}{18}$, or
$x\ge \frac{59}{9}$
$\left\{x\middle|x\ge\frac{59}{9}\right\}$

84. $1-\frac{2}{3}y\ge \frac{9}{5}-\frac{y}{5}+\frac{3}{5}$
$15\left(1-\frac{2}{3}y\right)\ge 15\left(\frac{9}{5}-\frac{y}{5}+\frac{3}{5}\right)$
$15-10y\ge 27-3y+9$
$15-10y\ge 36-3y$
$-21\ge 7y$
$-3\ge y$
$\{y|y\le -3\}$

86. $8.12-9.23=8.12+(-9.23)=-1.11$

88. $-\frac{3}{4}-\frac{1}{8}=-\frac{3}{4}+\left(-\frac{1}{8}\right)=-\frac{6}{8}+\left(-\frac{1}{8}\right)=-\frac{7}{8}$

Copyright © 2019 Pearson Education, Inc.

Introductory Algebra 13th edition Bittinger Solutions Manual

90. $10 \div 2 \cdot 5 - 3^2 + (-5)^2 = 10 \div 2 \cdot 5 - 9 + 25$
$= 5 \cdot 5 - 9 + 25$
$= 25 - 9 + 25$
$= 16 + 25$
$= 41$

92. $9(3+5x) - 4(7+2x) = 27 + 45x - 28 - 8x = -1 + 37x$, or $37x - 1$

94. The solutions of $|x| < 3$ are all points whose distance from 0 is less than 3. This is equivalent to

$-3 < x < 3$. The graph is as follows:

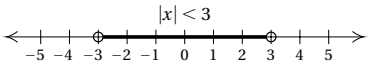

96. $x + 4 > 3 + x$
$4 > 3$

All real numbers are solutions.

Exercise Set 2.8

RC2. $q \le r$

RC4. $r \ge q$, so we choose $q \le r$.

RC6. $q \ge r$, so we choose $r \le q$.

CC2. \$7 does not exceed \$7, so \$7 satisfies the requirement in the statement.

CC4. \$7 is less than \$8, so \$7 does not satisfy the requirement in the statement.

2. $n \ge 5$

4. $75 < p < 100$

6. $a \le 180$

8. $A > 40$ L

10. $T \le -2°$

12. $x < 5$

14. $n \ge 18$

16. $c \le \$4857.95$

18. $c \ge \$3.19$

20. $\frac{1}{2}n - 5 > 17$

22. Solve: $\frac{73 + 75 + 89 + 91 + s}{5} \ge 85$

The solution set is $\{s | s \ge 97\}$.

24. Solve: $\frac{9}{5}C + 32 > 98.6$

The solution set is $\{C | C > 37°\}$.

26. Solve: $-0.028t + 20.8 < 19.0$
$t > 64\frac{2}{7}$

We have $1920 + 64\frac{2}{7} = 1984\frac{2}{7}$, so the solution set is $\{Y | Y \ge 1985\}$, where Y represents the year.

28. Solve: $80 + 16n \le 750$
$n \le 41.875$

At most, 41 people can attend the banquet.

30. Solve: $53 + L \le 165$

The solution set is $\{L | L \le 112 \text{ in.}\}$.

32. Solve: $0.45 + 0.25h \ge 2.20$
$h \ge 7$

Laura parks for at least 7 half hours, or for at least 3.5 hr.

34. Solve: $45 + 30t > 150$
$t > 3.5$ hr

36. Solve: $\frac{5 + 7 + 8 + c}{4} \ge 7$
$c \ge 8$ credits

38. Solve: $b + (b - 2) + (b + 3) > 19$
$b > 6$ cm

40. Solve: $16l \ge 264$.
$l \ge 16.5$ yd

42. Solve: $c > 0.8(21,000)$
$c > \$16,800$

44. Solve: $5 \le 0.75r$ (See Exercise 43.)
$r \ge 6\frac{2}{3}$ g

46. Solve: $\frac{1}{2} \cdot 8 \cdot h \le 12$
$h \le 3$ ft

48. Solve: $3 + \frac{3}{4}w > 22\frac{1}{2}$
$w > 26$

The puppy's weight will exceed $22\frac{1}{2}$ lb 26 weeks after its weight is 3 lb.

50. Solve: $h + (h + 3) > 27$
$h > 12$

George worked more than 12 hr, and Joan worked more than 15 hr.

52. -22

54. $8x + 3x = 66$
$11x = 66$
$x = 6$

Copyright © 2019 Pearson Education, Inc.

Introductory Algebra 13th edition Bittinger Solutions Manual

56. $9x - 1 + 11x - 18 = 3x - 15 + 4 + 17x$
$20x - 19 = 20x - 11$
$-19 = -11$

The equation has no solution.

58. Solve: $a = 10\% \cdot 310$
$a = 31$

60. Solve: $80 = p \cdot 96$
$0.83\overline{3} = p$
$83.\overline{3}\% = p$, or
$83\frac{1}{3}\% = p$

62. Solve: $4 + 2.5(h - 1) > 16.5$
$h > 6$ hr

64. Solve: $14 < 4 + 2.50(h - 1) < 24$
$5 \text{ hr} < h < 9 \text{ hr}$

Chapter 2 Vocabulary Reinforcement

1. Any replacement for the variable that makes an equation true is called a solution of the equation.
2. The addition principle for equations states that for any real numbers a, b, and c, $a = b$ is equivalent to $a+c = b+c$.
3. The multiplication principle states that for any real numbers a, b, and c, $a = b$ is equivalent to $a \cdot c = b \cdot c$.
4. An inequality is a number sentence with $<$, $\leq$, $>$, or $\geq$ as its verb.
5. Equations with the same solution are called equivalent equations.

Chapter 2 Concept Reinforcement

1. True; see page 128 in the text.
2. True; for any number n, $n \geq n$ is true because $n = n$ is true.
3. False; the solution set of $2x - 7 \leq 11$ is $\{x|x \leq 9\}$; the solution set of $x < 2$ is $\{x|x < 2\}$. The inequalities do not have the same solution set, so they are not equivalent.
4. True; if $x > y$, then $-1 \cdot x < -1 \cdot y$ (reversing the inequality symbol), or $-x < -y$.

Chapter 2 Study Guide

1.
$$\begin{aligned} 4(x-3) &= 6(x+2) \\ 4x - 12 &= 6x + 12 \\ 4x - 12 - 6x &= 6x + 12 - 6x \\ -2x - 12 &= 12 \\ -2x - 12 + 12 &= 12 + 12 \\ -2x &= 24 \\ \frac{-2x}{-2} &= \frac{24}{-2} \\ x &= -12 \end{aligned}$$

The solution is -12.

2.
$$\begin{aligned} 4 + 3y - 7 &= 3 + 3(y-2) \\ 4 + 3y - 7 &= 3 + 3y - 6 \\ 3y - 3 &= -3 + 3y \\ 3y - 3 - 3y &= -3 + 3y - 3y \\ -3 &= -3 \end{aligned}$$

Every real number is a solution of the equation $-3 = -3$, so all real numbers are solutions of the original equation.

3.
$$\begin{aligned} 4(x-3) + 7 &= -5 + 4x + 10 \\ 4x - 12 + 7 &= -5 + 4x + 10 \\ 4x - 5 &= 5 + 4x \\ 4x - 5 - 4x &= 5 + 4x - 4x \\ -5 &= 5 \end{aligned}$$

We get a false equation, so the original equation has no solution.

4.
$$\begin{aligned} A &= \frac{1}{2}bh \\ 2 \cdot A &= 2 \cdot \frac{1}{2}bh \\ 2A &= bh \\ \frac{2A}{h} &= \frac{bh}{h} \\ \frac{2A}{h} &= b \end{aligned}$$

5. Graph: $x > 1$

The solutions of $x > 1$ are all numbers greater than 1. We shade all points to the right of 1 and use an open circle at 1 to indicate that 1 is not part of the graph.

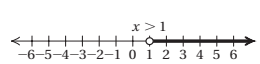

6. Graph: $x \leq -1$

The solutions of $x \leq -1$ are all numbers less than or equal to -1. We shade all points to the left of -1 and use a closed circle at -1 to indicate that -1 is part of the graph.

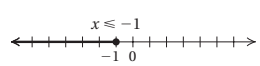

Copyright © 2019 Pearson Education, Inc.

Introductory Algebra 13th edition Bittinger Solutions Manual

7.
$$\begin{aligned} 6y+5 &> 3y-7 \\ 6y+5-3y &> 3y-7-3y \\ 3y+5 &> -7 \\ 3y+5-5 &> -7-5 \\ 3y &> -12 \\ \frac{3y}{3} &> \frac{-12}{3} \\ y &> -4 \end{aligned}$$
The solution set is $\{y|y > -4\}$.

Chapter 2 Review Exercises

1.
$$\begin{aligned} x+5 &= -17 \\ x+5-5 &= -17-5 \\ x &= -22 \end{aligned}$$
The solution is -22.

2.
$$\begin{aligned} n-7 &= -6 \\ n-7+7 &= -6+7 \\ n &= 1 \end{aligned}$$
The solution is 1.

3.
$$\begin{aligned} x-11 &= 14 \\ x-11+11 &= 14+11 \\ x &= 25 \end{aligned}$$
The solution is 25.

4.
$$\begin{aligned} y-0.9 &= 9.09 \\ y-0.9+0.9 &= 9.09+0.9 \\ y &= 9.99 \end{aligned}$$
The solution is 9.99.

5.
$$\begin{aligned} -\frac{2}{3}x &= -\frac{1}{6} \\ -\frac{3}{2}\cdot\left(-\frac{2}{3}x\right) &= -\frac{3}{2}\cdot\left(-\frac{1}{6}\right) \\ 1\cdot x &= \frac{\cancel{3}\cdot 1}{2\cdot 2\cdot \cancel{3}} \\ x &= \frac{1}{4} \end{aligned}$$
The solution is $\frac{1}{4}$.

6.
$$\begin{aligned} -8x &= -56 \\ \frac{-8x}{-8} &= \frac{-56}{-8} \\ x &= 7 \end{aligned}$$
The solution is 7.

7.
$$\begin{aligned} -\frac{x}{4} &= 48 \\ 4\cdot\frac{1}{4}\cdot(-x) &= 4\cdot 48 \\ -x &= 192 \\ -1\cdot(-1\cdot x) &= -1\cdot 192 \\ x &= -192 \end{aligned}$$
The solution is -192.

8.
$$\begin{aligned} 15x &= -35 \\ \frac{15x}{15} &= \frac{-35}{15} \\ x &= -\frac{\cancel{5}\cdot 7}{3\cdot\cancel{5}} \\ x &= -\frac{7}{3} \end{aligned}$$
The solution is $-\frac{7}{3}$.

9.
$$\begin{aligned} \frac{4}{5}y &= -\frac{3}{16} \\ \frac{5}{4}\cdot\frac{4}{5}y &= \frac{5}{4}\cdot\left(-\frac{3}{16}\right) \\ y &= -\frac{15}{64} \end{aligned}$$
The solution is $-\frac{15}{64}$.

10.
$$\begin{aligned} 5-x &= 13 \\ 5-x-5 &= 13-5 \\ -x &= 8 \\ -1\cdot(-1\cdot x) &= -1\cdot 8 \\ x &= -8 \end{aligned}$$
The solution is -8.

11.
$$\begin{aligned} \frac{1}{4}x-\frac{5}{8} &= \frac{3}{8} \\ \frac{1}{4}x-\frac{5}{8}+\frac{5}{8} &= \frac{3}{8}+\frac{5}{8} \\ \frac{1}{4}x &= 1 \\ 4\cdot\frac{1}{4}x &= 4\cdot 1 \\ x &= 4 \end{aligned}$$
The solution is 4.

12.
$$\begin{aligned} 5t+9 &= 3t-1 \\ 5t+9-3t &= 3t-1-3t \\ 2t+9 &= -1 \\ 2t+9-9 &= -1-9 \\ 2t &= -10 \\ \frac{2t}{2} &= \frac{-10}{2} \\ t &= -5 \end{aligned}$$
The solution is -5.

13.
$$\begin{aligned} 7x-6 &= 25x \\ 7x-6-7x &= 25x-7x \\ -6 &= 18x \\ \frac{-6}{18} &= \frac{18x}{18} \\ -\frac{\cancel{6}\cdot 1}{3\cdot\cancel{6}} &= x \\ -\frac{1}{3} &= x \end{aligned}$$
The solution is $-\frac{1}{3}$.

Copyright © 2019 Pearson Education, Inc.

Introductory Algebra 13th edition Bittinger Solutions Manual

14.
$$\begin{aligned} 14y &= 23y - 17 - 10 \\ 14y &= 23y - 27 \quad \text{Collecting like terms} \\ 14y - 23y &= 23y - 27 - 23y \\ -9y &= -27 \\ \frac{-9y}{-9} &= \frac{-27}{-9} \\ y &= 3 \end{aligned}$$
The solution is 3.

15.
$$\begin{aligned} 0.22y - 0.6 &= 0.12y + 3 - 0.8y \\ 0.22y - 0.6 &= -0.68y + 3 \quad \text{Collecting like terms} \\ 0.22y - 0.6 + 0.68y &= -0.68y + 3 + 0.68y \\ 0.9y - 0.6 &= 3 \\ 0.9y - 0.6 + 0.6 &= 3 + 0.6 \\ 0.9y &= 3.6 \\ \frac{0.9y}{0.9} &= \frac{3.6}{0.9} \\ y &= 4 \end{aligned}$$
The solution is 4.

16.
$$\begin{aligned} \frac{1}{4}x - \frac{1}{8}x &= 3 - \frac{1}{16}x \\ \frac{2}{8}x - \frac{1}{8}x &= 3 - \frac{1}{16}x \\ \frac{1}{8}x &= 3 - \frac{1}{16}x \\ \frac{1}{8}x + \frac{1}{16}x &= 3 - \frac{1}{16}x + \frac{1}{16}x \\ \frac{2}{16}x + \frac{1}{16}x &= 3 \\ \frac{3}{16}x &= 3 \\ \frac{16}{3} \cdot \frac{3}{16}x &= \frac{16}{3} \cdot 3 \\ x &= \frac{16 \cdot \cancel{3}}{\cancel{3} \cdot 1} \\ x &= 16 \end{aligned}$$
The solution is 16.

17.
$$\begin{aligned} 14y + 17 + 7y &= 9 + 21y + 8 \\ 21y + 17 &= 21y + 17 \\ 21y + 17 - 21y &= 21y + 17 - 21y \\ 17 &= 17 \qquad \text{TRUE} \end{aligned}$$
All real numbers are solutions.

18.
$$\begin{aligned} 4(x + 3) &= 36 \\ 4x + 12 &= 36 \\ 4x + 12 - 12 &= 36 - 12 \\ 4x &= 24 \\ \frac{4x}{4} &= \frac{24}{4} \\ x &= 6 \end{aligned}$$
The solution is 6.

19.
$$\begin{aligned} 3(5x - 7) &= -66 \\ 15x - 21 &= -66 \\ 15x - 21 + 21 &= -66 + 21 \\ 15x &= -45 \\ \frac{15x}{15} &= \frac{-45}{15} \\ x &= -3 \end{aligned}$$
The solution is -3.

20.
$$\begin{aligned} 8(x - 2) - 5(x + 4) &= 20 + x \\ 8x - 16 - 5x - 20 &= 20 + x \\ 3x - 36 &= 20 + x \\ 3x - 36 - x &= 20 + x - x \\ 2x - 36 &= 20 \\ 2x - 36 + 36 &= 20 + 36 \\ 2x &= 56 \\ \frac{2x}{2} &= \frac{56}{2} \\ x &= 28 \end{aligned}$$
The solution is 28.

21.
$$\begin{aligned} -5x + 3(x + 8) &= 16 \\ -5x + 3x + 24 &= 16 \\ -2x + 24 &= 16 \\ -2x + 24 - 24 &= 16 - 24 \\ -2x &= -8 \\ \frac{-2x}{-2} &= \frac{-8}{-2} \\ x &= 4 \end{aligned}$$
The solution is 4.

22.
$$\begin{aligned} 6(x - 2) - 16 &= 3(2x - 5) + 11 \\ 6x - 12 - 16 &= 6x - 15 + 11 \\ 6x - 28 &= 6x - 4 \\ 6x - 28 - 6x &= 6x - 4 - 6x \\ -28 &= -4 \qquad \text{False} \end{aligned}$$
There is no solution.

23. Since $-3 \le 4$ is true, -3 is a solution.

24. Since $7 \le 4$ is false, 7 is not a solution.

25. Since $4 \le 4$ is true, 4 is a solution.

26.
$$\begin{aligned} y + \frac{2}{3} &\ge \frac{1}{6} \\ y + \frac{2}{3} - \frac{2}{3} &\ge \frac{1}{6} - \frac{2}{3} \\ y &\ge \frac{1}{6} - \frac{4}{6} \\ y &\ge -\frac{3}{6} \\ y &\ge -\frac{1}{2} \end{aligned}$$
The solution set is $\left\{ y \middle| y \ge -\frac{1}{2} \right\}$.

Copyright © 2019 Pearson Education, Inc.

Introductory Algebra 13th edition Bittinger Solutions Manual

27.
$$\begin{aligned} 9x &\geq 63 \\ \frac{9x}{9} &\geq \frac{63}{9} \\ x &\geq 7 \end{aligned}$$
The solution set is $\{x|x \geq 7\}$.

28.
$$\begin{aligned} 2+6y &> 14 \\ 2+6y-2 &> 14-2 \\ 6y &> 12 \\ \frac{6y}{6} &> \frac{12}{6} \\ y &> 2 \end{aligned}$$
The solution set is $\{y|y > 2\}$.

29.
$$\begin{aligned} 7-3y &\geq 27+2y \\ 7-3y-2y &\geq 27+2y-2y \\ 7-5y &\geq 27 \\ 7-5y-7 &\geq 27-7 \\ -5y &\geq 20 \\ \frac{-5y}{-5} &\leq \frac{20}{-5} \quad \text{Reversing the inequality symbol} \\ y &\leq -4 \end{aligned}$$
The solution set is $\{y|y \leq -4\}$.

30.
$$\begin{aligned} 3x+5 &< 2x-6 \\ 3x+5-2x &< 2x-6-2x \\ x+5 &< -6 \\ x+5-5 &< -6-5 \\ x &< -11 \end{aligned}$$
The solution set is $\{x|x < -11\}$.

31.
$$\begin{aligned} -4y &< 28 \\ \frac{-4y}{-4} &> \frac{28}{-4} \quad \text{Reversing the inequality symbol} \\ y &> -7 \end{aligned}$$
The solution set is $\{y|y > -7\}$.

32.
$$\begin{aligned} 4-8x &< 13+3x \\ 4-8x-3x &< 13+3x-3x \\ 4-11x &< 13 \\ 4-11x-4 &< 13-4 \\ -11x &< 9 \\ \frac{-11x}{-11} &> \frac{9}{-11} \quad \text{Reversing the inequality symbol} \\ x &> -\frac{9}{11} \end{aligned}$$
The solution set is $\left\{x \middle| x > -\frac{9}{11}\right\}$.

33.
$$\begin{aligned} -4x &\leq \frac{1}{3} \\ -\frac{1}{4}\cdot(-4x) &\geq -\frac{1}{4}\cdot\frac{1}{3} \quad \text{Reversing the inequality symbol} \\ x &\geq -\frac{1}{12} \end{aligned}$$
The solution set is $\left\{x \middle| x \geq -\frac{1}{12}\right\}$.

34.
$$\begin{aligned} 4x-6 &< x+3 \\ 4x-6-x &< x+3-x \\ 3x-6 &< 3 \\ 3x-6+6 &< 3+6 \\ 3x &< 9 \\ \frac{3x}{3} &< \frac{9}{3} \\ x &< 3 \end{aligned}$$
The solution set is $\{x|x < 3\}$. The graph is as follows:

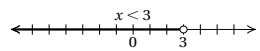

35. In order to be a solution of $-2 < x \leq 5$, a number must be a solution of both $-2 < x$ and $x \leq 5$. The solution set is graphed as follows:

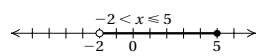

36. The solutions of $y > 0$ are those numbers greater than 0. The graph is as follows:

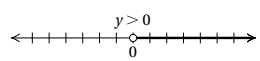

37.
$$\begin{aligned} C &= \pi d \\ \frac{C}{\pi} &= \frac{\pi d}{\pi} \\ \frac{C}{\pi} &= d \end{aligned}$$

38.
$$\begin{aligned} V &= \frac{1}{3}Bh \\ 3\cdot V &= 3\cdot\frac{1}{3}Bh \\ 3V &= Bh \\ \frac{3V}{h} &= \frac{Bh}{h} \\ \frac{3V}{h} &= B \end{aligned}$$

39.
$$\begin{aligned} A &= \frac{a+b}{2} \\ 2\cdot A &= 2\cdot\left(\frac{a+b}{2}\right) \\ 2A &= a+b \\ 2A-b &= a+b-b \\ 2A-b &= a \end{aligned}$$

Copyright © 2019 Pearson Education, Inc.

Introductory Algebra 13th edition Bittinger Solutions Manual

40.
$$\begin{aligned} y &= mx + b \\ y - b &= mx + b - b \\ y - b &= mx \\ \frac{y-b}{m} &= \frac{mx}{m} \\ \frac{y-b}{m} &= x \end{aligned}$$

41. ***Familiarize***. Let $w =$ the width, in miles. Then $w + 90 =$ the length. Recall that the perimeter P of a rectangle with length l and width w is given by $P = 2l + 2w$.

Translate. Substitute 1280 for P and $w + 90$ for l in the formula above.

$$\begin{aligned} P &= 2l + 2w \\ 1280 &= 2(w + 90) + 2w \end{aligned}$$

Solve. We solve the equation.

$$\begin{aligned} 1280 &= 2(w + 90) + 2w \\ 1280 &= 2w + 180 + 2w \\ 1280 &= 4w + 180 \\ 1280 - 180 &= 4w + 180 - 180 \\ 1100 &= 4w \\ \frac{1100}{4} &= \frac{4w}{4} \\ 275 &= w \end{aligned}$$

If $w = 275$, then $w + 90 = 275 + 90 = 365$.

Check. The length, 365 mi, is 90 mi more than the width, 275 mi. The perimeter is $2 \cdot 365$ mi $+ 2 \cdot 275$ mi $= 730$ mi $+$ 550 mi $= 1280$ mi. The answer checks.

State. The length is 365 mi, and the width is 275 mi.

42. ***Familiarize***. Let $x =$ the number on the first marker. Then $x + 1 =$ the number on the second marker.

Translate.

$$\underbrace{\text{First number}}_{x} \ \underset{+}{\text{plus}} \ \underbrace{\text{second number}}_{(x+1)} \ \underset{=}{\text{is}} \ 691.$$

Solve. We solve the equation.

$$\begin{aligned} x + (x + 1) &= 691 \\ 2x + 1 &= 691 \\ 2x + 1 - 1 &= 691 - 1 \\ 2x &= 690 \\ \frac{2x}{2} &= \frac{690}{2} \\ x &= 345 \end{aligned}$$

If $x = 345$, then $x + 1 = 345 + 1 = 346$.

Check. 345 and 346 are consecutive integers and $345 + 346 = 691$. The answer checks.

State. The numbers on the markers are 345 and 346.

43. ***Familiarize***. Let $c =$ the cost of the entertainment center in February.

Translate.

$$\underbrace{\text{Cost in February}}_{c} \ \underset{+}{\text{plus}} \ \underset{332}{\$332} \ \underset{=}{\text{is}} \ \underbrace{\text{Cost in June}}_{2449}$$

Solve. We solve the equation.

$$\begin{aligned} c + 332 &= 2449 \\ c + 332 - 332 &= 2449 - 332 \\ c &= 2117 \end{aligned}$$

Check. $\$2117 + \$332 = \$2449$, so the answer checks.

State. The entertainment center cost \$2117 in February.

44. ***Familiarize***. Let $a =$ the number of subscriptions Ty sold.

Translate.

$$\underbrace{\text{Commission per subscription}}_{4} \ \underset{\times}{\text{times}} \ \underbrace{\text{number sold}}_{a} \ \underset{=}{\text{is}} \ \underbrace{\text{Total commission}}_{108}$$

Solve. We solve the equation.

$$\begin{aligned} 4 \cdot a &= 108 \\ \frac{4 \cdot a}{4} &= \frac{108}{4} \\ a &= 27 \end{aligned}$$

Check. $\$4 \cdot 27 = \$108$, so the answer checks.

State. Ty sold 27 magazine subscriptions.

45. ***Familiarize.*** Let $x =$ the measure of the first angle. Then $x + 50 =$ the measure of the second angle, and $2x - 10 =$ the measure of the third angle. Recall that the sum of measures of the angles of a triangle is 180°.

Translate.

$$\underbrace{\text{Measure of first angle}}_{x} \ \underset{+}{+} \ \underbrace{\text{measure of second angle}}_{(x+50)} \ \underset{+}{+} \ \underbrace{\text{measure of third angle}}_{(2x-10)} \ \underset{=}{\text{is}} \ 180°.$$

Solve. We solve the equation.

$$\begin{aligned} x + (x + 50) + (2x - 10) &= 180 \\ 4x + 40 &= 180 \\ 4x + 40 - 40 &= 180 - 40 \\ 4x &= 140 \\ \frac{4x}{4} &= \frac{140}{4} \\ x &= 35 \end{aligned}$$

If $x = 35$, then $x + 50 = 35 + 50 = 85$ and $2x - 10 = 2 \cdot 35 - 10 = 70 - 10 = 60$.

Check. The measure of the second angle is 50° more than the measure of the first angle, and the measure of the third angle is 10° less than twice the measure of the first angle. The sum of the measure is 35° + 85° + 60° = 180°. The answer checks.

State. The measures of the angles are 35°, 85°, and 60°.

Copyright © 2019 Pearson Education, Inc.

Introductory Algebra 13th edition Bittinger Solutions Manual

46. *Translate.*

$$\underbrace{\text{What number}}_{\substack{\downarrow \\ a}} \text{ is } \underset{\substack{\downarrow \\ =}}{20\%} \text{ of } \underset{\substack{\downarrow \\ 20\%}}{75}?$$

Solve. We convert 20% to decimal notation and multiply.

$$a = 20\% \cdot 75$$
$$a = 0.2 \cdot 75$$
$$a = 15$$

Thus, 15 is 20% of 75.

47. *Translate.*

$$\underset{\substack{\downarrow \\ 15}}{15} \text{ is } \underset{\substack{\downarrow \\ =}}{\underbrace{\text{what percent}}_{\substack{\downarrow \\ p}}} \text{ of } \underset{\substack{\downarrow \\ \cdot}}{80}?$$

Solve. We solve the equation.

$$15 = p \cdot 80$$
$$\frac{15}{80} = \frac{p \cdot 80}{80}$$
$$0.1875 = p$$
$$18.75\% = p$$

Thus, 15 is 18.75% of 80.

48. *Translate.*

$$\underset{\substack{\downarrow \\ 18}}{18} \text{ is } \underset{\substack{\downarrow \\ =}}{3\%} \text{ of } \underset{\substack{\downarrow \\ \cdot}}{\underbrace{\text{what number}}_{\substack{\downarrow \\ b}}}?$$

Solve. We solve the equation.

$$18 = 3\% \cdot b$$
$$18 = 0.03 \cdot b$$
$$\frac{18}{0.03} = \frac{0.03 \cdot b}{0.03}$$
$$600 = b$$

Thus, 18 is 3% of 600.

49. We subtract to find the increase.

$$113 - 97 = 16$$

The increase is 16.

Now we find the percent increase.

$$\underset{\substack{\downarrow \\ 16}}{16} \text{ is } \underset{\substack{\downarrow \\ =}}{\underbrace{\text{what percent}}_{\substack{\downarrow \\ p}}} \text{ of } \underset{\substack{\downarrow \\ \cdot}}{97}?$$

We divide by 97 on both sides and then convert to percent notation.

$$16 = p \cdot 97$$
$$\frac{16}{97} = \frac{p \cdot 97}{97}$$
$$0.165 \approx p$$
$$16.5\% \approx p$$

The percent increase is about 16.5%.

50. We subtract to find the decrease, in billions.

$$102.4 - 62.4 = 40$$

Now we find the percent decrease.

$$\underset{\substack{\downarrow \\ 40}}{40} \text{ is } \underset{\substack{\downarrow \\ =}}{\underbrace{\text{what percent}}_{\substack{\downarrow \\ p}}} \text{ of } \underset{\substack{\downarrow \\ \cdot}}{102.4}?$$

We divide by 102.4 on both sides and then convert to percent notation.

$$40 = p \cdot 102.4$$
$$\frac{40}{102.4} = \frac{p \cdot 102.4}{102.4}$$
$$0.391 \approx p$$
$$39.1\% \approx p$$

The percent decrease is about 39.1%.

51. ***Familiarize.*** Let $p =$ the price before the reduction.

Translate.

$$\underbrace{\text{Price before reduction}}_{\substack{\downarrow \\ p}} \text{ minus } \underset{\substack{\downarrow \\ -}}{30\%} \text{ of } \underset{\substack{\downarrow \\ 30\%}}{\text{price}} \text{ is } \underset{\substack{\downarrow \\ \cdot}}{\$154}.$$

Solve. We solve the equation.

$$p - 30\% \cdot p = 154$$
$$p - 0.3p = 154$$
$$0.7p = 154$$
$$\frac{0.7p}{0.7} = \frac{154}{0.7}$$
$$p = 220$$

Check. 30% of \$220 is $0.3 \cdot \$220 = \$66$ and $\$220 - \$66 = \$154$, so the answer checks.

State. The price before the reduction was \$220.

52. ***Familiarize.*** Let $s =$ the previous salary.

Translate.

$$\underbrace{\text{Previous salary}}_{\substack{\downarrow \\ s}} \text{ plus } \underset{\substack{\downarrow \\ +}}{8\%} \text{ of } \underset{\substack{\downarrow \\ 8\%}}{\underbrace{\text{previous salary}}_{\substack{\downarrow \\ s}}} \text{ is } \underset{\substack{\downarrow \\ =}}{\$78,300}.$$

Solve. We solve the equation.

$$s + 8\% \cdot s = 78,300$$
$$s + 0.08s = 78,300$$
$$1.08s = 78,300$$
$$\frac{1.08s}{1.08} = \frac{78,300}{1.08}$$
$$s = 72,500$$

Check. 8% of $\$72,500 = 0.08 \cdot \$72,500 = \$5800$ and $\$72,500 + \$5800 = \$78,300$, so the answer checks.

State. The previous salary was \$72,500.

53. ***Familiarize.*** Let $a =$ the amount the organization actually owes. This is the price of the supplies without sales tax added. Then the incorrect amount is $a + 5\%$ of a, or $a + 0.05a$, or $1.05a$.

Translate.

$$\underbrace{\text{Incorrect amount}}_{\substack{\downarrow \\ 1.05a}} \text{ is } \underset{\substack{\downarrow \\ =}}{\$145.90}.$$

Copyright © 2019 Pearson Education, Inc.

Introductory Algebra 13th edition Bittinger Solutions Manual

Solve. We solve the equation.

$$\begin{aligned} 1.05a &= 145.90 \\ \frac{1.05a}{1.05} &= \frac{145.90}{1.05} \\ a &\approx 138.95 \end{aligned}$$

Check. 5% of \$138.95 is $0.05 \cdot \$138.95 \approx \$6.95$, and $\$138.95 + \$6.95 = \$145.90$, so the answer checks.

State. The organization actually owes \$138.95.

54. ***Familiarize***. Let s represent the score on the next test.

Translate.

$$\underbrace{\text{The average score}}_{\downarrow} \quad \underbrace{\text{is at least}}_{\downarrow} \quad \underset{\downarrow}{80}.$$

$$\frac{71+75+82+86+s}{5} \quad \geq \quad 80$$

Solve.

$$\begin{aligned} \frac{71+75+82+86+s}{5} &\geq 80 \\ 5\left(\frac{71+75+82+86+s}{5}\right) &\geq 5 \cdot 80 \\ 71+75+82+86+s &\geq 400 \\ 314+s &\geq 400 \\ s &\geq 86 \end{aligned}$$

Check. As a partial check we show that the average is at least 80 when the next test score is 86.

$$\frac{71+75+82+86+86}{5} = \frac{400}{5} = 80$$

State. The lowest grade Noah can get on the next test and have an average test score of 80 is 86.

55. ***Familiarize***. Let w represent the width of the rectangle, in cm. The perimeter is given by $P = 2l+2w$, or $2 \cdot 43+2w$, or $86+2w$.

Translate.

$$\underbrace{\text{The perimeter}}_{\downarrow} \quad \underbrace{\text{is greater than}}_{\downarrow} \quad \underbrace{\text{120 cm}}_{\downarrow}.$$

$$86+2w \quad > \quad 120$$

Solve.

$$\begin{aligned} 86+2w &> 120 \\ 2w &> 34 \\ w &> 17 \end{aligned}$$

Check. We check to see if the solution seems reasonable.

When $w = 16$ cm, $P = 2 \cdot 43 + 2 \cdot 16$, or 118 cm.

When $w = 17$ cm, $P = 2 \cdot 43 + 2 \cdot 17$, or 120 cm.

When $w = 18$ cm, $P = 2 \cdot 43 + 2 \cdot 18$, or 122 cm.

It appears that the solution is correct.

State. The solution set is $\{w | w > 17 \text{ cm}\}$.

56.

$$\begin{aligned} 4(3x-5)+6 &= 8+x \\ 12x-20+6 &= 8+x \\ 12x-14 &= 8+x \\ 12x-14-x &= 8+x-x \\ 11x-14 &= 8 \\ 11x-14+14 &= 8+14 \\ 11x &= 22 \\ \frac{11x}{11} &= \frac{22}{11} \\ x &= 2 \end{aligned}$$

The solution is 2. This is between 1 and 5, so the correct answer is C.

57.

$$\begin{aligned} 3x+4y &= P \\ 3x+4y-3x &= P-3x \\ 4y &= P-3x \\ \frac{4y}{4} &= \frac{P-3x}{4} \\ y &= \frac{P-3x}{4} \end{aligned}$$

Answer A is correct.

58.

$$\begin{aligned} 2|x|+4 &= 50 \\ 2|x| &= 46 \\ |x| &= 23 \end{aligned}$$

The solutions are the numbers whose distance from 0 is 23. Those numbers are -23 and 23.

59. $|3x| = 60$

The solutions are the values of x for which the distance of $3 \cdot x$ from 0 is 60. Then we have:

$$\begin{aligned} 3x &= -60 \quad \textit{or} \quad 3x = 60 \\ x &= -20 \quad \textit{or} \quad x = 20 \end{aligned}$$

The solutions are -20 and 20.

60.

$$\begin{aligned} y &= 2a-ab+3 \\ y-3 &= 2a-ab \\ y-3 &= a(2-b) \\ \frac{y-3}{2-b} &= a \end{aligned}$$

Chapter 2 Discussion and Writing Exercises

1. The end result is the same either way. If s is the original salary, the new salary after a 5% raise followed by an 8% raise is $1.08(1.05s)$. If the raises occur in the opposite order, the new salary is $1.05(1.08s)$. By the commutative and associate laws of multiplication, we see that these are equal. However, it would be better to receive the 8% raise first, because this increase yields a higher salary initially than a 5% raise.

2. No; Erin paid 75% of the original price and was offered credit for 125% of this amount, not to be used on sale items. Now 125% of 75% is 93.75%, so Erin would have a

Copyright © 2019 Pearson Education, Inc.

Introductory Algebra 13th edition Bittinger Solutions Manual

credit of 93.75% of the original price. Since this credit can be applied only to nonsale items, she has less purchasing power than if the amount she paid were refunded and she could spend it on sale items.

3. The inequalities are equivalent by the multiplication principle for inequalities. If we multiply both sides of one inequality by -1, the other inequality results.

4. For any pair of numbers, their relative position on the number line is reversed when both are multiplied by the same negative number. For example, -3 is to the left of 5 on the number line ($-3 < 5$), but 12 is to the right of -20. That is, $-3(-4) > 5(-4)$.

5. Answers may vary. Fran is more than 3 years older than Todd.

6. Let n represent "a number." Then "five more than a number" translates to $n + 5$, or $5 + n$, and "five is more than a number" translates to $5 > n$.

Chapter 2 Test

1.
$$\begin{aligned} x + 7 &= 15 \\ x + 7 - 7 &= 15 - 7 \\ x &= 8 \end{aligned}$$
The solution is 8.

2.
$$\begin{aligned} t - 9 &= 17 \\ t - 9 + 9 &= 17 + 9 \\ t &= 26 \end{aligned}$$
The solution is 26.

3.
$$\begin{aligned} 3x &= -18 \\ \frac{3x}{3} &= \frac{-18}{3} \\ x &= -6 \end{aligned}$$
The solution is -6.

4.
$$\begin{aligned} -\frac{4}{7}x &= -28 \\ -\frac{7}{4}\cdot\left(-\frac{4}{7}x\right) &= -\frac{7}{4}\cdot(-28) \\ x &= \frac{7\cdot\cancel{4}\cdot 7}{\cancel{4}\cdot 1} \\ x &= 49 \end{aligned}$$
The solution is 49.

5.
$$\begin{aligned} 3t + 7 &= 2t - 5 \\ 3t + 7 - 2t &= 2t - 5 - 2t \\ t + 7 &= -5 \\ t + 7 - 7 &= -5 - 7 \\ t &= -12 \end{aligned}$$
The solution is -12.

6.
$$\begin{aligned} \frac{1}{2}x - \frac{3}{5} &= \frac{2}{5} \\ \frac{1}{2}x - \frac{3}{5} + \frac{3}{5} &= \frac{2}{5} + \frac{3}{5} \\ \frac{1}{2}x &= 1 \\ 2\cdot\frac{1}{2}x &= 2\cdot 1 \\ x &= 2 \end{aligned}$$
The solution is 2.

7.
$$\begin{aligned} 8 - y &= 16 \\ 8 - y - 8 &= 16 - 8 \\ -y &= 8 \\ -1\cdot(-1\cdot y) &= -1\cdot 8 \\ y &= -8 \end{aligned}$$
The solution is -8.

8.
$$\begin{aligned} -\frac{2}{5} + x &= -\frac{3}{4} \\ -\frac{2}{5} + x + \frac{2}{5} &= -\frac{3}{4} + \frac{2}{5} \\ x &= -\frac{15}{20} + \frac{8}{20} \\ x &= -\frac{7}{20} \end{aligned}$$
The solution is $-\frac{7}{20}$.

9.
$$\begin{aligned} 3(x + 2) &= 27 \\ 3x + 6 &= 27 \\ 3x + 6 - 6 &= 27 - 6 \\ 3x &= 21 \\ \frac{3x}{3} &= \frac{21}{3} \\ x &= 7 \end{aligned}$$
The solution is 7.

10.
$$\begin{aligned} -3x - 6(x - 4) &= 9 \\ -3x - 6x + 24 &= 9 \\ -9x + 24 &= 9 \\ -9x + 24 - 24 &= 9 - 24 \\ -9x &= -15 \\ \frac{-9x}{-9} &= \frac{-15}{-9} \\ x &= \frac{\cancel{3}\cdot 5}{\cancel{3}\cdot 3} \\ x &= \frac{5}{3} \end{aligned}$$
The solution is $\frac{5}{3}$.

Copyright © 2019 Pearson Education, Inc.

Introductory Algebra 13th edition Bittinger Solutions Manual

11. We multiply by 10 to clear the decimals.

$$\begin{aligned}
0.4p + 0.2 &= 4.2p - 7.8 - 0.6p \\
10(0.4p + 0.2) &= 10(4.2p - 7.8 - 0.6p) \\
4p + 2 &= 42p - 78 - 6p \\
4p + 2 &= 36p - 78 \\
4p + 2 - 36p &= 36p - 78 - 36p \\
-32p + 2 &= -78 \\
-32p + 2 - 2 &= -78 - 2 \\
-32p &= -80 \\
\frac{-32p}{-32} &= \frac{-80}{-32} \\
p &= \frac{5 \cdot \cancel{16}}{2 \cdot \cancel{16}} \\
p &= \frac{5}{2}
\end{aligned}$$

The solution is $\frac{5}{2}$.

12.

$$\begin{aligned}
4(3x - 1) + 11 &= 2(6x + 5) - 8 \\
12x - 4 + 11 &= 12x + 10 - 8 \\
12x + 7 &= 12x + 2 \\
12x + 7 - 12x &= 12x + 2 - 12x \\
7 &= 2 \qquad \text{FALSE}
\end{aligned}$$

There are no solutions.

13.

$$\begin{aligned}
-2 + 7x + 6 &= 5x + 4 + 2x \\
7x + 4 &= 7x + 4 \\
7x + 4 - 7x &= 7x + 4 - 7x \\
4 &= 4 \qquad \text{TRUE}
\end{aligned}$$

All real numbers are solutions.

14.

$$\begin{aligned}
x + 6 &\le 2 \\
x + 6 - 6 &\le 2 - 6 \\
x &\le -4
\end{aligned}$$

The solution set is $\{x|x \le -4\}$.

15.

$$\begin{aligned}
14x + 9 &> 13x - 4 \\
14x + 9 - 13x &> 13x - 4 - 13x \\
x + 9 &> -4 \\
x + 9 - 9 &> -4 - 9 \\
x &> -13
\end{aligned}$$

The solution set is $\{x|x > -13\}$.

16.

$$\begin{aligned}
12x &\le 60 \\
\frac{12x}{12} &\le \frac{60}{12} \\
x &\le 5
\end{aligned}$$

The solution set is $\{x|x \le 5\}$.

17.

$$\begin{aligned}
-2y &\ge 26 \\
\frac{-2y}{-2} &\le \frac{26}{-2} \qquad \text{Reversing the inequality symbol} \\
y &\le -13
\end{aligned}$$

The solution set is $\{y|y \le -13\}$.

18.

$$\begin{aligned}
-4y &\le -32 \\
\frac{-4y}{-4} &\ge \frac{-32}{-4} \qquad \text{Reversing the inequality symbol} \\
y &\ge 8
\end{aligned}$$

The solution set is $\{y|y \ge 8\}$.

19.

$$\begin{aligned}
-5x &\ge \frac{1}{4} \\
-\frac{1}{5} \cdot (-5x) &\le -\frac{1}{5} \cdot \frac{1}{4} \qquad \text{Reversing the inequality symbol} \\
x &\le -\frac{1}{20}
\end{aligned}$$

The solution set is $\left\{x \middle| x \le -\frac{1}{20}\right\}$.

20.

$$\begin{aligned}
4 - 6x &> 40 \\
4 - 6x - 4 &> 40 - 4 \\
-6x &> 36 \\
\frac{-6x}{-6} &< \frac{36}{-6} \qquad \text{Reversing the inequality symbol} \\
x &< -6
\end{aligned}$$

The solution set is $\{x|x < -6\}$.

21.

$$\begin{aligned}
5 - 9x &\ge 19 + 5x \\
5 - 9x - 5x &\ge 19 + 5x - 5x \\
5 - 14x &\ge 19 \\
5 - 14x - 5 &\ge 19 - 5 \\
-14x &\ge 14 \\
\frac{-14x}{-14} &\le \frac{14}{-14} \qquad \text{Reversing the inequality symbol} \\
x &\le -1
\end{aligned}$$

The solution set is $\{x|x \le -1\}$.

22. The solutions of $y \le 9$ are shown by shading the point for 9 and all points to the left of 9. The closed circle at 9 indicates that 9 is part of the graph.

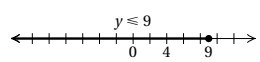

23.

$$\begin{aligned}
6x - 3 &< x + 2 \\
6x - 3 - x &< x + 2 - x \\
5x - 3 &< 2 \\
5x - 3 + 3 &< 2 + 3 \\
5x &< 5 \\
\frac{5x}{5} &< \frac{5}{5} \\
x &< 1
\end{aligned}$$

The solution set is $\{x|x < 1\}$. The graph is as follows:

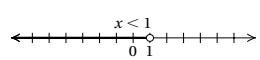

24. In order to be a solution of the inequality $-2 \le x \le 2$, a number must be a solution of both $-2 \le x$ and $x \le 2$. The solution set is graphed as follows:

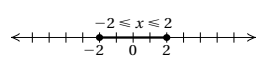

Copyright © 2019 Pearson Education, Inc.

Introductory Algebra 13th edition Bittinger Solutions Manual

25. *Translate.*

$$\begin{array}{ccccc} \underbrace{\text{What number}} & \text{is} & 24\% & \text{of} & 75? \\ \downarrow & \downarrow & \downarrow & \downarrow & \downarrow \\ a & = & 24\% & \cdot & 75 \end{array}$$

Solve. We convert 24% to decimal notation and multiply.

$$a = 24\% \cdot 75$$
$$a = 0.24 \cdot 75$$
$$a = 18$$

Thus, 18 is 24% of 75.

26. *Translate.*

$$\begin{array}{ccccc} 15.84 & \text{is} & \underbrace{\text{what percent}} & \text{of} & 96? \\ \downarrow & \downarrow & \downarrow & \downarrow & \downarrow \\ 15.84 & = & p & \cdot & 96 \end{array}$$

Solve.

$$15.84 = p \cdot 96$$
$$\frac{15.84}{96} = \frac{p \cdot 96}{96}$$
$$0.165 = p$$
$$16.5\% = p$$

Thus, 15.84 is 16.5% of 96.

27. *Translate.*

$$\begin{array}{ccccc} 800 & \text{is} & 2\% & \text{of} & \underbrace{\text{what number}}? \\ \downarrow & \downarrow & \downarrow & \downarrow & \downarrow \\ 800 & = & 2\% & \cdot & b \end{array}$$

Solve.

$$800 = 2\% \cdot b$$
$$800 = 0.02 \cdot b$$
$$\frac{800}{0.02} = \frac{0.02 \cdot b}{0.02}$$
$$40,000 = b$$

Thus, 800 is 2% of 40,000.

28. We subtract to find the increase.

$$2160 - 1670 = 490$$

Now we find the percent increase.

$$\begin{array}{ccccc} 490 & \text{is} & \underbrace{\text{what percent}} & \text{of} & 1670? \\ \downarrow & \downarrow & \downarrow & \downarrow & \downarrow \\ 490 & = & p & \cdot & 1670 \end{array}$$

We divide by 1670 on both sides and then convert to percent notation.

$$490 = p \cdot 1670$$
$$\frac{490}{1670} = \frac{p \cdot 1670}{1670}$$
$$0.293 \approx p$$
$$29.3\% \approx p$$

The percent increase is about 29.3%.

29. ***Familiarize.*** Let w = the width of the photograph, in cm. Then $w + 4$ = the length. Recall that the perimeter P of a rectangle with length l and width w is given by $P = 2l + 2w$.

Translate. We substitute 36 for P and $w + 4$ for l in the formula above.

$$P = 2l + 2w$$
$$36 = 2(w + 4) + 2w$$

Solve. We solve the equation.

$$36 = 2(w + 4) + 2w$$
$$36 = 2w + 8 + 2w$$
$$36 = 4w + 8$$
$$36 - 8 = 4w + 8 - 8$$
$$28 = 4w$$
$$\frac{28}{4} = \frac{4w}{4}$$
$$7 = w$$

If $w = 7$, then $w + 4 = 7 + 4 = 11$.

Check. The length, 11 cm, is 4 cm more than the width, 7 cm. The perimeter is $2 \cdot 11$ cm $+ 2 \cdot 7$ cm $= 22$ cm $+ 14$ cm $= 36$ cm. The answer checks.

State. The width is 7 cm, and the length is 11 cm.

30. ***Familiarize.*** Let t = the total cost of raising a child to age 17.

Translate.

$$\begin{array}{ccccc} \underbrace{\begin{array}{c}\text{Cost for child care}\\ \text{and K-12 education}\end{array}} & \text{is 18\% of} & \underbrace{\begin{array}{c}\text{Total}\\ \text{cost}\end{array}} \\ \downarrow & \downarrow\ \downarrow\ \downarrow & \downarrow \\ 41,500 & = 18\% \cdot & t \end{array}$$

Solve.

$$41,500 = 18\% \cdot t$$
$$41,500 = 0.18t$$
$$\frac{41,500}{0.18} = \frac{0.18t}{0.18}$$
$$230,556 \approx t$$

Check. 18% of \$230,556 is about \$41,500, so the answer checks.

State. The total cost of raising a child to age 17 is about \$230,556.

31. ***Familiarize.*** Let x = the first integer. Then $x + 1$ = the second and $x + 2$ = the third.

Translate.

$$\begin{array}{ccccccc} \underbrace{\begin{array}{c}\text{First}\\ \text{integer}\end{array}} & \text{plus} & \underbrace{\begin{array}{c}\text{second}\\ \text{integer}\end{array}} & \text{plus} & \underbrace{\begin{array}{c}\text{third}\\ \text{integer}\end{array}} & \text{is 7530.} \\ \downarrow & \downarrow & \downarrow & \downarrow & \downarrow & \downarrow\ \downarrow \\ x & + & (x+1) & + & (x+2) & = 7530 \end{array}$$

Solve.

$$x + (x + 1) + (x + 2) = 7530$$
$$3x + 3 = 7530$$
$$3x + 3 - 3 = 7530 - 3$$
$$3x = 7527$$
$$\frac{3x}{3} = \frac{7527}{3}$$
$$x = 2509$$

Copyright © 2019 Pearson Education, Inc.

Introductory Algebra 13th edition Bittinger Solutions Manual

If $x = 2509$, then $x + 1 = 2510$ and $x + 2 = 2511$.

Check. The numbers 2509, 2510, and 2511 are consecutive integers and 2509+2510+2511 = 7530. The answer checks.

State. The integers are 2509, 2510, and 2511.

32. ***Familiarize***. Let $x =$ the amount originally invested. Using the formula for simple interest, $I = Prt$, the interest earned in one year will be $x \cdot 5\% \cdot 1$, or $5\%x$.

Translate.

$$\underbrace{\text{Amount invested}}_{\downarrow\ x} \quad \underset{\downarrow\ +}{\text{plus}} \quad \underset{\downarrow\ 5\%x}{\text{interest}} \quad \underset{\downarrow\ =}{\text{is}} \quad \underbrace{\text{amount after 1 year.}}_{\downarrow\ 924}$$

Solve. We solve the equation.

$$\begin{aligned} x + 5\%x &= 924 \\ x + 0.05x &= 924 \\ 1.05x &= 924 \\ \frac{1.05x}{1.05} &= \frac{924}{1.05} \\ x &= 880 \end{aligned}$$

Check. 5% of \$880 is $0.05 \cdot \$880 = \$44$ and $\$880 + \$44 = \$924$, so the answer checks.

State. \$880 was originally invested.

33. ***Familiarize***. Using the labels on the drawing in the text, we let $x =$ the length of the shorter piece, in meters, and $x + 2 =$ the length of the longer piece.

Translate.

$$\underbrace{\text{Length of shorter piece}}_{\downarrow\ x} \quad \underset{\downarrow\ +}{\text{plus}} \quad \underbrace{\text{length of longer piece}}_{\downarrow\ (x+2)} \quad \underset{\downarrow\ =}{\text{is}} \quad \underset{\downarrow\ 8}{\underbrace{8\text{ m}}}.$$

Solve. We solve the equation.

$$\begin{aligned} x + (x + 2) &= 8 \\ 2x + 2 &= 8 \\ 2x + 2 - 2 &= 8 - 2 \\ 2x &= 6 \\ \frac{2x}{2} &= \frac{6}{2} \\ x &= 3 \end{aligned}$$

If $x = 3$, then $x + 2 = 3 + 2 = 5$.

Check. One piece is 2 m longer than the other and the sum of the lengths is 3 m+5 m, or 8 m. The answer checks.

State. The lengths of the pieces are 3 m and 5 m.

34. ***Familiarize***. Let $l =$ the length of the rectangle, in yd. The perimeter is given by $P = 2l + 2w$, or $2l + 2 \cdot 96$, or $2l + 192$.

Translate.

$$\underbrace{\text{The perimeter}}_{\downarrow\ 2l+192} \quad \underbrace{\text{is at least}}_{\downarrow\ \geq} \quad \underbrace{540\text{ yd}}_{\downarrow\ 540}.$$

Solve.

$$\begin{aligned} 2l + 192 &\geq 540 \\ 2l &\geq 348 \\ l &\geq 174 \end{aligned}$$

Check. We check to see if the solution seems reasonable.

When $l = 174$ yd, $P = 2 \cdot 174 + 2 \cdot 96$, or 540 yd.

When $l = 175$ yd, $P = 2 \cdot 175 + 2 \cdot 96$, or 542 yd.

It appears that the solution is correct.

State. For lengths that are at least 174 yd, the perimeter will be at least 540 yd. The solution set can be expressed as $\{l | l \geq 174 \text{ yd}\}$.

35. ***Familiarize***. Let $s =$ the amount Jason spends in the sixth month.

Translate.

$$\underbrace{\text{Average spending}}_{\downarrow\ \frac{98+89+110+85+83+s}{6}} \quad \underbrace{\text{is no more than}}_{\downarrow\ \leq} \quad \underset{\downarrow\ 95}{\$95}.$$

Solve.

$$\begin{aligned} \frac{98+89+110+85+83+s}{6} &\leq 95 \\ 6\left(\frac{98+89+110+85+83+s}{6}\right) &\leq 6 \cdot 95 \\ 98+89+110+85+83+s &\leq 570 \\ 465 + s &\leq 570 \\ s &\leq 105 \end{aligned}$$

Check. As a partial check we show that the average spending is \$95 when Jason spends \$105 in the sixth month.

$$\frac{98+89+110+85+83+105}{6} = \frac{570}{6} = 95$$

State. Jason can spend no more than \$105 in the sixth month. The solution set can be expressed as $\{s | s \leq \$105\}$.

36. ***Familiarize***. Let $c =$ the number of copies made. For 3 months, the rental charge is $3 \cdot \$225$, or \$675. Expressing 3.2¢ as \$0.032, the charge for the copies is given by $\$0.032 \cdot c$.

Translate.

$$\underbrace{\text{Rental charge}}_{\downarrow\ 675} \quad \underset{\downarrow\ +}{\text{plus}} \quad \underbrace{\text{copy charge}}_{\downarrow\ 0.032c} \quad \underbrace{\text{is no more than}}_{\downarrow\ \leq} \quad \underset{\downarrow\ 4500}{\$4500}.$$

Solve.

$$\begin{aligned} 675 + 0.032c &\leq 4500 \\ 0.032c &\leq 3825 \\ c &\leq 119,531 \end{aligned}$$

Check. We check to see if the solution seems reasonable.

When $c = 119,530$, the total cost is $\$675 + \$0.032(119,530)$, or about \$4499.96.

When $c = 119,532$, the total cost is $\$675 + \$0.032(119,532)$, or about \$4500.02.

Copyright © 2019 Pearson Education, Inc.

Introductory Algebra 13th edition Bittinger Solutions Manual

It appears that the solution is correct.

State. No more than 119,531 copies can be made. The solution set can be expressed as $\{c|c \le 119,531\}$.

37.
$$\begin{aligned} A &= 2\pi rh \\ \frac{A}{2\pi h} &= \frac{2\pi rh}{2\pi h} \\ \frac{A}{2\pi h} &= r \end{aligned}$$

38.
$$\begin{aligned} y &= 8x + b \\ y - b &= 8x + b - b \\ y - b &= 8x \\ \frac{y-b}{8} &= \frac{8x}{8} \\ \frac{y-b}{8} &= x \end{aligned}$$

39. We subtract to find the increase, in millions.

$$70.3 - 40.4 = 29.9$$

Now we find the percent increase.

$$\begin{array}{ccccc} 29.9 & \text{is} & \underbrace{\text{what percent}} & \text{of} & 40.4? \\ \downarrow & \downarrow & \downarrow & \downarrow & \downarrow \\ 29.9 & = & p & \cdot & 40.4 \end{array}$$

We divide by 40.4 on both sides and then convert to percent notation.

$$\begin{aligned} 29.9 &= p \cdot 40.4 \\ \frac{29.9}{40.4} &= \frac{p \cdot 40.4}{40.4} \\ 0.74 &\approx p \\ 74\% &\approx p \end{aligned}$$

The percent increase is about 74%. Answer D is correct.

40.
$$\begin{aligned} c &= \frac{1}{a-d} \\ (a-d)\cdot c &= a - d \cdot \left(\frac{1}{a-d}\right) \\ ac - dc &= 1 \\ ac - dc - ac &= 1 - ac \\ -dc &= 1 - ac \\ \frac{-dc}{-c} &= \frac{1-ac}{-c} \\ d &= \frac{1-ac}{-c} \end{aligned}$$

Since $\frac{1-ac}{-c} = \frac{-1}{-1} \cdot \frac{1-ac}{-c} = \frac{-1(1-ac)}{-1(-c)} = \frac{-1+ac}{c}$, or $\frac{ac-1}{c}$, we can also express the result as $d = \frac{ac-1}{c}$.

41.
$$\begin{aligned} 3|w| - 8 &= 37 \\ 3|w| &= 45 \\ |w| &= 15 \end{aligned}$$

The solutions are the numbers whose distance from 0 is 15. They are -15 and 15.

42. ***Familiarize***. Let t = the number of tickets given away.

Translate. We add the number of tickets given to the five people.

$$\frac{1}{3}t + \frac{1}{4}t + \frac{1}{5}t + 8 + 5 = t$$

Solve.

$$\begin{aligned} \frac{1}{3}t + \frac{1}{4}t + \frac{1}{5}t + 8 + 5 &= t \\ \frac{20}{60}t + \frac{15}{60}t + \frac{12}{60}t + 8 + 5 &= t \\ \frac{47}{60}t + 13 &= t \\ 13 &= t - \frac{47}{60}t \\ 13 &= \frac{60}{60}t - \frac{47}{60}t \\ 13 &= \frac{13}{60}t \\ \frac{60}{13} \cdot 13 &= \frac{60}{13} \cdot \frac{13}{60}t \\ 60 &= t \end{aligned}$$

Check. $\frac{1}{3} \cdot 60 = 20$, $\frac{1}{4} \cdot 60 = 15$, $\frac{1}{5} \cdot 60 = 12$; then $20 + 15 + 12 + 8 + 5 = 60$. The answer checks.

State. 60 tickets were given away.

Cumulative Review Chapters 1 - 2

1. $\frac{y-x}{4} = \frac{12-6}{4} = \frac{6}{4} = \frac{\cancel{2} \cdot 3}{\cancel{2} \cdot 2} = \frac{3}{2}$

2. $\frac{3x}{y} = \frac{3 \cdot 5}{4} = \frac{15}{4}$

3. $x - 3 = 3 - 3 = 0$

4. $2w - 4$

5. Since -4 is to the right of -6, we have $-4 > -6$.

6. Since 0 is to the right of -5, we have $0 > -5$.

7. Since -8 is to the left of 7, we have $-8 < 7$.

8. The opposite of $\frac{2}{5}$ is $-\frac{2}{5}$ because $\frac{2}{5} + \left(-\frac{2}{5}\right) = 0$.

The reciprocal of $\frac{2}{5}$ is $\frac{5}{2}$ because $\frac{2}{5} \cdot \frac{5}{2} = 1$.

9. The distance of 3 from 0 is 3, so $|3| = 3$.

10. The distance of $-\frac{3}{4}$ from 0 is $\frac{3}{4}$, so $\left|-\frac{3}{4}\right| = \frac{3}{4}$.

11. The distance of 0 from 0 is 0, so $|0| = 0$.

12. $-6.7 + 2.3$

One negative number and one positive number. The absolute values are 6.7 and 2.3. The difference of the absolute values is $6.7 - 2.3 = 4.4$. The negative number has the larger absolute value, so the sum is negative.

$-6.7 + 2.3 = -4.4$

Copyright © 2019 Pearson Education, Inc.

Introductory Algebra 13th edition Bittinger Solutions Manual

13. $-\frac{1}{6}-\frac{7}{3}=-\frac{1}{6}+\left(-\frac{7}{3}\right)=-\frac{1}{6}+\left(-\frac{14}{6}\right)=-\frac{15}{6}=$
$-\frac{\cancel{3}\cdot 5}{2\cdot\cancel{3}}=-\frac{5}{2}$

14. $-\frac{5}{8}\left(-\frac{4}{3}\right)=\frac{5\cdot 4}{8\cdot 3}=\frac{5\cdot\cancel{4}}{2\cdot\cancel{4}\cdot 3}=\frac{5}{6}$

15. $(-7)(5)(-6)(-0.5)=-35(3)=-105$

16. $81\div(-9)=-9$

17. $-10.8\div 3.6=-3$

18. $-\frac{4}{5}\div-\frac{25}{8}=-\frac{4}{5}\cdot-\frac{8}{25}=\frac{4\cdot 8}{5\cdot 25}=\frac{32}{125}$

19. $5(3x+5y+2z)=5\cdot 3x+5\cdot 5y+5\cdot 2z=$
$15x+25y+10z$

20. $4(-3x-2)=4(-3x)-4\cdot 2=-12x-8$

21. $-6(2y-4x)=-6\cdot 2y-(-6)(4x)=-12y-(-24x)=$
$-12y+24x$

22. $64+18x+24y=2\cdot 32+2\cdot 9x+2\cdot 12y=2(32+9x+12y)$

23. $16y-56=8\cdot 2y-8\cdot 7=8(2y-7)$

24. $5a-15b+25=5\cdot a-5\cdot 3b+5\cdot 5=5(a-3b+5)$

25.
$$\begin{aligned}9b+18y+6b+4y&=9b+6b+18y+4y\\&=(9+6)b+(18+4)y\\&=15b+22y\end{aligned}$$

26.
$$\begin{aligned}3y+4+6z+6y&=3y+6y+4+6z\\&=(3+6)y+4+6z\\&=9y+4+6z\end{aligned}$$

27.
$$\begin{aligned}-4d-6a+3a-5d+1&=-4d-5d-6a+3a+1\\&=(-4-5)d+(-6+3)a+1\\&=-9d-3a+1\end{aligned}$$

28.
$$\begin{aligned}3.2x+2.9y-5.8x-8.1y&=3.2x-5.8x+2.9y-8.1y\\&=(3.2-5.8)x+(2.9-8.1)y\\&=-2.6x-5.2y\end{aligned}$$

29. $7-2x-(-5x)-8=7-2x+5x-8=-1+3x$

30. $-3x-(-x+y)=-3x+x-y=-2x-y$

31. $-3(x-2)-4x=-3x+6-4x=-7x+6$

32. $10-2(5-4x)=10-10+8x=8x$

33.
$$\begin{aligned}&[3(x+6)-10]-[5-2(x-8)]\\&=[3x+18-10]-[5-2x+16]\\&=[3x+8]-[21-2x]\\&=3x+8-21+2x\\&=5x-13\end{aligned}$$

34.
$$\begin{aligned}x+1.75&=6.25\\x+1.75-1.75&=6.25-1.75\\x&=4.5\end{aligned}$$
The solution is 4.5.

35.
$$\begin{aligned}\frac{5}{2}y&=\frac{2}{5}\\\frac{2}{5}\cdot\frac{5}{2}y&=\frac{2}{5}\cdot\frac{2}{5}\\y&=\frac{4}{25}\end{aligned}$$
The solution is $\frac{4}{25}$.

36.
$$\begin{aligned}-2.6+x&=8.3\\-2.6+x+2.6&=8.3+2.6\\x&=10.9\end{aligned}$$
The solution is 10.9.

37.
$$\begin{aligned}4\frac{1}{2}+y&=8\frac{1}{3}\\4\frac{1}{2}+y-4\frac{1}{2}&=8\frac{1}{3}-4\frac{1}{2}\\y&=8\frac{2}{6}-4\frac{3}{6}\\y&=7\frac{8}{6}-4\frac{3}{6}\quad\left(8\frac{2}{6}=7+1\frac{2}{6}=7+\frac{8}{6}=7\frac{8}{6}\right)\\y&=3\frac{5}{6}\end{aligned}$$
The solution is $3\frac{5}{6}$.

38.
$$\begin{aligned}-\frac{3}{4}x&=36\\-\frac{4}{3}\left(-\frac{3}{4}x\right)&=-\frac{4}{3}\cdot 36\\x&=-\frac{4\cdot 36}{3}=-\frac{4\cdot\cancel{3}\cdot 12}{\cancel{3}\cdot 1}\\x&=-48\end{aligned}$$
The solution is -48.

39.
$$\begin{aligned}\frac{2}{5}x&=-\frac{3}{20}\\\frac{5}{2}\cdot\frac{2}{5}x&=\frac{5}{2}\left(-\frac{3}{20}\right)\\x&=-\frac{3\cdot\cancel{5}}{2\cdot 4\cdot\cancel{5}}\\x&=-\frac{3}{8}\end{aligned}$$
The solution is $-\frac{3}{8}$.

40.
$$\begin{aligned}5.8x&=-35.96\\\frac{5.8x}{5.8}&=\frac{-35.96}{5.8}\\x&=-6.2\end{aligned}$$
The solution is -6.2.

41.
$$\begin{aligned}-4x+3&=15\\-4x+3-3&=15-3\\-4x&=12\\\frac{-4x}{-4}&=\frac{12}{-4}\\x&=-3\end{aligned}$$
The solution is -3.

Copyright © 2019 Pearson Education, Inc.

Introductory Algebra 13th edition Bittinger Solutions Manual

42.
$$\begin{aligned} -3x+5 &= -8x-7 \\ -3x+5+8x &= -8x-7+8x \\ 5x+5 &= -7 \\ 5x+5-5 &= -7-5 \\ 5x &= -12 \\ \frac{5x}{5} &= \frac{-12}{5} \\ x &= -\frac{12}{5} \end{aligned}$$
The solution is $-\frac{12}{5}$.

43.
$$\begin{aligned} 4y-4+y &= 6y+20-4y \\ 5y-4 &= 2y+20 \\ 5y-4-2y &= 2y+20-2y \\ 3y-4 &= 20 \\ 3y-4+4 &= 20+4 \\ 3y &= 24 \\ \frac{3y}{3} &= \frac{24}{3} \\ y &= 8 \end{aligned}$$
The solution is 8.

44.
$$\begin{aligned} -3(x-2) &= -15 \\ -3x+6 &= -15 \\ -3x+6-6 &= -15-6 \\ -3x &= -21 \\ \frac{-3x}{-3} &= \frac{-21}{-3} \\ x &= 7 \end{aligned}$$
The solution is 7.

45. First we will multiply by the least common multiple of all the denominators to clear the fractions.
$$\begin{aligned} \frac{1}{3}x-\frac{5}{6} &= \frac{1}{2}+2x \\ 6\left(\frac{1}{3}x-\frac{5}{6}\right) &= 6\left(\frac{1}{2}+2x\right) \\ 6\cdot\frac{1}{3}x-6\cdot\frac{5}{6} &= 6\cdot\frac{1}{2}+6\cdot 2x \\ 2x-5 &= 3+12x \\ 2x-5-12x &= 3+12x-12x \\ -10x-5 &= 3 \\ -10x-5+5 &= 3+5 \\ -10x &= 8 \\ \frac{-10x}{-10} &= \frac{8}{-10} \\ x &= -\frac{8}{10} = -\frac{\cancel{2}\cdot 4}{\cancel{2}\cdot 5} \\ x &= -\frac{4}{5} \end{aligned}$$
The solution is $-\frac{4}{5}$.

46. First we will multiply by 10 to clear the decimals.
$$\begin{aligned} -3.7x+6.2 &= -7.3x-5.8 \\ 10(-3.7x+6.2) &= 10(-7.3x-5.8) \\ -37x+62 &= -73x-58 \\ -37x+62+73x &= -73x-58+73x \\ 36x+62 &= -58 \\ 36x+62-62 &= -58-62 \\ 36x &= -120 \\ \frac{36x}{36} &= \frac{-120}{36} \\ x &= -\frac{10\cdot\cancel{12}}{3\cdot\cancel{12}} \\ x &= -\frac{10}{3} \end{aligned}$$
The solution is $-\frac{10}{3}$.

47.
$$\begin{aligned} 4(x+2) &= 4(x-2)+16 \\ 4x+8 &= 4x-8+16 \\ 4x+8 &= 4x+8 \\ 4x+8-4x &= 4x+8-4x \\ 8 &= 8 \qquad \text{TRUE} \end{aligned}$$
All real numbers are solutions.

48.
$$\begin{aligned} 0(x+3)+4 &= 0 \\ 0+4 &= 0 \\ 4 &= 0 \qquad \text{FALSE} \end{aligned}$$
There is no solution.

49.
$$\begin{aligned} 3x-1 &< 2x+1 \\ 3x-1-2x &< 2x+1-2x \\ x-1 &< 1 \\ x-1+1 &< 1+1 \\ x &< 2 \end{aligned}$$
The solution set is $\{x|x<2\}$.

50.
$$\begin{aligned} 3y+7 &> 5y+13 \\ 3y+7-5y &> 5y+13-5y \\ -2y+7 &> 13 \\ -2y+7-7 &> 13-7 \\ -2y &> 6 \\ \frac{-2y}{-2} &< \frac{6}{-2} \qquad \text{Reversing the inequality symbol} \\ y &< -3 \end{aligned}$$
The solution set is $\{y|y<-3\}$.

Copyright © 2019 Pearson Education, Inc.

Introductory Algebra 13th edition Bittinger Solutions Manual

51.
$$\begin{aligned} 5-y &\le 2y-7 \\ 5-y-2y &\le 2y-7-2y \\ 5-3y &\le -7 \\ 5-3y-5 &\le -7-5 \\ -3y &\le -12 \\ \frac{-3y}{-3} &\ge \frac{-12}{-3} \quad \text{Reversing the inequality symbol} \\ y &\ge 4 \end{aligned}$$

The solution set is $\{y|y \ge 4\}$.

52.
$$\begin{aligned} H &= 65-m \\ H-65 &= 65-m-65 \\ H-65 &= -m \\ -1(H-65) &= -1\cdot(-1\cdot m) \\ -H+65 &= m, \text{ or} \\ 65-H &= m \end{aligned}$$

53.
$$\begin{aligned} I &= Prt \\ \frac{I}{Pr} &= \frac{Prt}{Pr} \\ \frac{I}{Pr} &= t \end{aligned}$$

54. *Translate.*

$$\underbrace{\text{What number}}_{\substack{\downarrow \\ a}} \text{ is } \underset{\substack{\downarrow \\ =}}{24\%} \text{ of } \underset{\substack{\downarrow \\ 24\%}}{105}?$$

$$\begin{array}{ccccc} \downarrow & \downarrow & \downarrow & \downarrow & \downarrow \\ a & = & 24\% & \cdot & 105 \end{array}$$

Solve. We convert 24% to decimal notation and multiply.

$$\begin{aligned} a &= 24\%\cdot 105 \\ a &= 0.24\cdot 105 \\ a &= 25.2 \end{aligned}$$

Thus, 25.2 is 24% of 105.

55. *Translate.*

$$\underset{\substack{\downarrow \\ 39.6}}{39.6} \text{ is } \underbrace{\text{what percent}}_{\substack{\downarrow \\ p}} \text{ of } \underset{\substack{\downarrow \\ \cdot}}{88}?$$

$$\begin{array}{ccccc} \downarrow & \downarrow & \downarrow & \downarrow & \downarrow \\ 39.6 & = & p & \cdot & 88 \end{array}$$

Solve. We solve the equation.

$$\begin{aligned} 39.6 &= p\cdot 88 \\ \frac{39.6}{88} &= \frac{p\cdot 88}{88} \\ 0.45 &= p \\ 45\% &= p \end{aligned}$$

Thus, 39.6 is 45% of 88.

56. ***Translate.***

$$\underset{\substack{\downarrow \\ 163.35}}{\$163.35} \text{ is } \underset{\substack{\downarrow \\ =}}{45\%} \text{ of } \underbrace{\text{what number}}_{\substack{\downarrow \\ b}}?$$

$$\begin{array}{ccccc} \downarrow & \downarrow & \downarrow & \downarrow & \downarrow \\ 163.35 & = & 45\% & \cdot & b \end{array}$$

Solve.

$$\begin{aligned} 163.35 &= 45\%\cdot b \\ 163.35 &= 0.45\cdot b \\ \frac{163.35}{0.45} &= \frac{0.45\cdot b}{0.45} \\ 363 &= b \end{aligned}$$

Thus, \$163.35 is 45% of \$363.

57. ***Familiarize.*** Let $p =$ the price before the reduction.

Translate.

$$\underbrace{\text{Price before reduction}}_{\substack{\downarrow \\ p}} \text{ minus } \underset{\substack{\downarrow \\ -}}{25\%} \text{ of } \underset{\substack{\downarrow \\ 25\%}}{\text{price}} \text{ is } \underset{\substack{\downarrow \\ \cdot}}{\$18.45}.$$

$$\begin{array}{ccccccc} \downarrow & \downarrow & \downarrow & \downarrow & \downarrow & \downarrow & \downarrow \\ p & - & 25\% & \cdot & p & = & 18.45 \end{array}$$

Solve. We solve the equation.

$$\begin{aligned} p-25\%\cdot p &= 18.45 \\ p-0.25p &= 18.45 \\ 0.75p &= 18.45 \\ \frac{0.75p}{0.75p} &= \frac{18.45}{0.75} \\ p &= 24.6 \end{aligned}$$

Check. 25% of \$24.60 is $0.25\cdot\$24.60 = \$6.15$ and $\$24.60 - \$6.15 = \$18.45$, so the answer checks.

State. The price before the reduction was \$24.60.

58. ***Familiarize.*** Let $m =$ the amount Melinda paid for her rollerblades. Then $m+17 =$ the amount Susan paid for hers.

Translate.

$$\underbrace{\text{Amount Melinda paid}}_{\substack{\downarrow \\ m}} \text{ plus } \underbrace{\text{amount Susan paid}}_{\substack{\downarrow \\ (m+17)}} \text{ is } \underset{\substack{\downarrow \\ =}}{\$107}.$$

$$\begin{array}{ccccc} \downarrow & \downarrow & \downarrow & \downarrow & \downarrow \\ m & + & (m+17) & = & 107 \end{array}$$

Solve.

$$\begin{aligned} m+(m+17) &= 107 \\ 2m+17 &= 107 \\ 2m+17-17 &= 107-17 \\ 2m &= 90 \\ \frac{2m}{2} &= \frac{90}{2} \\ m &= 45 \end{aligned}$$

The exercise asks only for the amount Melinda paid, but we also find the amount Susan paid so that we can check the answer.

If $m = 45$, then $m+17 = 45+17 = 62$.

Check. \$62 is \$17 more than \$45, and $\$45 + \$62 = \$107$. The answer checks.

State. Melinda paid \$45 for her rollerblades.

59. ***Familiarize.*** Let $x =$ the amount originally invested. Using the formula for simple interest, $I = Prt$, the interest earned in one year will be $x\cdot 8\%\cdot 1$, or $8\%x$.

Copyright © 2019 Pearson Education, Inc.

Introductory Algebra 13th edition Bittinger Solutions Manual

Translate.

$$\underbrace{\text{Amount invested}}_{\substack{\downarrow\\ x}} \quad \underset{\substack{\downarrow\\ +}}{\text{plus}} \quad \underset{\substack{\downarrow\\ 8\%x}}{\text{interest}} \quad \underset{\substack{\downarrow\\ =}}{\text{is}} \quad \underbrace{\text{amount after 1 year.}}_{\substack{\downarrow\\ 1134}}$$

Solve.

$$\begin{aligned} x + 8\%x &= 1134 \\ x + 0.08x &= 1134 \\ 1.08x &= 1134 \\ \frac{1.08x}{1.08} &= \frac{1134}{1.08} \\ x &= 1050 \end{aligned}$$

Check. 8% of \$1050 is $0.08 \cdot \$1050 = \$84$ and $\$1050 + \$84 = \$1134$, so the answer checks.

State. \$1050 was originally invested.

60. ***Familiarize***. Let l = the length of the first piece of wire, in meters. Then $l + 3$ = the length of the second piece and $\frac{4}{5}l$ = the length of the third piece.

Translate.

$$\underbrace{\text{Length of first piece}}_{\substack{\downarrow\\ l}} \quad \underset{\substack{\downarrow\\ +}}{\text{plus}} \quad \underbrace{\text{length of second piece}}_{\substack{\downarrow\\ (l+3)}} \quad \underset{\substack{\downarrow\\ +}}{\text{plus}} \quad \underbrace{\text{length of third piece}}_{\substack{\downarrow\\ \frac{4}{5}l}} \quad \underset{\substack{\downarrow\\ =}}{\text{is}} \quad \underbrace{143 \text{ m}}_{\substack{\downarrow\\ 143}}.$$

Solve.

$$\begin{aligned} l + (l+3) + \frac{4}{5}l &= 143 \\ \frac{5}{5}l + \frac{5}{5}l + 3 + \frac{4}{5}l &= 143 \\ \frac{14}{5}l + 3 &= 143 \\ \frac{14}{5}l + 3 - 3 &= 143 - 3 \\ \frac{14}{5}l &= 140 \\ \frac{5}{14} \cdot \frac{14}{5}l &= \frac{5}{14} \cdot 140 \\ l &= \frac{5 \cdot 10 \cdot \cancel{14}}{\cancel{14} \cdot 1} \\ l &= 50 \end{aligned}$$

If $l = 50$, then $l + 3 = 50 + 3 = 53$ and $\frac{4}{5}l = \frac{4}{5} \cdot 50 = 40$.

Check. The second piece is 3 m longer than the first piece and the third piece is $\frac{4}{5}$ as long as the first. Also, 50 m + 53 m + 40 m = 143 m. The answer checks.

State. The lengths of the pieces are 50 m, 53 m, and 40 m.

61. ***Familiarize***. Let s = Nadia's score on the fourth test.

Translate.

$$\underbrace{\text{The average score}}_{\substack{\downarrow\\ \frac{82+76+78+s}{4}}} \quad \underbrace{\text{is at least}}_{\substack{\downarrow\\ \geq}} \quad \underset{\substack{\downarrow\\ 80}}{80}.$$

Solve.

$$\begin{aligned} \frac{82+76+78+s}{4} &\geq 80 \\ 4\left(\frac{82+76+78+s}{4}\right) &\geq 4 \cdot 80 \\ 82+76+78+s &\geq 320 \\ 236 + s &\geq 320 \\ s &\geq 84 \end{aligned}$$

Check. As a partial check we show that the average is at least 80 when the fourth test score is 84.

$$\frac{82+76+78+84}{4} = \frac{320}{4} = 80$$

State. Scores greater than or equal to 84 will earn Nadia at least a B. The solution set is $\{s | s \geq 84\}$.

62.

$$\begin{aligned} -125 \div 25 \cdot 625 \div 5 &= -5 \cdot 625 \div 5 \\ &= -3125 \div 5 \\ &= -625 \end{aligned}$$

Answer C is correct.

63. ***Familiarize***. Let s = the salary at the beginning of the year. After a 4% increase the new salary is $s + 4\%s$, or $s + 0.04s$, or $1.04s$. Then after a 3% cost-of-living adjustment the final salary is $1.04s + 3\% \cdot 1.04s$, or $1.04s + 0.03 \cdot 1.04s$, or $1.04s + 0.0312s$, or $1.0712s$.

Translate.

$$\underbrace{\text{Final salary}}_{\substack{\downarrow\\ 1.0712s}} \quad \underset{\substack{\downarrow\\ =}}{\text{is}} \quad \underset{\substack{\downarrow\\ 48,418.24}}{\$48,418.24}.$$

Solve.

$$\begin{aligned} 1.0712s &= 48,418.24 \\ \frac{1.0712s}{1.0712} &= \frac{48,418.24}{1.0712} \\ s &= 45,200 \end{aligned}$$

Check. 4% of \$45,200 is $0.04 \cdot \$45,200 = \$1808$ and $\$45,200 + \$1808 = \$47,008$. Then 3% of \$47,008 is $0.03 \cdot \$47,008 = \$1410.24$ and $\$47,008 + \$1410.24 = \$48,418.24$. The answer checks.

State. At the beginning of the year the salary was \$45,200.

64. First we subtract to find the amount of the reduction.

9 in. − 6.3 in. = 2.7 in.

Translate.

$$\underbrace{2.7 \text{ in.}}_{\substack{\downarrow\\ 2.7}} \quad \underset{\substack{\downarrow\\ =}}{\text{is}} \quad \underbrace{\text{what percent}}_{\substack{\downarrow\\ p}} \quad \underset{\substack{\downarrow\\ \cdot}}{\text{of}} \quad \underbrace{9 \text{ in.}}_{\substack{\downarrow\\ 9}}?$$

Solve.

$$\begin{aligned} 2.7 &= p \cdot 9 \\ \frac{2.7}{9} &= \frac{p \cdot 9}{9} \\ 0.3 &= p \\ 30\% &= p \end{aligned}$$

The drawing should be reduced 30%.

Copyright © 2019 Pearson Education, Inc.

Introductory Algebra 13th edition Bittinger Solutions Manual

65.
$$\begin{aligned} 4|x| - 13 &= 3 \\ 4|x| &= 16 \\ |x| &= 4 \end{aligned}$$

The solutions are the numbers whose distance from 0 is 4.
They are -4 and 4.

66. First we multiply by 28 to clear the fractions.

$$\begin{aligned} \frac{2+5x}{4} &= \frac{11}{28} + \frac{8x+3}{7} \\ 28\left(\frac{2+5x}{4}\right) &= 28\left(\frac{11}{28} + \frac{8x+3}{7}\right) \\ \frac{28(2+5x)}{4} &= 28 \cdot \frac{11}{28} + \frac{28(8x+3)}{7} \\ 7(2+5x) &= 11 + 4(8x+3) \\ 14 + 35x &= 11 + 32x + 12 \\ 14 + 35x &= 32x + 23 \\ 14 + 3x &= 23 \\ 3x &= 9 \\ x &= 3 \end{aligned}$$

The solution is 3.

67.
$$\begin{aligned} p &= \frac{2}{m+Q} \\ (m+Q) \cdot p &= (m+Q) \cdot \frac{2}{m+Q} \\ mp + Qp &= 2 \\ Qp &= 2 - mp \\ Q &= \frac{2-mp}{p} \end{aligned}$$

Copyright © 2019 Pearson Education, Inc.

Introductory Algebra 13th edition Bittinger Solutions Manual

Introductory Algebra 13th edition Bittinger Solutions Manual

Name Section Date

Activity 2.1 Pair It Up!

Focus	Solving Equations: The Addition Principle
Time	15–20 minutes
Group size	2–4
Material	Card stock rectangles
Background	This activity will give you practice with solving equations using the Addition Principle. You will need to solve these equations mentally as quickly as you can.

1. Put equations on one side of 10 cards with answers to these equations on 10 other cards.
2. Number the cards randomly 1-20.
3. Mix the cards and put them down on the table number-side up.
4. Each team member chooses 2 cards one at a time. Return cards if the equation and its answer are not chosen (similar to the game Concentration).
5. Pair the equation with its answer.
6. Play continues until all pairs are chosen.
7. The winner has the most pairs.

Conclusion	Exercise Set 2.1 in your textbook includes a variety of equations. Solve these equations using the addition principle.

Copyright © 2019 Pearson Education, Inc.

Introductory Algebra 13th edition Bittinger Solutions Manual

$x+2=11$	$x+5=-8$	$t-3=19$	$x+\frac{1}{2}=-\frac{3}{2}$	$x-7=-21$
$-8+y=17$	$8+y=12$	$x+\frac{1}{2}=7$	$m+18=-13$	$-7+y=13$

9	-13	22	-2	-14
25	4	$6\frac{1}{2}$	-31	20

Copyright © 2019 Pearson Education, Inc.

Introductory Algebra 13th edition Bittinger Solutions Manual

Name Section Date

Activity 2.2 Spin It Fast!

Focus	Solving Equations: The Multiplication Principle
Time	15–30 minutes
Group size	2–4
Materials	Spinner with numbers 1–10, card stock rectangles with equations on one side and numbers 1–10 on the other side.
Background	This activity will give you practice with solving equations using the multiplication principle. You will need to solve these equations mentally as quickly as you can.

1. Make a spinner with 10 numbers and 10 card stock rectangles with equations on one side and numbered 1–10 on the other side. Put the rectangles face-down on the table.

2. Spin and solve the equation with the same number as the number spun. Mark an X over the number on the spinner, so it is "out of commission." If you stop on an "out of commission" number, you lose your turn. The spins rotate through all the players, and the instructor chooses the player who starts first.

3. Each player writes down the number of equations s/he has solved correctly.

4. The player who solves the most equations correctly wins the round.

Conclusion	Exercise Set 2.2 in your textbook includes a variety of equations that can be solved using the multiplication principle.

Copyright © 2019 Pearson Education, Inc.

Introductory Algebra 13th edition Bittinger Solutions Manual

Front

1	2	3	4	5
6	7	8	9	10

Back

$6x = 90$	$-6x = 108$	$63 = 9x$	$-15x = 105$	$\frac{3}{4}x = 27$
$\frac{-t}{3} = 7$	$\frac{1}{8} = \frac{-y}{5}$	$\frac{m}{-3} = 10$	$\frac{4}{5}x = 16$	$-21x = -126$

Copyright © 2019 Pearson Education, Inc.

Introductory Algebra 13th edition Bittinger Solutions Manual

Problems	Answers
1) $6x = 90$	$x = 15$
2) $-6x = 108$	$x = -18$
3) $63 = 9x$	$x = 7$
4) $-15x = 105$	$x = -7$
5) $\frac{3}{4}x = 27$	$x = 36$
6) $\frac{-t}{3} = 7$	$t = -21$
7) $\frac{1}{8} = \frac{-y}{5}$	$-\frac{5}{8} = y$
8) $\frac{m}{-3} = 10$	$m = -30$
9) $\frac{4}{5}x = 16$	$x = 20$
10) $-21x = -126$	$x = 6$

Copyright © 2019 Pearson Education, Inc.

Introductory Algebra 13th edition Bittinger Solutions Manual

Name Section Date

Activity 2.3 Solve linear equations as a group.

Focus	Solving linear equations
Time	10–20 minutes
Group size	3
Background	This activity will give you practice with solving equations as a group. There is usually more than one correct sequence of steps for solving an equation. Thus, it is important to be able to follow someone else's steps even if his or her approach is not like yours.

1. Each group member should select a different one of the following equations.

$$2\left[4-2(3-x)\right]-1=4\left[2(4x-3)+7\right]-25$$

$$\frac{5}{3}+\frac{2}{3}x=\frac{25}{12}+\frac{5}{4}x+\frac{3}{4}$$

$$0.8-4(x-1)=0.2+3(4-x)$$

Write the equation on a blank sheet of paper, and perform a first step of the solution.

2. When you are done, pass your paper to the group member on your left. Look at the paper you receive and check the work shown. If you spot an error, discuss it with the group member who did the step. He or she should then correct the error.

3. Perform a second step of the solution for the equation you received. Then pass the paper to the group member on your left.

4. Check the work on the problem you receive. Discuss and correct any errors as before, then do the next step. Continue passing the problems until all equations have been solved.

5. As a group, look at the solutions to all three equations. When you are satisfied with the answers, compare them with the other groups in the class.

Conclusion	Solving equations as a group gives you a better understanding of the solution process. You can also use this technique to solve linear inequalities (see Activity 2.7) or to simplify algebraic expressions in other chapters.

Copyright © 2019 Pearson Education, Inc.

Introductory Algebra 13th edition Bittinger Solutions Manual

Name Section Date

Activity 2.5 Calculate the sale price and original price of discounted items.

Focus	Applications with percents
Time	10–15 minutes
Group size	4
Background	Often a store will reduce the price of an item by a fixed percentage and then return to the original price once the sale is over. This activity will give you practice in calculating the sale price of several items, and help you develop a formula for restoring the original price.

1. Think of an item you would like to purchase, like a jacket or portable stereo, and set a reasonable price for the item. Write the information in the table on the next page, and pass the paper to the group member on your left.

2. Now, suppose the purchased item is on sale. Choose a reasonable discount percent for the item, and write this information in the table. Pass the paper to the group member on your left again.

3. Calculate the discount amount and the sale price of the item you receive. Write your answers in the table, and pass the paper to the group member on your left.

4. Find a multiplier that can be used to convert the discounted price back to the original price. Write this result in the table, and pass the paper again to your left.

5. Check the calculations for the item you receive; if you spot an error, discuss it with the group member who did the step. He or she should then correct the error.

6. When all calculations are correct, examine the tables together as a group, and compare the multipliers for each item. Do the multipliers depend on the price of the item? By what percentage is the discounted price increased when returning to the original price? Use complete sentences in your answer.

Copyright © 2019 Pearson Education, Inc.

Introductory Algebra 13th edition Bittinger Solutions Manual

7. Develop a formula that can be used to find a multiplier that will restore an r% discounted price to its original price. Check that this formula will duplicate the results for each item.

Item name	
Original price	
Discount percent	
Discount amount	
Sale price	
Multiplier	

Conclusion	Exercise Set 2.5 in your textbook includes a variety of percent problems. Do some of these problems in order to become familiar with the various uses of percent.

Copyright © 2019 Pearson Education, Inc.

Introductory Algebra 13th edition Bittinger Solutions Manual

Name Section Date

Activity 2.7 Solve linear inequalities as a group.

Focus	Solving linear inequalities
Time	10–20 minutes
Group size	3
Background	This activity will give you practice with solving inequalities as a group. There is usually more than one correct sequence of steps for solving an inequality. Thus, it is important to be able to follow someone else's steps even if his or her approach is not like yours.

1. Each group member should select a different one from the following inequalities.

   $$6[4-2(6+3x)]>5[3(7-x)-4(8+2x)]-20$$

   $$1.7x+8-1.62x<0.4x-0.32+8$$

   $$\frac{7}{12}-\frac{8}{3}x-\frac{5}{8}<\frac{3}{8}$$

   Write the inequality on a blank sheet of paper, and perform a first step of the solution.

2. When you are done, pass your paper to the group member on your left. Look at the paper you receive and check the work shown. If you spot an error, discuss it with the group member who did the step. He or she should then correct the error.

3. Perform a second step of the solution for the inequality you received. Then pass the paper to the group member on your left.

4. Check the work on the problem you receive. Discuss and correct any errors as before, then do the next step. Continue passing the problems until all inequalities have been solved.

5. As a group, look at the solutions to all three inequalities. When you are satisfied with the answers, compare them with the other groups in the class.

Conclusion	Solving inequalities as a group gives you a better understanding of the solution process. You can also use this technique to solve equations (see Activity 2.3) or to simplify expressions in other chapters.

Copyright © 2019 Pearson Education, Inc.

Introductory Algebra 13th edition Bittinger Solutions Manual

Solving Equations: The Addition Principle

Learning Objectives:

a Determine whether a given number is a solution of a given equation.
b Solve equations using the addition principle.

Examples:

1. Determine whether the given number is a solution of the given equation.
   a) Is 0 a solution of $6-3x=6-5x$?
   b) Is 5 a solution of $x+4=10$?
   c) Is 9 a solution of $12=3+x$?
   d) Is 10 a solution of $8(y-3)=54$?

2. Solve using the addition principle.
   a) $x-4=16$ b) $14=x-12$ c) $x+15=18$
   d) $-19=x+16$ e) $21=-16+x$ f) $x-(-6)=18$
   g) $15=x-5$ h) $13+x=13$ i) $-26+x=-32$

3. Solve using the addition principle.
   a) $\frac{1}{4}+x=\frac{3}{4}$ b) $\frac{1}{3}+x=\frac{5}{6}$ c) $x-\frac{1}{5}=0$
   d) $x-\frac{9}{10}=-\frac{3}{5}$ e) $-2.2+x=16$ f) $14\frac{3}{4}=-28+x$

Teaching Notes:

- Encourage students to write all of the addition principle steps and to avoid using shortcuts until they have mastered these types of equations.
- Encourage students to write the steps for solving the equations in a neat and organized manner. This habit will help immensely when the equations become more complex.
- Refer students to the addition principle for equations in the text.

Answers: *1a) Yes, b) no, c) yes, d) no; 2a) 20, b) 26, c) 3, d)* -35*, e) 37, f) 12, g) 20, h) 0, i)* -6*; 3a)* $\frac{1}{2}$*, b)* $\frac{1}{2}$*, c)* $\frac{1}{5}$*, d)* $\frac{3}{10}$*, e) 18.2, f)* $42\frac{3}{4}$

 Copyright © 2019 Pearson Education, Inc.

Introductory Algebra 13th edition Bittinger Solutions Manual

Solving Equations: The Multiplication Principle

Learning Objective:

a Solve equations using the multiplication principle.

Examples:

1. By what number is it necessary to multiply each side of each equation in order to obtain x on the left side? Do not solve.

   a) $\frac{1}{5}x = 3$ b) $\frac{x}{6} = -2$ c) $-\frac{3}{4}x = 21$ d) $-x = 41$

2. Tell whether you would use the addition principle or multiplication principle to solve each equation. Do not solve.

   a) $x + 3 = -15$ b) $5x = -25$

3. Solve using the multiplication principle. Be sure to simplify your answers. Check your answers.

   a) $\frac{1}{5}x = 6$ b) $\frac{1}{4}x = -25$ c) $\frac{x}{12} = 5$ d) $-9 = \frac{x}{9}$

4. Solve using the multiplication principle. Be sure to simplify your answers. Check your answers.

   a) $3x = 9$ b) $7x = -56$ c) $-11 = 2x$ d) $1.2x = 88$

   e) $-16 = -x$ f) $-x = 100$ g) $-3.3x = -111$ h) $53 = -8x$

5. Solve using the multiplication principle. Check your answers.

   a) $\frac{1}{6}x = -9$ b) $-43 = 4x$ c) $-9.8x = -210.994$

   d) $-99 = -x$ e) $-8 = \frac{x}{8}$ f) $\frac{x}{15} = 225$

Teaching Notes:

- Some students need to be shown that $\frac{1}{12}x = \frac{1}{12} \cdot \frac{x}{1} = \frac{1 \cdot x}{12 \cdot 1} = \frac{x}{12}$.
- Refer to the multiplication principle for equations in the text.

Answers: 1a) 5, b) 6, c) $-\frac{4}{3}$, d) -1; 2a) Addition principle, b) multiplication principle; 3a) 30, b) -100, c) 60, d) -81; 4a) 3, b) -8, c) $-\frac{11}{2}$, or $-5\frac{1}{2}$, d) $73.\overline{3}$, or $\frac{220}{3}$, e) 16, f) -100, g) $33.\overline{63}$, or $\frac{370}{11}$, h) -6.625, or $-\frac{53}{8}$; 5a) -54, b) -10.75, or $-\frac{43}{4}$, c) 21.53, d) 99, e) -64, f) 3375

Copyright © 2019 Pearson Education, Inc.

Introductory Algebra 13th edition Bittinger Solutions Manual

Using the Principles Together

Learning Objectives:

a Solve equations using both the addition principle and the multiplication principle.
b Solve equations in which like terms may need to be collected.
c Solve equations by first removing parentheses and collecting like terms; solve equations with an infinite number of solutions and equations with no solutions.

Examples:

1. Determine whether the given number is a solution of the equation.
   a) Is 12 a solution for $5x+4-2x=3x-5+x$?
   b) Is 9 a solution for $5x+4-2x=3x-5+x$?

2. Solve for x. Check your solution.
   a) $10x+7=107$ b) $7x-8=27$ c) $33=6x-3$
   d) $164=15x+14$ e) $\frac{1}{2}x-8=-2$ f) $-\frac{2}{3}x-8=-32$

3. Solve the equation. Check your solution.
   a) $4x=-2x+60$ b) $8x-6=3+9x$ c) $-\frac{3}{4}x-\frac{5}{2}=-\frac{5}{8}+2x$
   d) $0.6y-0.3=0.7-0.3y$ e) $x-12=10-x$ f) $-9x+4+7x=-3x+9$

4. Solve the equation. Check your solution.
   a) $6(2x-1)=30$ b) $-1(x+11)=20$ c) $6(x-8)=6x-48$
   d) $3x+6(x+9)=9x-15$ e) $0.4x-0.2(3-x)=7.6$ f) $7x-3(x-8)=3x+24$

Teaching Notes:

- Encourage students to check their solutions, as in Example 1.
- In Example 3, some students prefer to work to always have the variable on the left, while others prefer to work to always have a positive coefficient of the variable.
- Some students confuse the principles and try to subtract the coefficient from the variable instead of multiplying to obtain a coefficient of 1.
- Some students neglect to collect like terms before trying to solve as in Example 3f.

Answers: 1a) no, b) yes; 2a) 10, b) 5, c) 6, d) 10, e) 12, f) 36; 3a) 10, b) -9, c) $-\frac{15}{22}$, d) $\frac{10}{9}$, or $1\frac{1}{9}$, e) 11, f) 5; 4a) 3, b) -31, c) all real numbers, d) no solution, e) $\frac{41}{3}$, or $13\frac{2}{3}$, f) 0

Copyright © 2019 Pearson Education, Inc.

Introductory Algebra 13th edition Bittinger Solutions Manual

Formulas

Learning Objectives:

a Evaluate a formula.
b Solve a formula for a specified letter.

Examples:

1. Substitute values into the given formula and solve.
   a) The formula for the perimeter of a rectangle is $P = 2L + 2W$. If the length, L, is 9 m and the width, W, is 5 m, find the perimeter, P, of the rectangle.

   b) The area of a triangle is given by $A = \frac{1}{2}bh$. If the base, b, is 19 in. and the height, h, is 17 in., find the area, A, of the triangle.

2. Solve for the indicated letter.

   a) $d = rt$, for r b) $V = \frac{1}{3}Bh$, for h c) $P = 2L + 2W$, for W

   d) $F = \frac{9}{5}C + 32$, for C e) $y = 3x + 6$, for x f) $S = 2\pi rh + 2\pi r^2$, for h

Teaching Notes:

- Many students have difficulty with the problems in Example 2.
- Sometimes it is required that students solve a number of problems using the same formula. It may be advantageous for students to rewrite the formula so that it is solved for the required letter first.
- Encourage students to label answers with the correct units.

Answers: *1a)* $P = 28\ m$, *b)* $A = 161.5\ in^2$; *2a)* $r = \frac{d}{t}$, *b)* $h = \frac{3V}{B}$, *c)* $W = \frac{P - 2L}{2}$, *d)* $C = \frac{5}{9}(F - 32)$, *e)* $x = \frac{y - 6}{3}$, *f)* $h = \frac{S - 2\pi r^2}{2\pi r}$

Copyright © 2019 Pearson Education, Inc.

Introductory Algebra 13th edition Bittinger Solutions Manual

Applications of Percent

Learning Objective:

a Solve applied problems involving percent.

Examples:

1. Solve.
   a) 7 is 10% of what number?
   b) What is 32% of 224?
   c) Find 190% of 375.
   d) 25 is what percent of 125?
   e) What percent of 80 is 0.8?
   f) 126 is 450% of what number?

2. Solve.
   a) The Smith family paid 22% of the purchase price of a $231,000 home as a down payment. Determine the amount of the down payment.
   b) A waiter received a tip of $7.65 on a meal which cost $42.50. What percent of the cost of the meal was the tip?
   c) Josh controlled 12 cities in a game. This was 75% of all the cities in the game. How many cities were in the game?
   d) The population of Grovestown was 2250 last year. This year it is 2295. What is the percent increase?

Teaching Notes:

- Many students find this section difficult.
- One way to remember which way to move the decimal point when converting between decimal and percent notation is to remember that the decimal is moved right for ***D***ecimal to ***P***ercent, and left for ***P***ercent to ***D***ecimal.

Answers: *1a) 70, b) 71.68, c) 712.5, d) 20%, e) 1%, f) 28; 2a) $50,820, b) 18%, c) 16 cities, d) 2%*

Copyright © 2019 Pearson Education, Inc.

Introductory Algebra 13th edition Bittinger Solutions Manual

Applications and Problem Solving

Learning Objective:

a Solve applied problems by translating to equations.

Examples:

1. Solve.
   a) If 5 is added to a number, and the sum is tripled, the result is 11 more than the number. Find the number.

   b) When six is subtracted from half of a number, the result is -18. What is the original number?

2. In 2014, Pierre's Pizza and Burger Palace together had revenue totaling $470,000. If Burger Palace took in $90,000 less than Pierre's Pizza, how much did each take in as revenue?

3. The perimeter of a triangle is 37 ft. One side of the triangle is 2 ft longer than the second side. The third side is 5 ft longer than the second side. Find the length of each side.

4. Solve.
   a) The sum of two consecutive integers is 59. Find the integers.

   b) When the lesser of two consecutive odd integers is added to twice the greater, the result is 187. Find the integers.

5. A parking lot charges $2.50 for the first hour or part thereof, and $1.25 for each additional hour or part thereof. Determine in terms of an inequality, how many hours, *H*, Gwen was parked if her total fee was $10.

Teaching Notes:

- Many students find these problems difficult at first.
- Refer students to the five-step problem-solving strategy in the text.
- Encourage students to check whether their final answers are reasonable.

Answers: 1a) -2, b) -24; 2) Pierre's Pizza had revenue of $280,000 and Burger Palace had revenue of $190,000; 3) 12 ft, 10 ft, 15 ft; 4a) 29 and 30, b) 61 and 63; 5) $\{H \mid 6 < H \le 7\}$

Copyright © 2019 Pearson Education, Inc.

Introductory Algebra 13th edition Bittinger Solutions Manual

Solving Inequalities

Learning Objectives:

a Determine whether a given number is a solution of an inequality.
b Graph an inequality on the number line.
c Solve inequalities using the addition principle.
d Solve inequalities using the multiplication principle.
e Solve inequalities using the addition principle and the multiplication principle together.

Examples:

1. Determine whether each number is a solution of $x \le -4$.
   a) -2 b) -5 c) 3 d) -4

2. Graph each inequality on the number line.
   a) $x \ge 1$ b) $x > -2$ c) $-1 \le x < 2$

3. Translate each graph to an inequality using the variable x.

a) 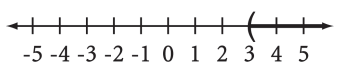

b) 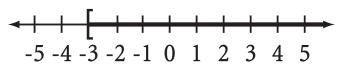

c)

d) 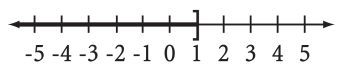

4. Solve each inequality.
   a) $x + 3 < -5$ b) $x - \frac{1}{3} > -\frac{2}{9}$ c) $4x \ge -32$ d) $-6x \le 18$

   e) $4x - 10 > 5x + 4$ f) $5x - 2 \le 6x + 4$ g) $-4x - 7 < 5(2x + 7)$ h) $7(x - 3) > 2(5x - 8)$

Teaching Notes:

- Some students are unfamiliar with <, >, $\le$, and $\ge$ and need to be taught the definitions of each.
- Some students need extra help with Examples 2e.

Answers: 1a) no, b) yes, c) no, d) yes; 2a-e) see graph answer pages; 3a) $\{x \mid x > 3\}$, *b)* $\{x \mid x \ge -3\}$, *c)* $\{x \mid x < -2\}$, *d)* $\{x \mid x \le 1\}$; *4a)* $\{x \mid x < -8\}$, *b)* $\left\{x \,\middle|\, x > \frac{1}{9}\right\}$, *c)* $\{x \mid x \ge -8\}$, *d)* $\{x \mid x \ge -3\}$, *e)* $\{x \mid x < -14\}$, *f)* $\{x \mid x \ge -6\}$, *g)* $\{x \mid x > -3\}$, *h)* $\left\{x \,\middle|\, x < -\frac{5}{3}\right\}$

Copyright © 2019 Pearson Education, Inc.

Introductory Algebra 13th edition Bittinger Solutions Manual

Applications and Problem Solving with Inequalities

Learning Objectives:

a Translate number sentences to inequalities.
b Solve applied problems using inequalities.

Examples:

1. Translate to an inequality.
   a) A number is greater than -3.

   b) The capacity was at least 200.

   c) Six more than a number is less than 21.

   d) The cost is no more than $500.

2. Solve using an inequality.
   a) A certain car has a weight limit for all passengers and cargo of 1129 lb. The four passengers in the car weigh an average of 165 lb. Find the weight of the cargo that the car can handle.

   b) A store has a fax machine available for use by its customers. The store charges $1.85 to send the first page and $0.45 for each subsequent page. Find the number of pages that can be faxed for $7.25.

   c) An archery set containing a bow and three arrows costs $68. Additional arrows can be purchased for $9 each. Jerry has $230 to spend on the set and additional arrows. Including the arrows in the set, how many arrows can Jerry purchase?

Teaching Notes:

- Review the common English-to-inequality translations.
- Some students benefit from seeing solutions on the number line.

Answers: 1a) $n > -3$, b) $c \geq 200$, c) $6 + n < 21$, d) $c \leq 500$; 2a) $\{x \mid x \leq 469 \text{ lb}\}$, b) $\{x \mid x \leq 13 \text{ pages}\}$, c) $\{x \mid x \leq 21 \text{ arrows}\}$

Copyright © 2019 Pearson Education, Inc.

Introductory Algebra 13th edition Bittinger Solutions Manual

CHAPTER 2 **NAME**_____

TEST FORM A **CLASS**_____**SCORE**_____**GRADE**_____

Solve.

1. $x+8=15$
2. $t-8=16$
3. $4x=-24$
4. $-\frac{3}{4}x=-12$
5. $4t+9=5t-6$
6. $\frac{1}{2}x-\frac{1}{6}=\frac{5}{6}$
7. $14-y=5$
8. $-\frac{2}{3}+x=-\frac{5}{8}$
9. $3(x+4)=36$
10. $-3x-3(x+5)=14$
11. $0.2p-1.8=2.3p-4.5-1.8p$
12. $4(x+5)-9=2(2x+3)+1$
13. $8y+6=-11y-2+19y+8$

Solve. Write set notation for the answers.

14. $x+5\le 8$
15. $8x+2>9x-6$
16. $4x\ge 24$
17. $-3y\le 15$
18. $-7y\ge -35$
19. $-4x\ge \frac{3}{8}$
20. $3-7x>17$
21. $3-2x\le 21+4x$

Graph on the number line.

22. $y\le 1$

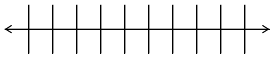

23. $4x-3>x+6$

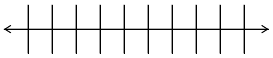

24. $-3\le x\le 0$

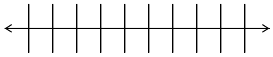

Solve.

25. What number is 12% of 75?
26. 32.2 is what percent of 92?
27. 24 is 2% of what number?

ANSWERS

1. _____
2. _____
3. _____
4. _____
5. _____
6. _____
7. _____
8. _____
9. _____
10. _____
11. _____
12. _____
13. _____
14. _____
15. _____
16. _____
17. _____
18. _____
19. _____
20. _____
21. _____
22. See graph.
23. See graph.
24. See graph.
25. _____
26. _____
27. _____

Copyright © 2019 Pearson Education, Inc.

Introductory Algebra 13th edition Bittinger Solutions Manual

ANSWERS

28. _____
29. _____
30. _____
31. _____
32. _____
33. _____
34. _____
35. _____
36. _____
37. _____
38. _____
39. _____
40. _____

Solve.

28. The population increased from 24,000 to 27,000 over a nine-year period. What was the percent increase?

29. The perimeter of a rectangular flower bed is 56 ft. The length is 4 ft greater than the width. Find the width and the length.

30. Forty-eight percent of the students were girls. There were 12 girls. How many students were there?

31. The sum of the page numbers on the facing pages of a book is 257. What are the page numbers?

32. Money is invested in a savings account with 3% simple interest. After 1 year, there is \$1905.50 in the account. How much was originally invested?

33. A 60-in. pipe is cut into two pieces. One piece is 30 in. more than the other. Find the length of each piece.

34. The width of a rectangle is 48 yd. Find all possible lengths so that the perimeter of the rectangle will be at least 200 yd.

35. Greta budgeted an average of \$70 a month for clothing. For the first three months of the year she spent \$150, \$50, and \$20. How much can she spend in the fourth month without exceeding her average budget?

36. Solve $F = ma$ for a.

37. Solve $y = 5x - n$ for x.

38. The number of tomato plants Jeff planted went from 4 last year to 12 this year. Find the percent increase.

A. 20% B. $66\frac{2}{3}\%$ C. 150% D. 200%

39. Solve $k = \dfrac{5}{x-2}$ for x.

40. Solve: $3|x| + 7 = 16$.

Copyright © 2019 Pearson Education, Inc.

Introductory Algebra 13th edition Bittinger Solutions Manual

CHAPTER 2 **NAME**_____

TEST FORM B **CLASS**_____**SCORE**_____**GRADE**_____

Solve.

1. $x+9=14$
2. $t-5=9$
3. $3x=-12$
4. $-\frac{3}{4}x=-16$
5. $6t+4=5t-7$
6. $\frac{1}{3}x-\frac{3}{8}=\frac{5}{8}$
7. $10-y=16$
8. $-\frac{3}{8}+x=\frac{5}{6}$
9. $4(x+6)=32$
10. $-2x-2(x-9)=12$
11. $2.4p+4.5=3.6p-1.9+0.4p$
12. $5y-3=-4y+2+9y-6$
13. $8(x-3)+7=6x-17+2x$

Solve. Write set notation for the answers.

14. $x+2\geq 11$
15. $8x+2<9x-6$
16. $11x\leq 44$
17. $-8y\geq 24$
18. $-2y\leq -28$
19. $-5x\leq \frac{1}{3}$
20. $3-5x<18$
21. $2-7x\geq 26+5x$

Graph on the number line.

22. $y\leq -2$

23. $4x-3<x+9$

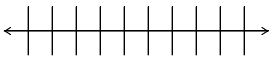

24. $-1<x\leq 2$

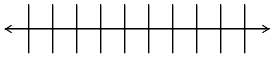

Solve.

25. What number is 5% of 60?
26. 28.6 is what percent of 52?
27. 18 is 4% of what number?

ANSWERS

1. _____
2. _____
3. _____
4. _____
5. _____
6. _____
7. _____
8. _____
9. _____
10. _____
11. _____
12. _____
13. _____
14. _____
15. _____
16. _____
17. _____
18. _____
19. _____
20. _____
21. _____
22. See graph.
23. See graph.
24. See graph.
25. _____
26. _____
27. _____

Copyright © 2019 Pearson Education, Inc.

Introductory Algebra 13th edition Bittinger Solutions Manual

ANSWERS

28. _____
29. _____
30. _____
31. _____
32. _____
33. _____
34. _____
35. _____
36. _____
37. _____
38. _____
39. _____
40. _____

Solve.

28. Enrollment increased from 136 to 150 over two years. What was the percent increase?

29. The perimeter of a rectangular poster is 108 in. The length is 6 in. greater than the width. Find the width and the length.

30. About 20% of the trees were birches. If there were 38 birch trees, how many trees were there altogether?

31. The sum of the numbers on two consecutive post office boxes is 787. What are the numbers?

32. Danielle paid $122.72 for a dress including 4% tax. How much did the dress itself cost?

33. A 42-in. board is cut into two pieces. One piece is 6 in. longer than the other. Find the length of each piece.

34. The width of a rectangle is 12 in. Find all possible lengths such that the perimeter of the rectangle will be at least 50 in.

35. Joe's Electric made 21 customer calls last week and 18 calls this week. How many calls must be made next week in order to maintain an average of at least 24 calls per week for the three-week period?

36. Solve $d = rt$ for t.

37. Solve $A = 3x - D$ for x.

38. The number of inquiries to customer service went from 16 per day to 24 per day after the release of the new product. Find the percent increase.

A. 200% B. 50% C. 20% D. $33\frac{1}{3}\%$

39. Solve $2x + 5 = 3x - yx + 2$ for x.

40. Solve: $42 + 3|x| = 258$.

Copyright © 2019 Pearson Education, Inc.

Introductory Algebra 13th edition Bittinger Solutions Manual

CHAPTER 2 **NAME**_____

TEST FORM C **CLASS**_____**SCORE**_____**GRADE**_____

Solve.

1. $x+4=12$
2. $t-9=21$
3. $8x=-48$
4. $-\frac{2}{3}x=15$
5. $6t+4=7t-8$
6. $\frac{3}{7}x-\frac{1}{8}=\frac{7}{8}$
7. $12-y=17$
8. $-\frac{5}{9}+x=\frac{1}{3}$
9. $6(x+8)=54$
10. $-4x-7(x-2)=8$
11. $0.5p+2.4=1.6p-3.2-0.4p$
12. $-5x+8(x-1)=7+3x+4$
13. $6y-1-9y=4-3y-5$

Solve. Write set notation for the answers.

14. $x+7\le 10$
15. $8x+5>7x-9$
16. $8x\ge -24$
17. $-4y\le 44$
18. $-6y\ge -36$
19. $-2x\ge \frac{1}{5}$
20. $8-6x>32$
21. $6+4x<18+7x$

Graph on the number line.

22. $y<1$

23. $11x+5\ge x-15$

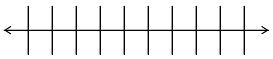

24. $-3\le x\le 2$

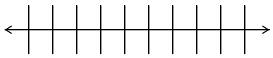

Solve.

25. What number is 15% of 75?
26. 13.3 is what percent of 70?
27. 18 is 6% of what number?

ANSWERS

1. _____
2. _____
3. _____
4. _____
5. _____
6. _____
7. _____
8. _____
9. _____
10. _____
11. _____
12. _____
13. _____
14. _____
15. _____
16. _____
17. _____
18. _____
19. _____
20. _____
21. _____
22. See graph.
23. See graph.
24. See graph.
25. _____
26 _____
27. _____

Copyright © 2019 Pearson Education, Inc.

Introductory Algebra 13th edition Bittinger Solutions Manual

ANSWERS

28. _____
29. _____
30. _____
31. _____
32. _____
33. _____
34. _____
35. _____
36. _____
37. _____
38. _____
39. _____
40. _____

Solve.

28. The number of bacteria present decreased from 25,000 to 17,000 in 3 hr. What was the percent decrease?

29. The perimeter of a rectangular tablecloth is 6 m. The length is 1 m greater than the width. Find the width and the length.

30. Five percent of the participants arrived late. If 12 participants arrived late, how many participants were there?

31. The numbers on Tara's three raffle tickets are consecutive whole numbers. The sum of the numbers is 399. What are the numbers?

32. The Andrews are selling their home. They want to keep \$150,000 after paying a 7% commission to a realtor. For how much must they sell the house (to the nearest dollar)?

33. A 36-in. board is cut into two pieces. One piece is twice the length of the other. Find the length of each piece.

34. The perimeter of a rectangular playing field is not to exceed 280 ft. The width is to be 20 ft less than the length. What widths will allow these conditions to be met?

35. To be considered eligible for benefits, Marlesa must work an average of at least 20 hr per week. In the first three weeks of one month, she worked 16 hr, 22 hr, and 18 hr. How many hours must she work the next week to have an average of at least 20 hr per week for those 4 weeks?

36. Solve $C = 2\pi r$ for r.

37. Solve $y = 4x + d$ for x.

38. Cassie's weight went from 120 lb to 125 lb. Find the percent increase.

A. 4.2% B. 4% C. 5% D. 4.5%

39. Solve $5x - 6 = 3x + xy$ for x.

40. Solve $t = \dfrac{4s}{p - q}$ for q.

Copyright © 2019 Pearson Education, Inc.

Introductory Algebra 13th edition Bittinger Solutions Manual

CHAPTER 2 **NAME**_____

TEST FORM D **CLASS**_____**SCORE**_____**GRADE**_____

Solve.

1. $x+7=11$
2. $t-8=22$
3. $6x=-30$
4. $-\frac{2}{5}x=-50$
5. $4t+7=3t-1$
6. $\frac{1}{3}x-\frac{3}{8}=\frac{5}{8}$
7. $6-y=14$
8. $-\frac{2}{3}+x=\frac{5}{8}$
9. $4(x+2)=36$
10. $-4x-5(x-3)=8$
11. $0.2p+1.4=3.5p+6.2-0.8p$
12. $9+8x=4(3+2x)-3$
13. $5x-6-x=4(2+x)-12$

Solve. Write set notation for the answers.

14. $x+9\geq 13$
15. $7x+5<8x-2$
16. $6x\leq 42$
17. $-8y\geq 72$
18. $-3y\leq -24$
19. $-3x\leq \frac{1}{9}$
20. $8-3x\leq 29$
21. $3-5x\geq -6+2x$

Graph on the number line.

22. $y\geq 1$

23. $3x-2<x+6$

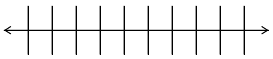

24. $-2\leq x\leq 3$

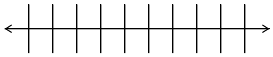

Solve.

25. What number is 24% of 400?
26. 16.2 is what percent of 80?
27. 13 is 8% of what number?

ANSWERS

1. _____
2. _____
3. _____
4. _____
5. _____
6. _____
7. _____
8. _____
9. _____
10. _____
11. _____
12. _____
13. _____
14. _____
15. _____
16. _____
17. _____
18. _____
19. _____
20. _____
21. _____
22. See graph.
23. See graph.
24. See graph.
25. _____
26. _____
27. _____

Copyright © 2019 Pearson Education, Inc.

Introductory Algebra 13th edition Bittinger Solutions Manual

ANSWERS

28. _____
29. _____
30. _____
31. _____
32. _____
33. _____
34. _____
35. _____
36. _____
37. _____
38. _____
39. _____
40. _____

Solve.

28. The number of complaints fell from 40 per month to 24 per month one month after all employees completed the training seminar. What was the percent decrease?

29. The perimeter of a rectangular frame is 48 in. The length is 4 in. greater than the width. Find the width and the length.

30. Twelve percent of the workforce attended the meeting. If 6 workers attended the meeting, how many workers are there altogether?

31. The sum of two consecutive even integers is 770. What are the integers?

32. The price of a wool coat was decreased to a sale price of $124.10. This was a 15% reduction. What was the former price?

33. The second angle of a triangle is three times as large as the first angle. The third angle is half as large as the first angle. How large are the angles?

34. One side of a triangle is 2 cm longer than the base. The other side is 3 cm shorter than the base. What lengths of the base will allow the perimeter to be less than 30 cm?

35. A 15-lb puppy is gaining weight at a rate of 1.5 lb per wk. When will the puppy's weight exceed 40 lb?

36. Solve $A = bh$ for h.

37. Solve $A = \dfrac{2T + Q + H}{4}$ for H.

38. The number of students in Josh's class went from 15 last year to 18 this year. Find the percent increase.

A. 30% B. $16\frac{2}{3}\%$ C. 20% D. 5%

39. Solve: $-8|x| + 5 = -11$.

40. Solve: $3 = \dfrac{x}{y - z}$ for z.

Copyright © 2019 Pearson Education, Inc.

Introductory Algebra 13th edition Bittinger Solutions Manual

CHAPTER 2 **NAME**_____

TEST FORM E **CLASS**_____**SCORE**_____**GRADE**_____

1. Determine whether 9 is a solution of $3x-8=19$.

Solve.

2. $t-6=15$

3. $3x=-24$

4. $-\frac{5}{8}x=40$

5. $5t-6=4t+2$

6. $\frac{2}{3}x-\frac{5}{8}=\frac{3}{8}$

7. $9-y=8$

8. $-\frac{3}{5}+x=\frac{2}{3}$

9. $4(x+2)=28$

10. $-5x-3(x-2)=6$

11. $6x-5=2(3x-2)-1$

12. $1.3p-6.2=5.9p+4.6+0.8p$

Solve. Write set notation for the answers.

13. $x+8\geq 5$

14. $2x+4<3x-7$

15. $12x\leq 24$

16. $-3y\geq 27$

17. $-5y\leq -\frac{1}{2}$

18. $4-2x<8$

19. $6-5x\geq 3x-32$

Graph on the number line.

20. $y\geq 1$

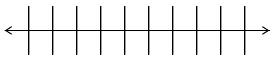

21. $3x-6<x+2$

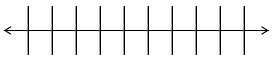

ANSWERS

1. _____
2. _____
3. _____
4. _____
5. _____
6. _____
7. _____
8. _____
9. _____
10. _____
11. _____
12. _____
13. _____
14. _____
15. _____
16. _____
17. _____
18. _____
19. _____
20. See graph.
21. See graph.

Copyright © 2019 Pearson Education, Inc.

Introductory Algebra 13th edition Bittinger Solutions Manual

ANSWERS

22. _____

23. _____

24. _____

25. _____

26. _____

27. _____

28. _____

29. _____

30. _____

Solve.

22. If you double a number and then add 8, you get half of the original number. What is the original number?

23. A teacher's salary is \$29,355. This is a 3% increase over the previous year's salary. What was the previous salary?

24. What percent of 112 is 22.4?

25. A 100-m rope is cut into two pieces. One piece is 16 m greater than the other. Find the length of each piece.

26. Solve $A = \pi r^2$ for r^2.

27. Translate to an inequality: A number is at least 5.

28. The perimeter of a rectangular field cannot exceed 400 ft. The length is to be 20 ft more than the width. What widths will allow these conditions to be met?

_____

29. Solve: $8|x| - 5 = 43$.

30. Solve $S = 2\pi r^2 + 2\pi rh$ for π.

Copyright © 2019 Pearson Education, Inc.

Introductory Algebra 13th edition Bittinger Solutions Manual

CHAPTER 2 **NAME**_____

TEST FORM F **CLASS**_____**SCORE**_____**GRADE**_____

Solve.

1. $x+5=12$
2. $t-7=12$
3. $-\frac{2}{3}x=36$
4. $6t+5=7t-3$
5. $\frac{1}{2}x-\frac{2}{7}=\frac{5}{7}$
6. $3-y=11$
7. $-\frac{5}{9}+x=\frac{3}{4}$
8. $6(x+2)=42$
9. $-5x-4(x-6)=12$
10. $5x-6=2(3x-1)-x$
11. $1.2p-3.6=0.6p-6.4-2.6p$

Solve. Write set notation for the answers.

12. $x+3\le 9$
13. $4x+3>5x-8$
14. $8x\ge 48$
15. $-2y\le 16$
16. $-4x\ge\frac{1}{8}$
17. $3-5x>4$
18. $5-7x\le 18+6x$

Graph on the number line.

19. $y\ge -3$

20. $-1\le x<2$

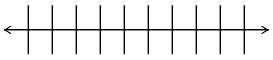

ANSWERS

1. _____
2. _____
3. _____
4. _____
5. _____
6. _____
7. _____
8. _____
9. _____
10. _____
11. _____
12. _____
13. _____
14. _____
15. _____
16. _____
17. _____
18. _____
19. See graph.
20. See graph.

Copyright © 2019 Pearson Education, Inc.

Introductory Algebra 13th edition Bittinger Solutions Manual

CHAPTER 2 **NAME**_____

TEST FORM F

ANSWERS

21. _____

22. _____

23. _____

24. _____

25. _____

26. _____

27. a) _____
b) _____
c) _____

28. _____

29. _____

30. _____

Solve.

21. The perimeter of a rectangular picture is 120 in. The length is 12 in. greater than the width. Find the width and the length.

22. The second angle of a triangle is 20° less than the first angle. The third angle is twice the first angle. How large are the angles?

23. What number is 18% of 220?

24. Money is invested in a savings account at 2% simple interest. After 1 year, there is \$1606.50 in the account. How much was originally invested?

25. Evaluate $N = n^2 - n$ for $n = 6$ to find the number of games a league of 6 teams will play if each team plays each other team twice.

26. Solve $A = \dfrac{2T + Q + H}{4}$ for T.

27. Determine whether each of the following is a solution of $x \le 6$.
a) -3 b) 10 c) 6

28. Your test grades are 90, 92, 80, and 83. Determine (in terms of an inequality) what scores you can get on the next test and still have an average test score of at least 88.

_____

29. Solve: $4|x| + 5 = 3$.

30. Solve: $\dfrac{2}{3}\left(8x - \dfrac{5}{6}\right) - \dfrac{1}{8} = \dfrac{7}{8}$.

Copyright © 2019 Pearson Education, Inc.

Introductory Algebra 13th edition Bittinger Solutions Manual

CHAPTER 2 **NAME**_____

TEST FORM G **CLASS**_____**SCORE**_____**GRADE**_____

1. Solve: $x-7=8$.
   a) 1 b) -1 c) 15 d) -15
2. Solve: $9x=-72$.
   a) 8 b) -8 c) -81 d) -648
3. Solve: $2t+8=3t-11$.
   a) 19 b) $-\frac{19}{5}$ c) 3 d) -19
4. Solve: $-\frac{3}{8}x=24$.
   a) 64 b) -9 c) 9 d) -64
5. Solve: $5-y=12$.
   a) -7 b) 7 c) -17 d) $-\frac{12}{5}$
6. Solve: $8(x+3)=40$.
   a) 8 b) 2 c) 29 d) 317
7. Solve: $4x+3>5x-9$.
   a) $\{x|x<12\}$ b) $\{x|x<6\}$
   c) $\{x|x>12\}$ d) $\{x|x>6\}$
8. Solve: $3-2x<15$.
   a) $\{x|x>6\}$ b) $\{x|x>-6\}$
   c) $\{x|x<-6\}$ d) $\{x|x<6\}$
9. Solve: $3x+4(3+2x)=11x-12$.
   a) All real numbers b) 4
   c) $\frac{19}{6}$ d) No solution
10. 35 is what percent of 560?
    a) 62.5% b) 16% c) 6.25% c) 8.5%
11. Solve: $p=ax+by+c$ for b.
    a) $b=\frac{ax+c-p}{y}$ b) $b=y(p-ax-c)$
    c) $b=\frac{p}{b}-ax-c$ d) $b=\frac{p-ax-c}{y}$

ANSWERS

1. _____
2. _____
3. _____
4. _____
5. _____
6. _____
7. _____
8. _____
9. _____
10. _____
11. _____

Copyright © 2019 Pearson Education, Inc.

Introductory Algebra 13th edition Bittinger Solutions Manual

ANSWERS

12. _____

13. _____

14. _____

15. _____

16. _____

17. _____

18. _____

19. _____

20. _____

12. Which of the following numbers is included in the graph of $3x+8>-2x-16$?
a) -5 b) -6 c) -4 d) -20

13. The perimeter of a rectangular poster is 108 in. The length is 12 in. greater than the width. Find the length.
a) 21 in. b) 42 in. c) 33 in. d) 48 in.

14. If you double a number and then add 8, you get fourteen more than the original number. What is the original number?
a) 11 b) 3 c) 12 d) 6

15. A 12-m board is cut into two pieces. One piece is twice the length of the other. Find the length of the longer piece.
a) 4 m b) 8 m c) 9 m d) 3 m

16. Brenna left a 17% tip on her restaurant tab. If she left a \$4.80 tip, how much was the original tab?
a) \$0.82 b) \$33.04 c) \$32.00 d) \$28.24

17. The height of a triangle is 90 cm. What lengths of the base will make the area at most 500 cm^2?
a) $\{b \mid b \le 11.\overline{1}\text{ cm}\}$ b) $\{b \mid b < 11.\overline{1}\text{ cm}\}$
c) $\{b \mid b \ge 5.\overline{5}\text{ cm}\}$ d) $\{b \mid b \ge 11.\overline{1}\text{ cm}\}$

18. The population increased from 1200 to 1464. What was the percent increase?
a) 18% b) 26% c) 22% d) 5%

---

19. Solve: $5-|x|=-14$.
a) $-9, 9$ b) $-70, 70$ c) $-\frac{14}{5}, \frac{14}{5}$ d) $-19, 19$

20. Solve: $\frac{2}{3}\left(9x-\frac{3}{8}\right)-\frac{1}{3}=\frac{2}{3}$.
a) $\frac{11}{72}$ b) $\frac{5}{24}$ c) $\frac{25}{216}$ d) $\frac{1}{8}$

Copyright © 2019 Pearson Education, Inc.

Introductory Algebra 13th edition Bittinger Solutions Manual

CHAPTER 2 **NAME**_____

TEST FORM H **CLASS**_____**SCORE**_____**GRADE**_____

1. Solve: $x+8=14$.
   a) 22 b) 6 c) 8 d) -6
2. Solve: $0.2p+2.4=1.6p-1.2+0.6p$.
   a) 1.5 b) 0.6 c) 1.8 d) $0.\overline{5}$
3. Solve: $3-y=11$.
   a) -8 b) 14 c) -14 d) 8
4. Solve: $-\frac{2}{3}+x=-\frac{6}{7}$.
   a) $-\frac{32}{21}$ b) $-\frac{9}{7}$ c) $-\frac{2}{5}$ d) $-\frac{4}{21}$
5. Solve: $-\frac{5}{3}x=15$.
   a) -9 b) -25 c) $16\frac{2}{3}$ d) 9
6. Solve: $-6x-2(x-5)=4$.
   a) $-\frac{11}{7}$ b) $-\frac{9}{8}$ c) $\frac{3}{4}$ d) $-\frac{7}{4}$
7. Solve: $4x-3=9x+6-5x-9$.
   a) No solution b) $\frac{9}{8}$
   c) 1 d) All real numbers
8. Solve: $x+4\le 13$.
   a) $\{x|x\le 11\}$ b) $\{x|x\le 9\}$
   c) $\{x|x\ge -9\}$ d) $\left\{x|x\le \frac{13}{4}\right\}$
9. Solve: $-3y\le 15$.
   a) $\{y|y\ge -5\}$ b) $\{y|y\ge -45\}$
   c) $\{y|y\le 18\}$ d) $\{y|y\le -5\}$
10. Solve: $3-7x\ge -24+2x$.
   a) $\{x|x\le 3\}$ b) $\{x|x\ge 3\}$
   c) $\{x|x\ge -3\}$ d) $\{x|x\le -3\}$

ANSWERS

1. _____
2. _____
3. _____
4. _____
5. _____
6. _____
7. _____
8. _____
9. _____
10. _____

Copyright © 2019 Pearson Education, Inc.

Introductory Algebra 13th edition Bittinger Solutions Manual

ANSWERS

11. _____
12. _____
13. _____
14. _____
15. _____
16. _____
17. _____
18. _____
19. _____
20. _____

11. 21 is 15% of what number?
a) 3.15 b) 315 c) 24.15 d) 140

12. Solve: $y = mx + b$ for m.
a) $m = y - bx$ b) $m = \frac{y-b}{x}$ c) $m = \frac{y+b}{x}$ d) $m = \frac{y}{x} - b$

13. Which of the following numbers is included in the graph of $-1 < x \le 1$?
a) -1 b) -2 c) 1 d) 2

14. The sum of the page numbers on the facing pages of a book is 553. Find the smaller page number.
a) 277 b) 275 c) 226 d) 276

15. Money is invested in a savings account at 3.4% simple interest. After 1 year, there is \$1695.76 in the account. How much was originally invested?
a) \$1753.42 b) \$1638.10 c) \$576.56 d) \$1640.00

16. The amount of apples Blake harvested went from 500 lb in 2009 to 425 lb in 2010. Find the percent decrease.
a) 18% b) 15% c) 5% d) 25%

17. The second angle of a triangle is twice the first angle. The third angle is five more than four times the first angle. Find the measure of the second angle.
a) 25° b) 105° c) 50° d) 30°

18. Find all numbers such that three times the number is greater than eight less than the number.
a) $\{x|x > -4\}$ b) $\{x|x > -2\}$ c) $\{x|x < -4\}$ d) $\{x|x > 4\}$

19. Solve: $3|x| - 6 = 15$.
a) $-3, 3$ b) $-63, 63$ c) $-27, 27$ d) $-7, 7$

20. Solve: $y = \frac{5}{3-x}$ for x.
a) $x = \frac{3y-5}{y}$ b) $x = -2$ c) $x = 3y - 5$ d) $x = \frac{5}{y} - 3$

Copyright © 2019 Pearson Education, Inc.

Introductory Algebra 13th edition Bittinger Solutions Manual

Chapter 2, Test Form A

1. 7
2. 24
3. -6
4. 16
5. 15
6. 2
7. 9
8. $\frac{1}{24}$
9. 8
10. $-\frac{29}{6}$
11. 9
12. No solution
13. All real numbers
14. $\{x \mid x \le 3\}$
15. $\{x \mid x < 8\}$
16. $\{x \mid x \ge 6\}$
17. $\{y \mid y \ge -5\}$
18. $\{y \mid y \le 5\}$
19. $\left\{x \mid x \le -\frac{3}{32}\right\}$
20. $\{x \mid x < -2\}$
21. $\{x \mid x \ge -3\}$
22. 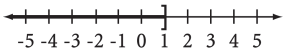

23. 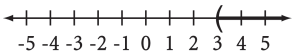

24. 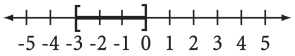

25. 9
26. 35%
27. 1200
28. 12.5%
29. Width: 12 ft
length: 16 ft
30. 25 students
31. 128 and 129
32. \$1850
33. 15 in., 45 in.
34. $\{l \mid l \ge 52 \text{ yd}\}$
35. $\{b \mid b \le \$60\}$
36. $a = \frac{F}{m}$
37. $x = \frac{y+n}{5}$
38. D
39. $x = \frac{5+2k}{k}$
40. $-3, 3$

Chapter 2, Test Form B

1. 5
2. 14
3. -4
4. $\frac{64}{3}$
5. -11
6. 3
7. -6
8. $\frac{29}{24}$
9. 2
10. $\frac{3}{2}$
11. 4
12. No solution
13. All real numbers
14. $\{x \mid x \ge 9\}$
15. $\{x \mid x > 8\}$
16. $\{x \mid x \le 4\}$
17. $\{y \mid y \le -3\}$
18. $\{y \mid y \ge 14\}$
19. $\left\{x \mid x \ge -\frac{1}{15}\right\}$
20. $\{x \mid x > -3\}$
21. $\{x \mid x \le -2\}$
22. 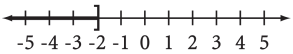

23. 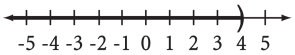

24. 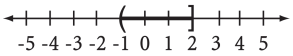

25. 3
26. 55%
27. 450
28. About 10.3%
29. Width: 24 in.
length: 30 in.
30. 190 trees
31. 393 and 394
32. \$118
33. 18 in., 24 in.
34. $\{l \mid l \ge 13 \text{ in.}\}$
35. 33 calls or more
36. $t = \frac{d}{r}$
37. $x = \frac{A+D}{3}$
38. B
39. $x = \frac{3}{1-y}$
40. $-72, 72$

Copyright © 2019 Pearson Education, Inc.

Introductory Algebra 13th edition Bittinger Solutions Manual

Chapter 2, Test Form C

1. 8
2. 30
3. -6
4. $-\frac{45}{2}$
5. 12
6. $\frac{7}{3}$
7. -5
8. $\frac{8}{9}$
9. 1
10. $\frac{6}{11}$
11. 8
12. No solution
13. All real numbers
14. $\{x \mid x \le 3\}$
15. $\{x \mid x > -14\}$
16. $\{x \mid x \ge -3\}$
17. $\{y \mid y \ge -11\}$
18. $\{y \mid y \le 6\}$
19. $\left\{x \mid x \le -\frac{1}{10}\right\}$
20. $\{x \mid x < -4\}$
21. $\{x \mid x > -4\}$
22. 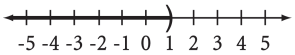

23. 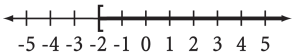

24. 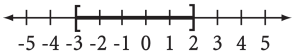

25. 11.25
26. 19%
27. 300
28. 32%
29. Width: 1 m
length: 2 m
30. 240 participants
31. 132, 133, 134
32. \$161,290
33. 12 in., 24 in.
34. $\{w \mid w \le 60 \text{ ft}\}$
35. 24 or more hr
36. $r = \frac{C}{2\pi}$
37. $x = \frac{y-d}{4}$
38. A
39. $x = \frac{6}{2-y}$
40. $q = \frac{pt-4s}{t}$

Copyright © 2019 Pearson Education, Inc.

Introductory Algebra 13th edition Bittinger Solutions Manual

Chapter 2, Test Form D

1. 4
2. 30
3. -5
4. 125
5. -8
6. 3
7. -8
8. $\frac{31}{24}$
9. 7
10. $\frac{7}{9}$
11. -1.92
12. All real numbers
13. No solution
14. $\{x \mid x \geq 4\}$
15. $\{x \mid x > 7\}$
16. $\{x \mid x \leq 7\}$
17. $\{y \mid y \leq -9\}$
18. $\{y \mid y \geq 8\}$
19. $\left\{x \mid x \geq -\frac{1}{27}\right\}$
20. $\{x \mid x \geq -7\}$
21. $\left\{x \mid x \leq \frac{9}{7}\right\}$
22. 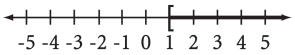

23. 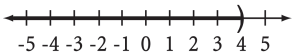

24.

25. 96
26. 20.25%
27. 162.5
28. 40%
29. Width: 10 in.
length: 14 in.
30. 50 workers
31. 384 and 386
32. \$146
33. $40°; 120°; 20°$
34. $\left\{b \mid b < \frac{31}{3} \text{ cm}\right\}$
35. For times more than $16\frac{2}{3}$ wk later than when it's 15 lb
36. $h = \frac{A}{b}$
37. $H = 4A - 2T - Q$
38. C
39. $-2, 2$
40. $z = \frac{3y - x}{3}$

Chapter 2, Test Form E

1. Yes
2. 21
3. -8
4. -64
5. 8
6. $\frac{3}{2}$
7. 1
8. $\frac{19}{15}$
9. 5
10. 0
11. All real numbers
12. -2
13. $\{x \mid x \geq -3\}$
14. $\{x \mid x > 11\}$
15. $\{x \mid x \leq 2\}$
16. $\{y \mid y \leq -9\}$
17. $\left\{y \mid y \geq \frac{1}{10}\right\}$
18. $\{x \mid x > -2\}$
19. $\left\{x \mid x \leq \frac{19}{4}\right\}$
20. 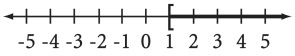

21. 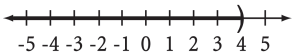

22. $-\frac{16}{3}$
23. \$28,500
24. 20%
25. 42 m; 58 m
26. $r^2 = \frac{A}{\pi}$
27. $n \geq 5$
28. $\{w \mid w \leq 90 \text{ ft}\}$
29. $-6, 6$
30. $\pi = \frac{S}{2r^2 + 2rh}$

Copyright © 2019 Pearson Education, Inc.

Introductory Algebra 13th edition Bittinger Solutions Manual

Chapter 2, Test Form F

1. 7
2. 19
3. -54
4. 8
5. 2
6. -8
7. $\frac{47}{36}$
8. 5
9. $\frac{4}{3}$
10. No solution
11. -0.875
12. $\{x \mid x \le 6\}$
13. $\{x \mid x < 11\}$
14. $\{x \mid x \ge 6\}$
15. $\{y \mid y \ge -8\}$
16. $\left\{x \mid x \le -\frac{1}{32}\right\}$
17. $\left\{x \mid x < -\frac{1}{5}\right\}$
18. $\{x \mid x \ge -1\}$
19. 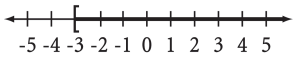

20. 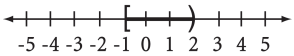

21. Width: 24 in.; length: 36 in.
22. 50°; 30°; 100°
23. 39.6
24. \$1575
25. 30 games
26. $T = \frac{4A - Q - H}{2}$
27. a) yes
b) no
c) yes
28. $\{s \mid s \ge 95\}$
29. No solution
30. $\frac{7}{24}$

Chapter 2, Test Form G

1. c	6. b	11. d	16. d
2. b	7. a	12. c	17. a
3. a	8. b	13. c	18. c
4. d	9. d	14. d	19. d
5. a	10. c	15. b	20. b

Chapter 2, Test Form H

1. b	6. c	11. d	16. b
2. c	7. d	12. b	17. c
3. a	8. b	13. c	18. a
4. d	9. a	14. d	19. d
5. a	10. a	15. d	20. a

Copyright © 2019 Pearson Education, Inc.

Introductory Algebra 13th edition Bittinger Solutions Manual

Chapter 2

Solving Equations and Inequalities

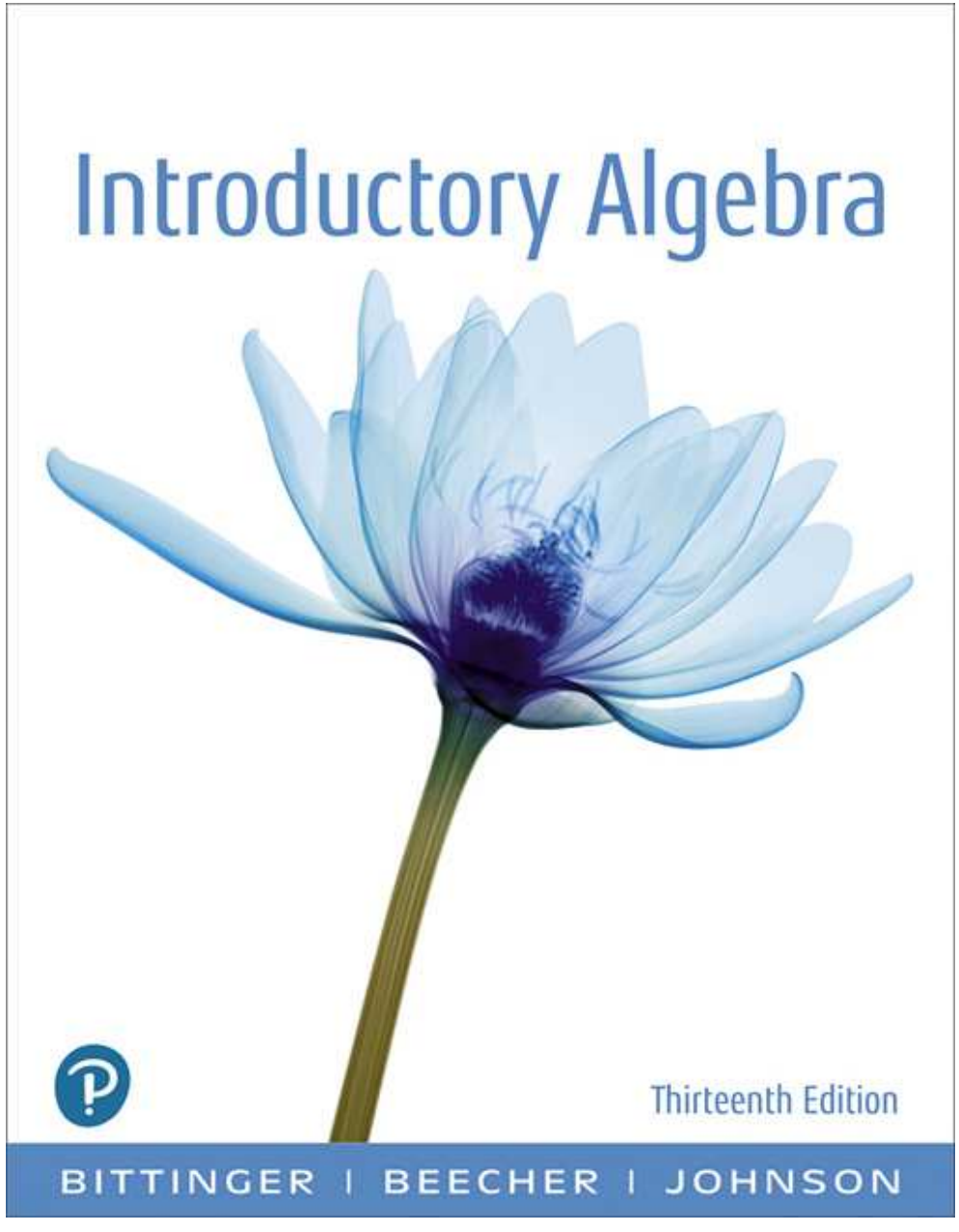

Copyright © 2019, 2015, 2011 Pearson Education, Inc.

Introductory Algebra 13th edition Bittinger Solutions Manual

2.1 SOLVING EQUATIONS: THE ADDITION PRINCIPLE

a. Determine whether a given number is a solution of a given equation.

b. Solve equations using the addition principle.

Copyright © 2019, 2015, 2011 Pearson Education, Inc.

Introductory Algebra 13th edition Bittinger Solutions Manual

Equation

An **equation** is a number sentence that says that the expressions on either side of the equals sign, =, represent the same number.

Copyright © 2019, 2015, 2011 Pearson Education, Inc.

Introductory Algebra 13th edition Bittinger Solutions Manual

Example

Determine whether the equation is true, false, or neither.

a. $4 + 6 = 10$ True

b. $8 - 3 = 4$ False

c. $x + 9 = 21$ Neither, we do not know what number x represents

Copyright © 2019, 2015, 2011 Pearson Education, Inc.

Introductory Algebra 13th edition Bittinger Solutions Manual

Solution of an Equation

Any replacement for the variable that makes an equation true is called a **solution** of the equation. To solve an equation means to find *all* of its solutions.

Copyright © 2019, 2015, 2011 Pearson Education, Inc.

Introductory Algebra 13th edition Bittinger Solutions Manual

Example

Determine whether 8 is a solution of $x + 12 = 21$.

Solution

$x + 12 = 21$	Writing the equation
$8 + 12 \mid 21$	Substituting 8 for x
$20 \neq 21$	False

Since the left side and the right side are not the same, 8 is not a solution of the equation.

Copyright © 2019, 2015, 2011 Pearson Education, Inc.

Introductory Algebra 13th edition Bittinger Solutions Manual

Equivalent Equations

Equations with the same solutions are called **equivalent equations**.

The Addition Principle For Equations

For any real numbers a, b, and c,

$$a = b \text{ is equivalent to } a + c = b + c.$$

Copyright © 2019, 2015, 2011 Pearson Education, Inc.

Introductory Algebra 13th edition Bittinger Solutions Manual

Example

Solve: $x + 6 = -9$.

Solution

$$x + 6 = -9$$

Using the addition principle: adding –6 to both sides or subtracting 6 on both sides

$$x + 6 + (-6) = -9 + (-6)$$

Simplifying

$$x + 0 = -15$$

Identity property of 0

$$x = -15$$

Check

$x + 6 =$	-9
$-15 + 6 =$	-9
-9	True

Copyright © 2019, 2015, 2011 Pearson Education, Inc.

Introductory Algebra 13th edition Bittinger Solutions Manual

Example

Solve: $x + 8 = 15$.

Solution

$$x + 8 = 15$$
$$x + 8 - 8 = 15 - 8$$
$$x + 0 = 7$$
$$x = 7$$

Check

$x + 8 =$	15
$7 + 8$	15
15	True

Copyright © 2019, 2015, 2011 Pearson Education, Inc.

Introductory Algebra 13th edition Bittinger Solutions Manual

Example

Solve: $-8.3 = y - 17.9$

$$-8.3 + 17.9 = y - 17.9 + 17.9$$

$$9.6 = y$$

Check: $\underline{-8.3 = y - 17.9}$

$$-8.3 \mid 9.6 - 17.9$$

$$-8.3 = -8.3 \quad \text{True}$$

The solution is 9.6.

Copyright © 2019, 2015, 2011 Pearson Education, Inc.

Introductory Algebra 13th edition Bittinger Solutions Manual

Example

Solve: $-\frac{1}{5}+x=\frac{7}{10}$

$$-\frac{1}{5}+x=\frac{7}{10}$$

$$\frac{1}{5}-\frac{1}{5}+x=\frac{1}{5}+\frac{7}{10}$$

$$x=\frac{1}{5}\cdot\frac{2}{2}+\frac{7}{10}$$

$$x=\frac{2}{10}+\frac{7}{10}=\frac{9}{10}$$

Copyright © 2019, 2015, 2011 Pearson Education, Inc.

Introductory Algebra 13th edition Bittinger Solutions Manual

Chapter 2

Solving Equations and Inequalities

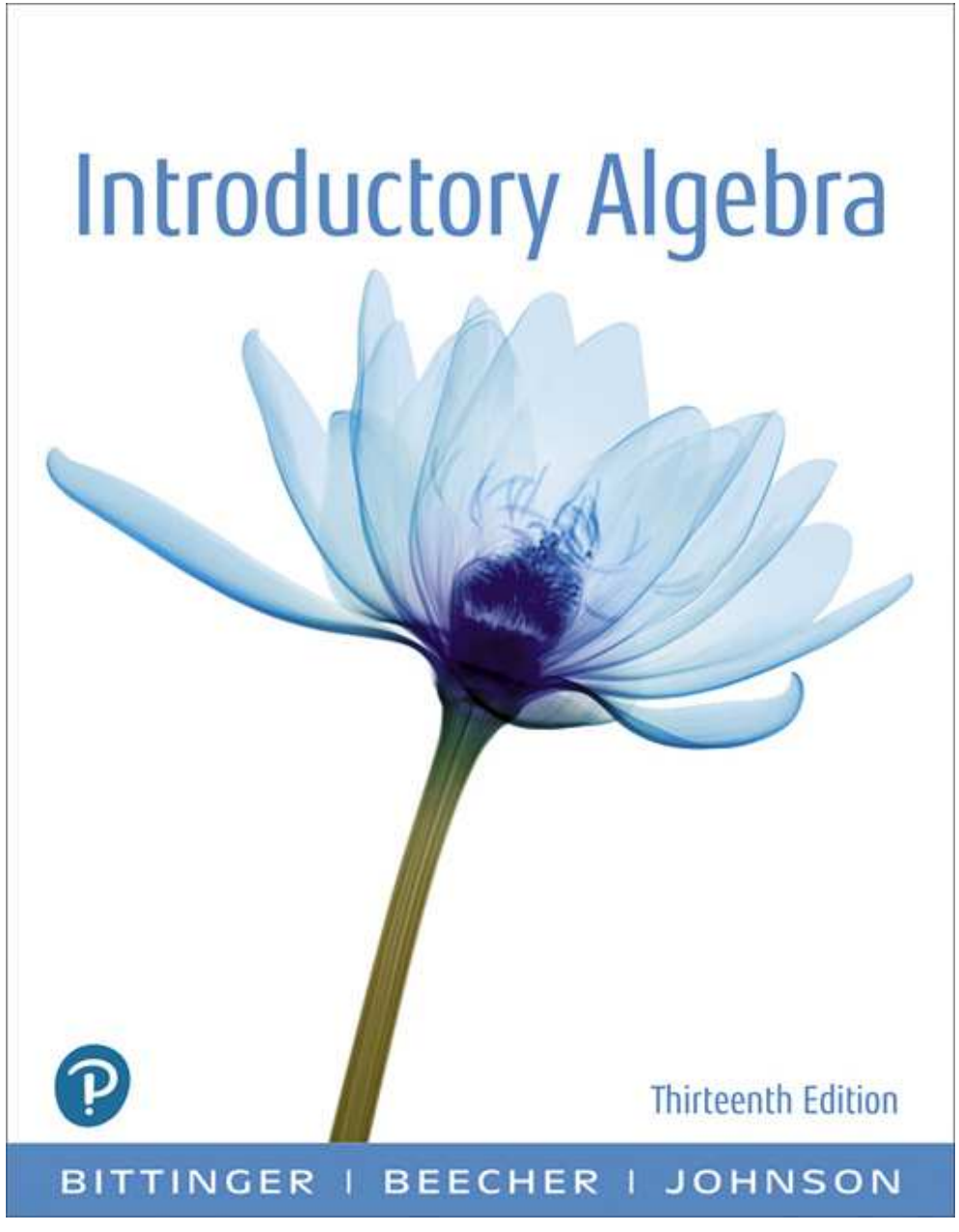

Copyright © 2019, 2015, 2011 Pearson Education, Inc.

Introductory Algebra 13th edition Bittinger Solutions Manual

2.2 SOLVING EQUATIONS: THE MULTIPLICATION PRINCIPLE

a. Solve equations using the multiplication principle.

Copyright © 2019, 2015, 2011 Pearson Education, Inc.

Introductory Algebra 13th edition Bittinger Solutions Manual

The Multiplication Principle For Equations

For any real numbers a, b, and c with $c \neq 0$,

$a = b$ is equivalent to $a \cdot c = b \cdot c$.

Copyright © 2019, 2015, 2011 Pearson Education, Inc.

Introductory Algebra 13th edition Bittinger Solutions Manual

Example

Solve $6x = 96$.

Solution

$$\frac{6x}{6} = \frac{96}{6}$$

Dividing by 6 on both sides

$$x = 16$$

Check:

$6x$	$=$	96
$6(16)$	$=$	96
96		TRUE

The solution is 16.

Copyright © 2019, 2015, 2011 Pearson Education, Inc.

Introductory Algebra 13th edition Bittinger Solutions Manual

Example

Solve: $-7x = 84$

$$\frac{-7x}{7} = \frac{84}{-7}$$

Dividing both sides by –7.

$$1 \cdot x = -12$$

$$x = -12$$

Check:

$-7x = 84$
$-7(-12)$ | 84
84 | True

The solution is –12.

Copyright © 2019, 2015, 2011 Pearson Education, Inc.

Introductory Algebra 13th edition Bittinger Solutions Manual

Example

Solve $-x = 6$.

Solution

$$-x = 6$$

$$(-1)(-x) = (-1)6 \quad \text{Multiplying by } -1 \text{ on both sides}$$

$$-1(-1)x = -6$$

$$x = -6$$

The solution is -6.

Copyright © 2019, 2015, 2011 Pearson Education, Inc.

Introductory Algebra 13th edition Bittinger Solutions Manual

Example

Solve: $\frac{3}{4}x = 15$

Solution

$$\frac{3}{4}x = 15$$

$$\frac{4}{3} \cdot \frac{3}{4}x = 15 \cdot \frac{4}{3}$$

Multiplying by the reciprocal of ¾ on both sides.

$$1x = 20$$

$$x = 20$$

Copyright © 2019, 2015, 2011 Pearson Education, Inc.

Introductory Algebra 13th edition Bittinger Solutions Manual

Example

Solve: $3.2y = 9600$

$$3.2y = 9600$$

$$\frac{3.2y}{3.2} = \frac{9600}{3.2}$$

$$y = 3000$$

Copyright © 2019, 2015, 2011 Pearson Education, Inc.

Introductory Algebra 13th edition Bittinger Solutions Manual

Chapter 2

Solving Equations and Inequalities

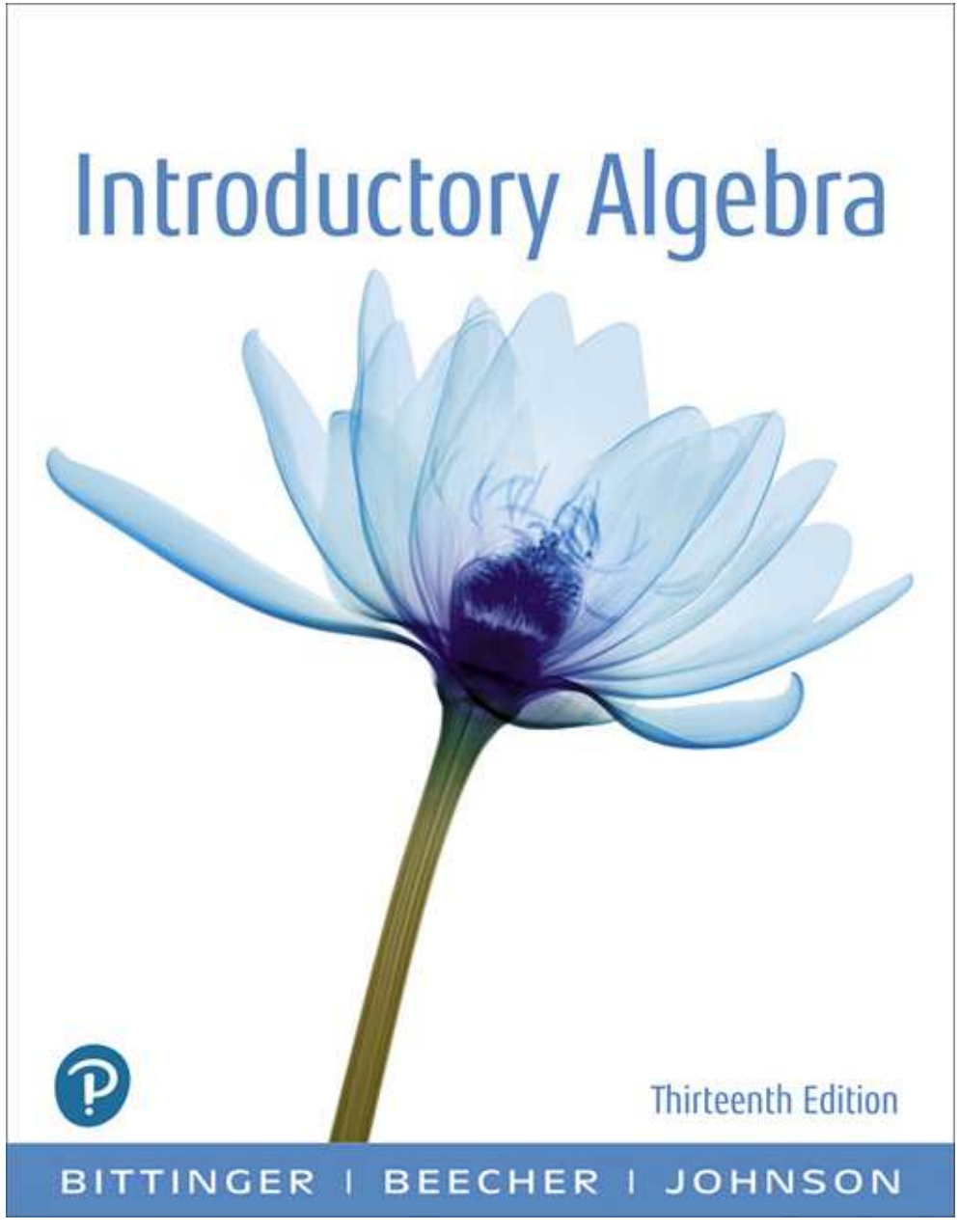

Copyright © 2019, 2015, 2011 Pearson Education, Inc.

Introductory Algebra 13th edition Bittinger Solutions Manual

2.3 USING THE PRINCIPLES TOGETHER

a. Solve equations using both the addition principle and the multiplication principle.

b. Solve equations in which like terms may need to be collected.

c. Solve equations by first removing parentheses and collecting like terms; solve equations with an infinite number of solutions and equations with no solutions.

Copyright © 2019, 2015, 2011 Pearson Education, Inc.

Introductory Algebra 13th edition Bittinger Solutions Manual

Example

Solve: $9 + 8x = 33$

$$9 + 8x - 9 = 33 - 9$$ Subtracting 9 from both sides

$$9 + (-9) + 8x = 24$$

$$8x = 24$$

$$\frac{8x}{8} = \frac{24}{8}$$ Dividing both sides by 8

$$x = 3$$

Check: $\underline{9 + 8x = 33}$

$9 + 8(3) \mid 33$

$9 + 24 \quad \mid$

33 TRUE

The solution is 3.

Copyright © 2019, 2015, 2011 Pearson Education, Inc.

Introductory Algebra 13th edition Bittinger Solutions Manual

Example

Solve: $35 - x = 27$.

Solution

$$35 - x = 27$$

$$-35 + 35 - x = -35 + 27 \quad \text{Adding } -35 \text{ on both sides}$$

$$-x = -8$$

$$-1(-x) = -1(-8) \quad \text{Multiplying by } -1 \text{ on both sides}$$

$$x = 8$$

Copyright © 2019, 2015, 2011 Pearson Education, Inc.

Introductory Algebra 13th edition Bittinger Solutions Manual

Collecting Like Terms

If there are like terms on one side of the equation, we collect them before using the addition principle or the multiplication principle.

If there are like terms on opposite sides of the equation, we get them on the same side by using the addition principle. Then we collect them. In other words, we get all the terms with a variable on one side of the equation and all the terms without a variable on the other side.

Copyright © 2019, 2015, 2011 Pearson Education, Inc.

Introductory Algebra 13th edition Bittinger Solutions Manual

Example

Solve: $5x + 4x = 36$ Collecting like terms

$9x = 36$

$\frac{9x}{9} = \frac{36}{9}$ Dividing by 9 on both sides

$x = 4$

Check: $\underline{5x + 4x = 36}$

$5(4) + 4(4) \mid 36$

$20 + 16 \mid 36$

36

The solution is 4.

Copyright © 2019, 2015, 2011 Pearson Education, Inc.

Introductory Algebra 13th edition Bittinger Solutions Manual

Example

Solve: $4x + 7 - 6x = 10 + 3x + 12$

$$-2x + 7 = 22 + 3x$$ Collecting like terms

$$-2x + 7 - 7 = 22 + 3x - 7$$ Subtracting 7 from both sides

$$-2x = 15 + 3x$$ Simplifying

$$-2x - 3x = 15 + 3x - 3x$$ Subtracting *3x* from both sides

$$-5x = 15$$

$$\frac{-5x}{-5} = \frac{15}{-5}$$ Dividing both sides by –5

$$x = -3$$

Copyright © 2019, 2015, 2011 Pearson Education, Inc.

Introductory Algebra 13th edition Bittinger Solutions Manual

Clearing Fractions and Decimals

In general, equations are easier to solve if they do not contain fractions or decimals.

The easiest way to clear an equation of fractions is to multiply *every term on both sides* by the **least common multiple of all the denominators**.

To clear an equation of decimals, we count the greatest number of decimals places in any one number and multiply on both sides by that multiple of 10.

Copyright © 2019, 2015, 2011 Pearson Education, Inc.

Introductory Algebra 13th edition Bittinger Solutions Manual

Example

Solve $18.4 - 6.2y = 7.24$

Solution

$$18.4 - 6.2y = 7.24$$

$$100(18.4 - 6.2y) = 100(7.24) \quad \text{Multiplying by 100}$$

$$(100)(18.4) - 100(6.2y) = 100(7.24) \quad \text{Using the distributive law}$$

$$1840 - 620y = 724 \quad \text{Simplifying}$$

$$1840 - 620y - 1840 = 724 - 1840 \quad \text{Subtracting 1840}$$

$$\frac{-620y}{-620} = \frac{-1116}{-620} \quad \text{Collecting like terms}$$

Dividing by – 620

$$y = 1.8$$

Copyright © 2019, 2015, 2011 Pearson Education, Inc.

Introductory Algebra 13th edition Bittinger Solutions Manual

Equations Containing Parentheses

To solve certain kinds of equations that contain parentheses, we first use the distributive laws to remove the parentheses. Then we proceed as before.

Copyright © 2019, 2015, 2011 Pearson Education, Inc.

Introductory Algebra 13th edition Bittinger Solutions Manual

Example

Solve: $9x = 3(15 - 2x)$

Solution

$$9x = 3(15 - 2x)$$

$$9x = 45 - 6x$$

$$9x + 6x = 45 - 6x + 6x$$

$$\frac{15x}{15} = \frac{45}{15}$$

$$x = 3$$

Copyright © 2019, 2015, 2011 Pearson Education, Inc.

Introductory Algebra 13th edition Bittinger Solutions Manual

An Equation-Solving Procedure

1. Multiply on both sides to clear the equation of fractions or decimals. (This is optional, but it can ease computations.)
2. If parentheses occur, multiply to remove them using the *distributive laws*.
3. Collect like terms on each side, if necessary.
4. Get all terms with variables on one side and all numbers (constant terms) on the other side, using the *addition principle*.
5. Collect like terms again, if necessary.
6. Multiply or divide to solve for the variable, using the *multiplication principle*.
7. Check all possible solutions in the original equation.

Copyright © 2019, 2015, 2011 Pearson Education, Inc.

Introductory Algebra 13th edition Bittinger Solutions Manual

Example

Solve: $3 - 8(x + 6) = 4(x - 1) - 5.$

$$3 - 8x - 48 = 4x - 4 - 5$$

Using the distributive law to multiply and remove parentheses

$$-45 - 8x = 4x - 9$$

Collecting like terms

$$-8x - 45 + 45 = 4x - 9 + 45$$

Adding 45

$$-8x = 4x + 36$$

Collecting like terms

$$-8x - 4x = 4x + 36 - 4x$$

Subtracting $4x$

$$\frac{-12x}{-12} = \frac{36}{-12}$$

Dividing by -12

$$x = -3$$

Copyright © 2019, 2015, 2011 Pearson Education, Inc.

Introductory Algebra 13th edition Bittinger Solutions Manual

Example

Solve: $8x - 18 = 6 + 8(x - 3)$

Solution

$$8x - 18 = 6 + 8(x - 3)$$ Using the distributive law to multiply and remove parentheses

$$8x - 18 = 6 + 8x - 24$$ Collecting like terms

$$8x - 18 = 8x - 18$$

$$8x - 8x - 18 = 8x - 8x - 18$$ Adding $-8x$

$$-18 = -18$$ True for all real numbers.

Every real number is a solution. There are infinitely many solutions.

Copyright © 2019, 2015, 2011 Pearson Education, Inc.

Introductory Algebra 13th edition Bittinger Solutions Manual

Example

Solve: $3 - 4(x + 6) = -4(x - 1) - 3$.

Solution

$$3 - 4(x + 6) = -4(x - 1) - 3$$
$$3 - 4x - 24 = -4x + 4 - 3$$
$$-4x - 21 = -4x + 1$$
$$-4x + 4x - 21 = -4x + 4x + 1$$
$$-21 = 1 \qquad \text{FALSE}$$

There are no solutions.

Copyright © 2019, 2015, 2011 Pearson Education, Inc.

Introductory Algebra 13th edition Bittinger Solutions Manual

Chapter 2

Solving Equations and Inequalities

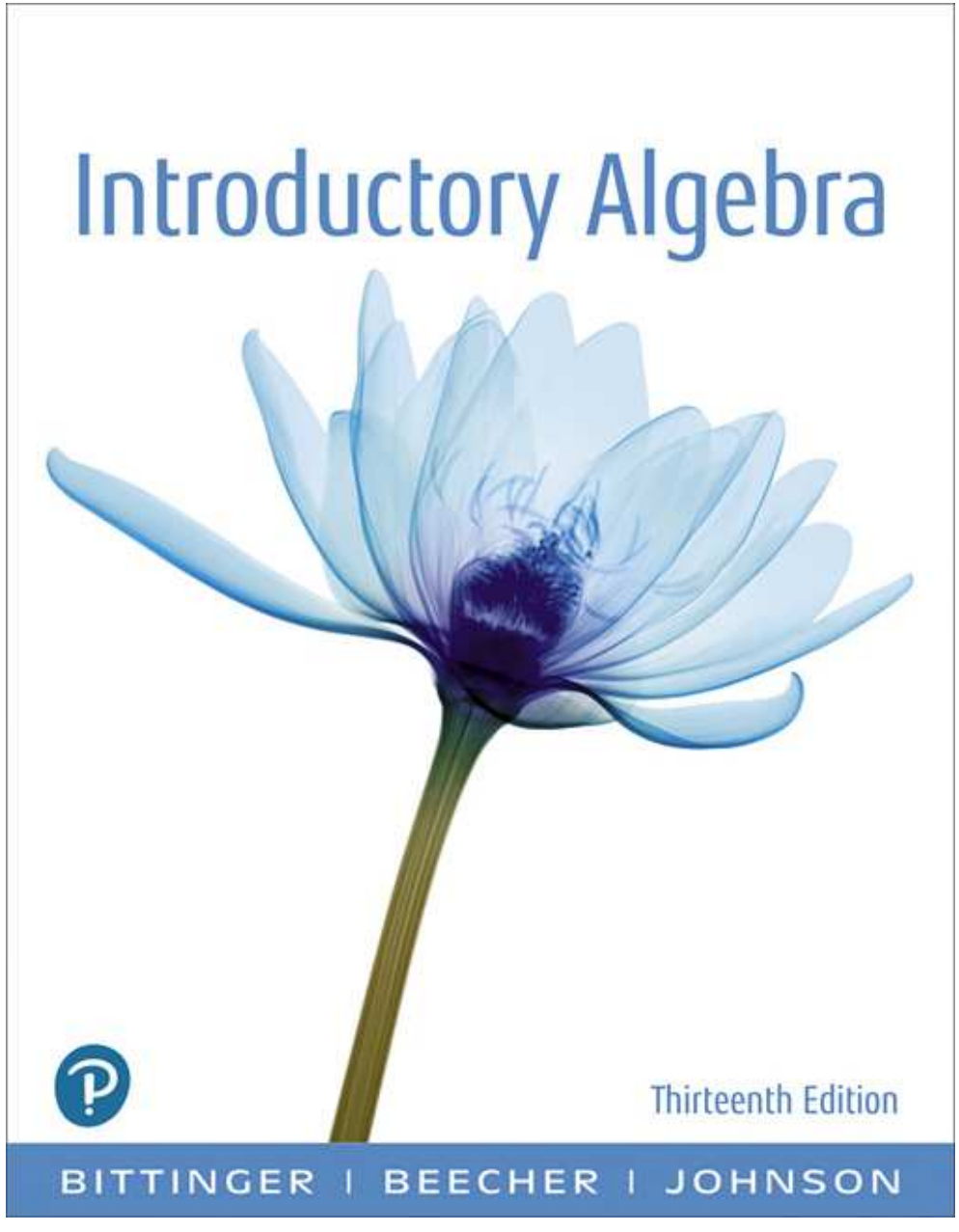

Copyright © 2019, 2015, 2011 Pearson Education, Inc.

Introductory Algebra 13th edition Bittinger Solutions Manual

2.4 FORMULAS

a. Evaluate a formula.

b. Solve a formula for a specified variable.

Copyright © 2019, 2015, 2011 Pearson Education, Inc.

Introductory Algebra 13th edition Bittinger Solutions Manual

A **formula** is a “recipe” for doing a certain type of calculation. Formulas are often given as equations. When we replace the variables in an equation with numbers and calculate the result, we are **evaluating** the formula.

Copyright © 2019, 2015, 2011 Pearson Education, Inc.

Introductory Algebra 13th edition Bittinger Solutions Manual

Example

The formula $M = \frac{1}{5}t$ can be used to determine how far *M*, in miles, you are from lightening when its thunder takes *t* seconds to reach your ears. If it takes 5 seconds for the sound of thunder to reach you after you have seen the lightening, how far away is the storm?

Solution We substitute 5 for *t* and calculate *M*.

$$M = \frac{1}{5}t = \frac{1}{5}(5) = 1$$

The storm is 1 mile away.

Copyright © 2019, 2015, 2011 Pearson Education, Inc.

Introductory Algebra 13th edition Bittinger Solutions Manual

Example

The cost C of operating a microwave oven for 1 year is given by the formula

$$C = \frac{W \times h \times 365}{1000} \cdot k$$

where W = the wattage, h = the number of hours used per day, and k = the energy cost per kilowatt-hour. Find the cost of operating a 1200-W microwave oven for 0.25 hr per day if the energy cost is \$0.12 per kilowatt-hour.

Copyright © 2019, 2015, 2011 Pearson Education, Inc.

Introductory Algebra 13th edition Bittinger Solutions Manual

Example continued

$$C = \frac{W \times h \times 365}{1000} \cdot k$$

1200-W

0.25 hr per day

cost is $0.12 per kilowatt-hour

$$C = \frac{1200 \times 0.25 \times 365}{1000} \cdot 0.12 \approx \$13.14$$

Copyright © 2019, 2015, 2011 Pearson Education, Inc.

Introductory Algebra 13th edition Bittinger Solutions Manual

Example

Solve for r: $d = rt$.

Solution

$$d = rt$$

We want this letter alone.

$$\frac{d}{t} = \frac{rt}{t}$$

Dividing by t

$$\frac{d}{t} = r \cdot \frac{t}{t}$$

$$\frac{d}{t} = r$$

Simplifying

Copyright © 2019, 2015, 2011 Pearson Education, Inc.

Introductory Algebra 13th edition Bittinger Solutions Manual

Example

Solve for x: $y = x + b$.

Solution

$y = x + b$	We want this letter alone.
$y - b = x + b - b$	Subtracting b
$y - b = x$	Simplifying

Copyright © 2019, 2015, 2011 Pearson Education, Inc.

Introductory Algebra 13th edition Bittinger Solutions Manual

Example

Solve for y: $wy + x = z$

Solution

$wy + x = z$ We want this letter alone.

$wy + x - x = z - x$ Subtracting x

$wy = z - x$ Simplifying

$\frac{wy}{w} = \frac{z - x}{w}$ Dividing by w

$y = \frac{z - x}{w}$ Simplifying

Copyright © 2019, 2015, 2011 Pearson Education, Inc.

Introductory Algebra 13th edition Bittinger Solutions Manual

A Formula-Solving Procedure

1. Multiply on both sides to clear fractions or decimals, if that is needed.
2. Collect like terms on each side, if necessary.
3. Get all terms with the letter to be solved for on one side of the equation and all other terms on the other side.
4. Collect like terms again, if necessary.
5. Solve for the letter in question.

Copyright © 2019, 2015, 2011 Pearson Education, Inc.

Introductory Algebra 13th edition Bittinger Solutions Manual

Example

The formula $C = \pi d$ gives the circumference C of a circle with diameter d. Solve for d.

Solution

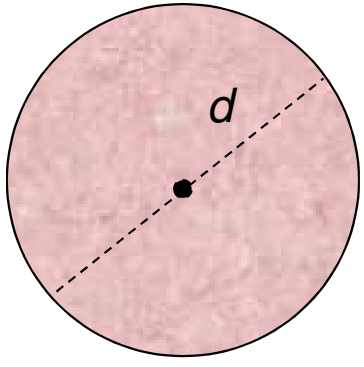

$$C = \pi d$$

$$\frac{C}{\pi} = \frac{\pi d}{\pi}$$

$$\frac{C}{\pi} = d$$

Copyright © 2019, 2015, 2011 Pearson Education, Inc.

Introductory Algebra 13th edition Bittinger Solutions Manual

Chapter 2

Solving Equations and Inequalities

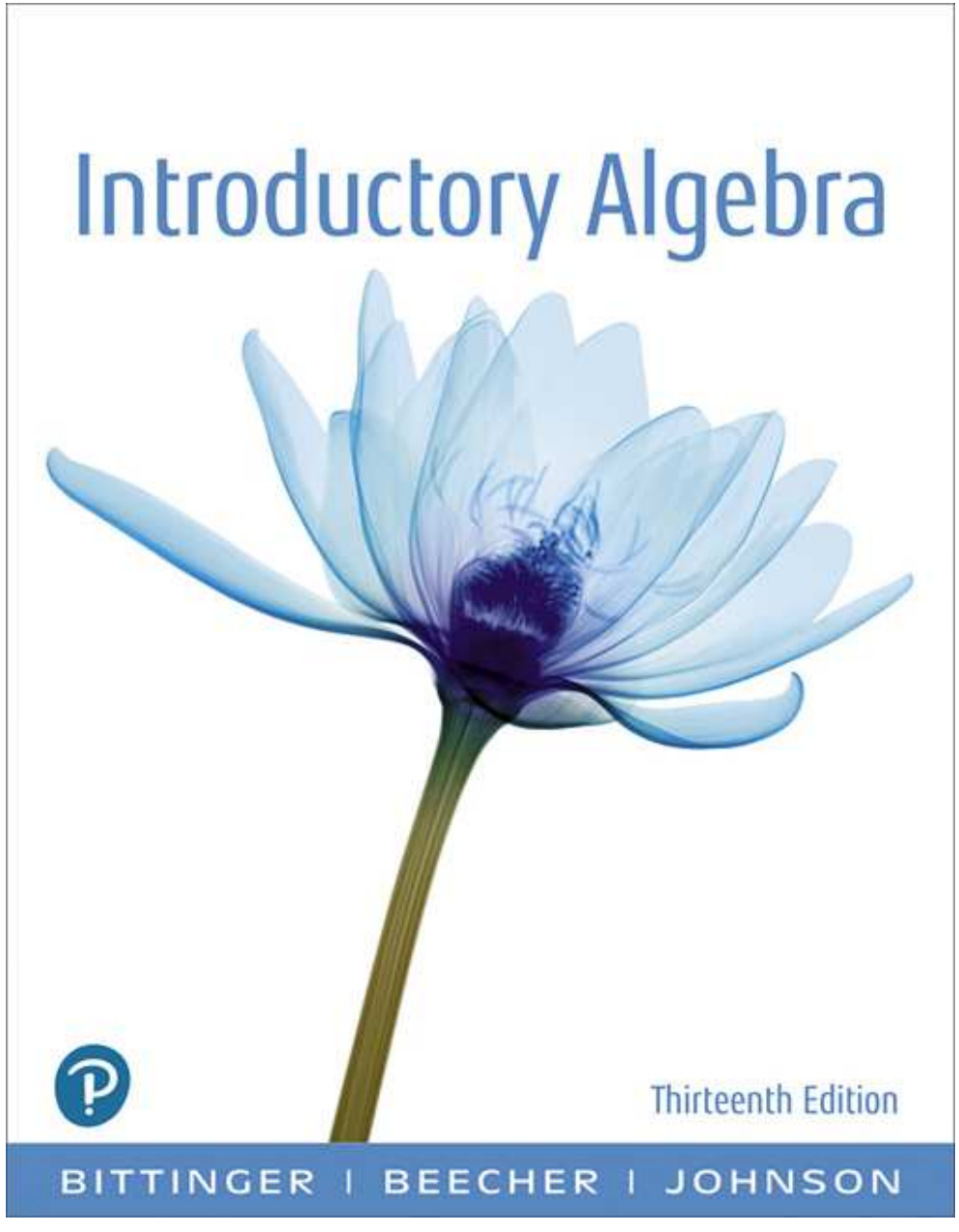

Copyright © 2019, 2015, 2011 Pearson Education, Inc.

Introductory Algebra 13th edition Bittinger Solutions Manual

2.5 APPLICATIONS OF PERCENT

a. Solve applied problems involving percent.

Copyright © 2019, 2015, 2011 Pearson Education, Inc.

Introductory Algebra 13th edition Bittinger Solutions Manual

Key Words in Percent Translations

"**Of**" translates to "•" or "×".

"**Is**" translates to "=".

"**What number**" or "**what percent**" translates to any letter.

% translates to $"\times \frac{1}{100}"$ or $"\times 0.01"$.

Copyright © 2019, 2015, 2011 Pearson Education, Inc.

Introductory Algebra 13th edition Bittinger Solutions Manual

To solve a problem involving percents, it is helpful to translate first to an equation.
For example, “23% of 5 is what?”

23%	of	5	is	what?
↓	↓	↓	↓	↓
0.23	$\cdot$	5	$=$	a

Note how the key words are translated.

Copyright © 2019, 2015, 2011 Pearson Education, Inc.

Introductory Algebra 13th edition Bittinger Solutions Manual

Example

Translate: What is 19% of 82?

Solution

What	is	19%	of	82?
↓	↓	↓	↓	↓
a	$=$	0.19	$\cdot$	82

Copyright © 2019, 2015, 2011 Pearson Education, Inc.

Introductory Algebra 13th edition Bittinger Solutions Manual

Example

Translate: 46% of 12 is what number?

Solution

46%	of	12	is	what number?
↓	↓	↓	↓	↓
46%	$\cdot$	12	$=$	w

Copyright © 2019, 2015, 2011 Pearson Education, Inc.

Introductory Algebra 13th edition Bittinger Solutions Manual

Example

Translate: 7 is 10% of what?

Solution

7	is	10%	of	what?
↓	↓	↓	↓	↓
7	=	0.10	·	b

Copyright © 2019, 2015, 2011 Pearson Education, Inc.

Introductory Algebra 13th edition Bittinger Solutions Manual

Example

Translate: 18 is what percent of 38?

Solution

18	is	what percent	of	38
↓	↓	↓	↓	↓
18	=	p	$\cdot$	38

Copyright © 2019, 2015, 2011 Pearson Education, Inc.

Introductory Algebra 13th edition Bittinger Solutions Manual

3 Types of Percent Problems

1. **Finding the *amount*** (the result of taking the percent)

Example:	What	is	25%	of	60?
Translation:	a	=	0.25	$\cdot$	60

2. **Finding the *base*** (the number you are taking the percent of)

Example:	15	is	25%	of	what number?
Translation:	15	=	0.25	$\cdot$	b

3. **Finding the *percent number*** (the percent itself)

Example:	15	is	what percent	of	60?
Translation:	15	=	p	$\cdot$	60

Copyright © 2019, 2015, 2011 Pearson Education, Inc.

Introductory Algebra 13th edition Bittinger Solutions Manual

Example

What is 8% of 34?

Solution

Translate: $a = 0.08 \cdot 34$

Solve: The variable is by itself. To solve the equation, we just multiply.

$$a = 0.08(34)$$

$$\begin{array}{r} 34 \\ \times\ 0.08 \\ \hline 2.72 \end{array}$$

$$a = 2.72$$

Thus, 2.72 is 8% of 34. The answer is 2.72.

Copyright © 2019, 2015, 2011 Pearson Education, Inc.

Introductory Algebra 13th edition Bittinger Solutions Manual

Example

15 is 16% of what?

Solution

Translate: 15 is 16% of what?

$$15 = 0.16 \cdot b$$

Solve: To solve we divide both sides of the equation by 0.16:

$$15 = 0.16b$$

$$\frac{15}{0.16} = \frac{0.16b}{0.16}$$

$$93.75 = b$$

$$\begin{array}{r} 93.75 \\ 0.16\overline{)15.00.00} \\ \underline{144} \\ 60 \\ \underline{48} \\ 120 \\ \underline{112} \\ 80 \\ \underline{80} \\ 0 \end{array}$$

Copyright © 2019, 2015, 2011 Pearson Education, Inc.

Introductory Algebra 13th edition Bittinger Solutions Manual

Example

27 is what percent of 36?

Solution

Translate: 27 is what percent of 36?

$$27 = p \cdot 36$$

Solve: To solve we divide both sides by 36 and convert the answer to percent notation:

$$27 = p \cdot 36$$

$$\frac{27}{36} = \frac{27p}{36}$$

$$0.75 = p$$

$$p = 75\%$$

$$\begin{array}{r} .75 \\ 36\overline{)27.00} \\ \underline{252} \\ 180 \\ \underline{180} \\ 0 \end{array}$$

Copyright © 2019, 2015, 2011 Pearson Education, Inc.

Introductory Algebra 13th edition Bittinger Solutions Manual

Example

To complete her water safety course instruction, Catherine must complete 45 hours of instruction. If she has completed 75% of her requirement, how many hours has Catherine completed?

Solution

Rewording: What is 75% of 45?

Translating: $a = 0.75 \times 45$

$a = 33.75$

Catherine has completed 33.75 hours of instruction.

Copyright © 2019, 2015, 2011 Pearson Education, Inc.

Introductory Algebra 13th edition Bittinger Solutions Manual

Example

A family pays a monthly electric bill of $172.00. With careful monitoring they can reduce their bill to $163.40. What is the percent of decrease?

Solution We find the amount of decrease.

	172.00	Original bill
–	163.40	New bill
	8.60	Decrease

We rephrase and translate.

8.60 is what percent of 172.00?

$$8.60 = p \cdot 172.00$$

Copyright © 2019, 2015, 2011 Pearson Education, Inc.

Introductory Algebra 13th edition Bittinger Solutions Manual

Example continued

Solve. We divide both sides by 172

$$\frac{8.60}{172} = \frac{172p}{172}$$

$$0.05 = p$$

$$5\% = p$$

The percent of decrease of the electric bill is 5%.

Copyright © 2019, 2015, 2011 Pearson Education, Inc.

Introductory Algebra 13th edition Bittinger Solutions Manual

Chapter 2

Solving Equations and Inequalities

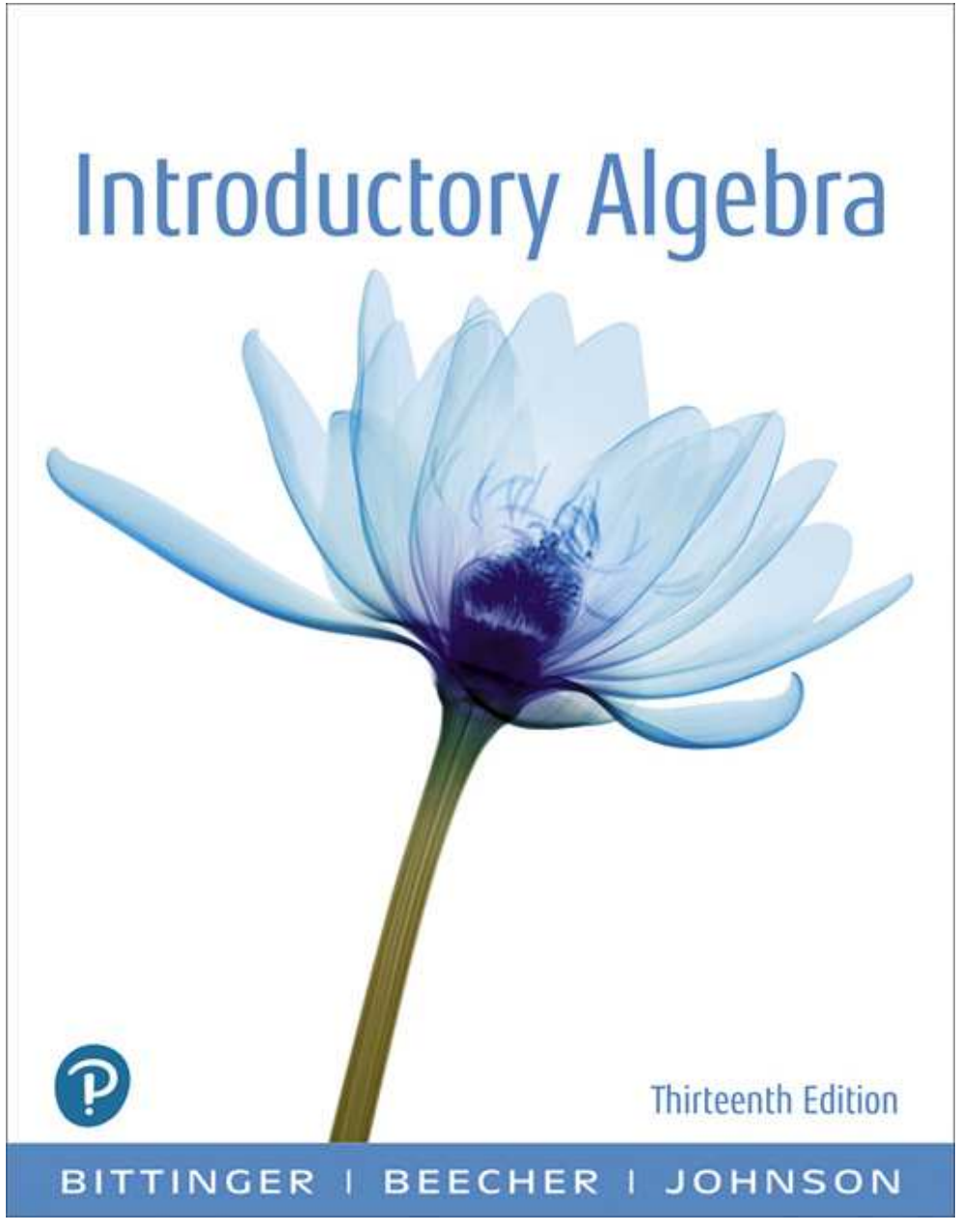

Copyright © 2019, 2015, 2011 Pearson Education, Inc.

Introductory Algebra 13th edition Bittinger Solutions Manual

2.6 APPLICATIONS AND PROBLEM SOLVING

a. Solve applied problems by translating to equations.

Copyright © 2019, 2015, 2011 Pearson Education, Inc.

Introductory Algebra 13th edition Bittinger Solutions Manual

Five Steps for Problem Solving in Algebra

1. *Familiarize* yourself with the problem situation.

2. *Translate* the problem to an equation.

3. *Solve* the equation.

4. *Check* the answer in the original problem.

5. *State* the answer to the problem clearly.

Copyright © 2019, 2015, 2011 Pearson Education, Inc.

Introductory Algebra 13th edition Bittinger Solutions Manual

To Familiarize Yourself with a Problem

- If a problem is given in words, read it carefully. Reread the problem, perhaps aloud. Try to verbalize the problem as if you were explaining it to someone else.
- Choose a variable (or variables) to represent the unknown(s) and clearly state what the variable represents. Be descriptive! For example, let L = length in centimeters, d = distance in miles, and so on.

Copyright © 2019, 2015, 2011 Pearson Education, Inc.

Introductory Algebra 13th edition Bittinger Solutions Manual

To Familiarize Yourself with a Problem

- Make a drawing and label it with known information, using specific units if given. Also, indicate the unknown information.
- Find further information. Look up formulas or definitions with which you are not familiar. Consult the Internet or a reference librarian.
- Create a table that lists all the information you have available. Look for patterns that may help in the translation to an equation.
- Think of a possible answer and check the guess. Note the manner in which the guess is checked.

Copyright © 2019, 2015, 2011 Pearson Education, Inc.

Introductory Algebra 13th edition Bittinger Solutions Manual

Example

A 480-in. piece of pipe is cut into two pieces. One piece is three times the length of the other. Find the length of each piece of pipe.

Solution

1. **Familiarize**. Make a drawing. Noting the lengths. Let x = the length of the shorter piece. Then $3x$ = the length of the longer piece.

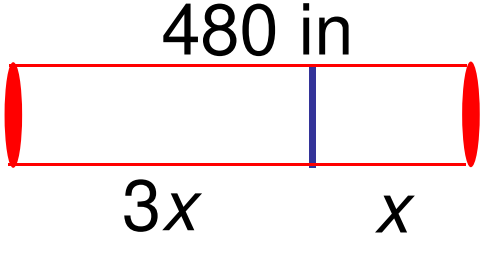

Copyright © 2019, 2015, 2011 Pearson Education, Inc.

Introductory Algebra 13th edition Bittinger Solutions Manual

Example continued

2. **Translate**. From the statement of the problem and drawing, we know the lengths add up to 480 inches.

$$x + 3x = 480$$

3. **Solve**.

$$x + 3x = 480$$

$$\frac{4x}{4} = \frac{480}{4}$$

$$x = 120 \text{ inches}$$

Copyright © 2019, 2015, 2011 Pearson Education, Inc.

Introductory Algebra 13th edition Bittinger Solutions Manual

Example continued

4. **Check**. Do we have an answer to the problem?

   No, we need the lengths of both pieces of pipe.

   If $x = 120$ the length of the shorter piece

   $3x$ = the length of the longer piece.

   $3(120) = 360$ inches

   Since $120 + 360 = 480$ our answer checks.

5. **State.** One section of pipe is 120 inches and the other section is 360 inches.

Copyright © 2019, 2015, 2011 Pearson Education, Inc.

Introductory Algebra 13th edition Bittinger Solutions Manual

Example

Digicon prints digital photos for $0.12 each plus $3.29 shipping and handling. Your weekly budget for the school yearbook is $22.00. How many prints can you have made if you have $22.00?

Solution

1. **Familarize**. Suppose the yearbook staff takes 220 digital photos. Then the cost to print them would be the shipping charge plus $0.12 times 220. $3.29 + $0.12(220) which is $29.69. Our guess of 220 is too large, but we have familiarized ourselves with the way in which the calculation is made.

Copyright © 2019, 2015, 2011 Pearson Education, Inc.

Introductory Algebra 13th edition Bittinger Solutions Manual

Example continued

2. **Translate.**

	Shipping	plus	photo cost	is	\$22
Rewording:	↓	↓	↓	↓	↓
Translating:	\$3.29	+	$0.12(x)$	=	22

3. **Carry out.**

$$3.29 + 0.12x = 22$$

$$0.12x = 18.71$$

$$x = 155.9 = 155$$

Copyright © 2019, 2015, 2011 Pearson Education, Inc.

Introductory Algebra 13th edition Bittinger Solutions Manual

Example continued

4. **Check**. Check in the original problem.
   $3.29 + 155(0.12) = $21.89, which is less than $22.00.

5. **State.** The yearbook staff can have 155 photos printed per week.

Copyright © 2019, 2015, 2011 Pearson Education, Inc.

Introductory Algebra 13th edition Bittinger Solutions Manual

Consecutive integers:

16, 17, 18, 19, 20; and so on

x, $x + 1$, $x + 2$; and so on.

Consecutive even integers:

16, 18, 20, 22, and so on

x, $x + 2$, $x + 4$, and so on.

Consecutive odd integers:

21, 23, 25, 27, 29, and so on

x, $x + 2$, $x + 4$, and so on.

Copyright © 2019, 2015, 2011 Pearson Education, Inc.

Introductory Algebra 13th edition Bittinger Solutions Manual

Example

The apartments in Wanda's apartment house are consecutively numbered on each floor. The sum of her number and her next door neighbor's number is 723. What are the two numbers?

Solution

1. **Familiarize.** The apartment numbers are consecutive integers.

   Let x = Wanda's apartment

   Let $x + 1$ = neighbor's apartment

Copyright © 2019, 2015, 2011 Pearson Education, Inc.

Introductory Algebra 13th edition Bittinger Solutions Manual

Example continued

2. **Translate.**

Rewording:	First integer	plus	second integer	is	723
	↓	↓	↓	↓	↓
Translating:	x	$+$	$(x+1)$	$=$	723

3. **Carry out.**

$$x + (x + 1) = 723$$

$$2x + 1 = 723$$

$$2x = 722$$

$$x = 361$$

If x is 361, then $x + 1$ is 362.

Copyright © 2019, 2015, 2011 Pearson Education, Inc.

Introductory Algebra 13th edition Bittinger Solutions Manual

Example continued

4. **Check**. Our possible answers are 361 and 362. These are consecutive integers and the sum is 723.

5. **State.** The apartment numbers are 361 and 362.

Copyright © 2019, 2015, 2011 Pearson Education, Inc.

Introductory Algebra 13th edition Bittinger Solutions Manual

Example

You are constructing a triangular kite. The second angle of the kite is three times as large as the first. The third angle is 10 degrees more than the first. Find the measure of each angle.

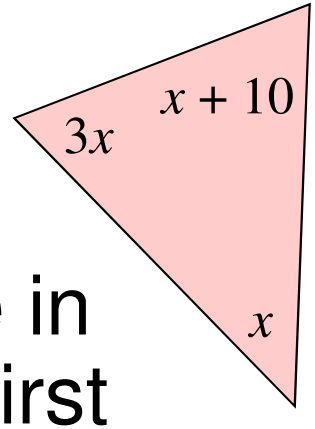

Solution

1. **Familiarize**. Make a drawing and write in the given information. Let x = measure of first angle, $3x$ = second, $x + 10$ = third.

2. **Translate**. To translate, we need to recall that the sum of the measures of the angles in a triangle is 180 degrees.

Copyright © 2019, 2015, 2011 Pearson Education, Inc.

Introductory Algebra 13th edition Bittinger Solutions Manual

Example continued

2. **Translate.**

Measure of first angle	+	measure of second angle	+	measure of third angle	is	180°
$\downarrow$	$\downarrow$	$\downarrow$	$\downarrow$	$\downarrow$	$\downarrow$	$\downarrow$
x	$+$	$3x$	$+$	$(x+10)$	$=$	180

3. **Solve** $x + 3x + (x + 10) = 180$

$$5x + 10 = 180$$

$$5x = 170$$

$$x = 34$$

Copyright © 2019, 2015, 2011 Pearson Education, Inc.

Introductory Algebra 13th edition Bittinger Solutions Manual

Example continued

The measures for the angles appear to be:

first angle: $x = 34$

second angle: $3x = 3(34) = 102$;

third angle: $x + 10 = 34 + 10 = 44$

4. **Check.** Consider 34, 102 and 44 degrees. The sum of these numbers is 180 degrees and the second angle is three times the first angle. The third angle is 10 degrees more than the first. These numbers check.

5. **State.** The measures of the angles are 34, 44 and 102 degrees.

Copyright © 2019, 2015, 2011 Pearson Education, Inc.

Introductory Algebra 13th edition Bittinger Solutions Manual

Example

The Hicksons are planning to sell their home. If they want to be left with $142,00 after paying 6% of the selling price to a realtor as a commission, for how much must they sell the house?

Familiarize. Suppose the Hicksons sell the house for $150,000. A 6% commission can be determined by finding 6% of 150,000.

$$6\% \text{ of } 150{,}000 = 0.06(150{,}000) = 9000.$$

Subtracting this commission from $150,000 would leave the Hicksons with 150,000 – 9,000 = 141,000.

Copyright © 2019, 2015, 2011 Pearson Education, Inc.

Introductory Algebra 13th edition Bittinger Solutions Manual

Example continued

Translate. Reword the problem and translate.

$$\underbrace{\text{Selling price}}_{x}\ \underbrace{\text{less}}_{-}\ \underbrace{\text{Commission}}_{0.06x}\ \underbrace{\text{is}}_{=}\ \underbrace{\text{Amount remaining}}_{142{,}000}$$

Solve.

$$\begin{aligned} x - 0.06x &= 142{,}000 \\ 1x - 0.06x &= 142{,}000 \\ \frac{0.94x}{0.94} &= \frac{142{,}000}{0.94} \\ x &= 151{,}063.83 \end{aligned}$$

Copyright © 2019, 2015, 2011 Pearson Education, Inc.

Introductory Algebra 13th edition Bittinger Solutions Manual

Example continued

Check.

Find 6% of 151,063.83:

6% of 151,063.83 = (0.06)(151,063.83) = 9063.83

Subtract the commission to find the remaining amount.

$$151{,}063.83 - 9063.83 = 142{,}000.$$

State.

To be left with $142,000 the Hicksons must sell the house for $151,063.83.

Copyright © 2019, 2015, 2011 Pearson Education, Inc.

Introductory Algebra 13th edition Bittinger Solutions Manual

Chapter 2

Solving Equations and Inequalities

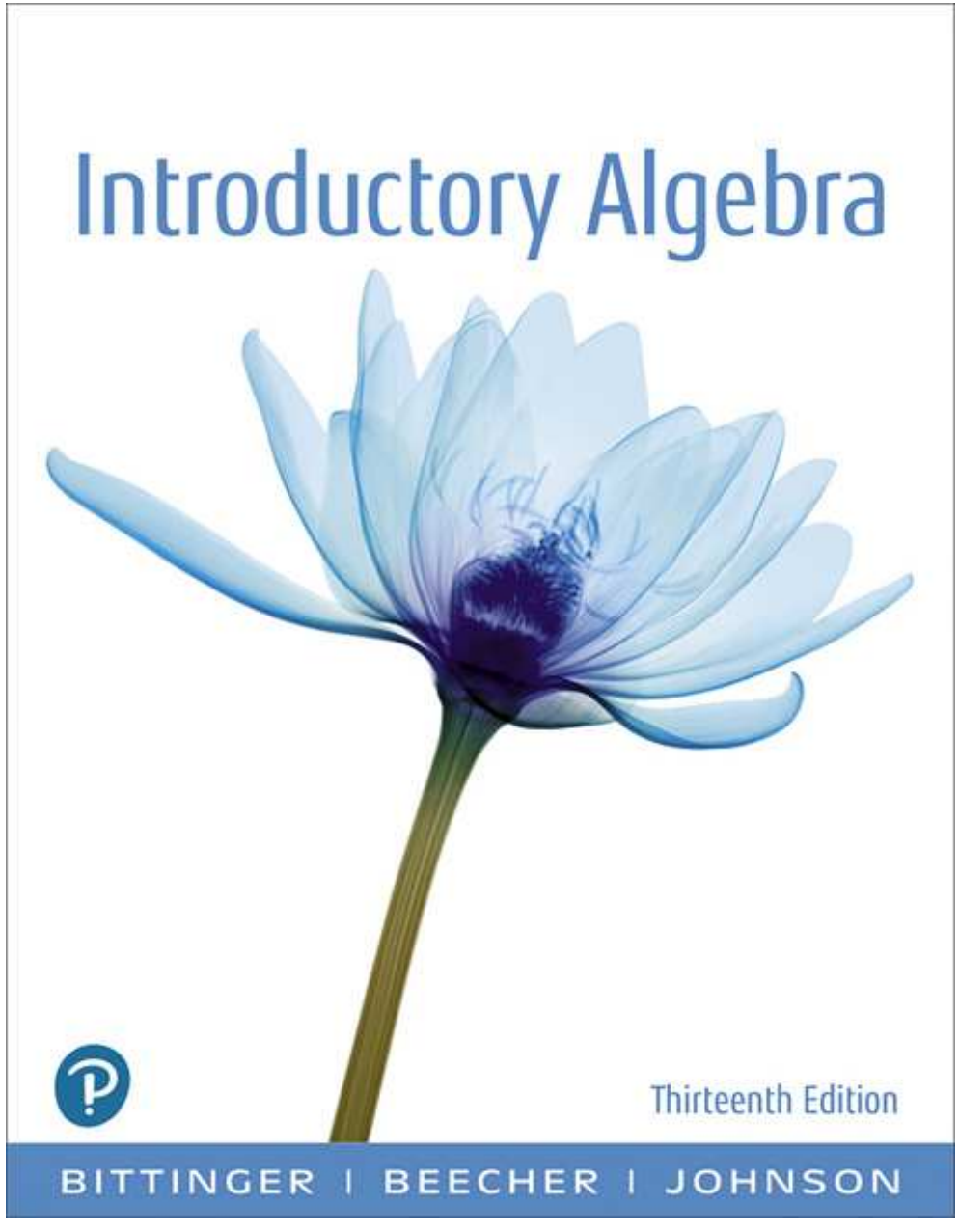

Copyright © 2019, 2015, 2011 Pearson Education, Inc.

Introductory Algebra 13th edition Bittinger Solutions Manual

2.7 SOLVING INEQUALITIES

a. Determine whether a given number is a solution of an inequality.

b. Graph an inequality on a number line.

c. Solve inequalities using the addition principle.

d. Solve inequalities using the multiplication principle.

e. Solve inequalities using the addition and multiplication principles together.

Copyright © 2019, 2015, 2011 Pearson Education, Inc.

Introductory Algebra 13th edition Bittinger Solutions Manual

Solutions of Inequalities

An **inequality** is a number sentence with > (is greater than), < (is less than), ≥ (is greater than or equal to), or ≤ (is less than or equal to).

Solution of an Inequality

A replacement that makes an inequality true is called a **solution**. The set of all solutions is called the **solution set**. When we have found the set of all solutions of an inequality, we say that we have **solved** the inequality.

Copyright © 2019, 2015, 2011 Pearson Education, Inc.

Introductory Algebra 13th edition Bittinger Solutions Manual

Example

Determine whether the given number is a solution of $x < 5$: a) -4 b) 6

Solution

a) Since $-4 < 5$ is true, -4 is a solution.

b) Since $6 < 5$ is false, 6 is not a solution.

Copyright © 2019, 2015, 2011 Pearson Education, Inc.

Introductory Algebra 13th edition Bittinger Solutions Manual

Graphs of Inequalities

Because solutions of inequalities like $x < 4$ are too numerous to list, it is helpful to make a drawing that represents all the solutions.

A **graph** of an inequality is a drawing that represents its solutions. Graphs of inequalities in one variable can be drawn on a number line by shading all the points that are solutions.

Copyright © 2019, 2015, 2011 Pearson Education, Inc.

Introductory Algebra 13th edition Bittinger Solutions Manual

Example

Graph each inequality:

a) $x < 3$, b) $y \geq -4$; c) $-3 < x \leq 5$

Solution

a) The solutions of $x < 3$ are those numbers less than 3.

Shade all points to the left of 3.

The parenthesis at 3 and the shading to the left indicate that 3 is *not* part of the graph, but numbers like 1 and –2 are.

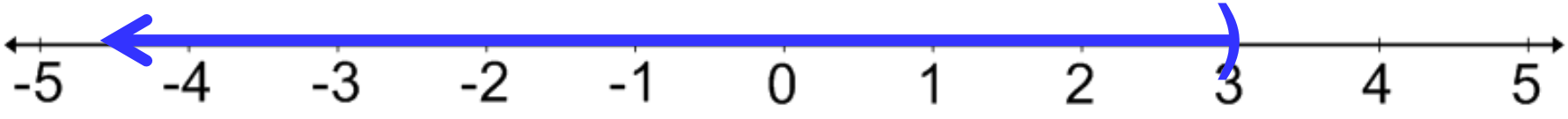

Copyright © 2019, 2015, 2011 Pearson Education, Inc.

Introductory Algebra 13th edition Bittinger Solutions Manual

Example continued

b) The solutions of $y \geq -4$ are shown on the number line by shading the point for -4 and all points to the right of -4. The bracket at -4 indicates that -4 is part of the graph.



c) The inequality $-3 < x \leq 5$ is read "-3 is less than x *and* x is less than or equal to 5."

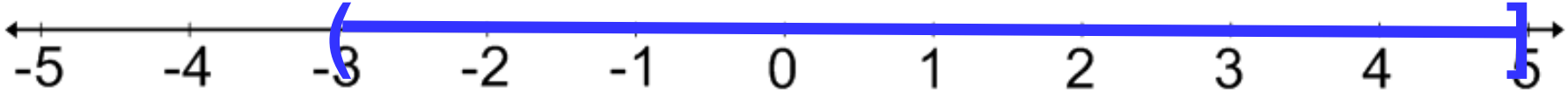

Copyright © 2019, 2015, 2011 Pearson Education, Inc.

Introductory Algebra 13th edition Bittinger Solutions Manual

The Addition Principle for Inequalities

For any real numbers a, b, and c:

$a < b$ is equivalent to $a + c < b + c$;

$a \leq b$ is equivalent to $a + c \leq b + c$;

$a > b$ is equivalent to $a + c > b + c$;

$a \geq b$ is equivalent to $a + c \geq b + c$;

When we add or subtract the same number on both sides of an inequality, the direction of the inequality symbol is not changed.

Copyright © 2019, 2015, 2011 Pearson Education, Inc.

Introductory Algebra 13th edition Bittinger Solutions Manual

Example

Solve: $x + 6 > 2$ Then graph.

Solution

$$x + 6 > 2$$
$$x + 6 - 6 > 2 - 6$$
$$x > -4$$

Any number greater than –4 makes the statement true.



Copyright © 2019, 2015, 2011 Pearson Education, Inc.

Introductory Algebra 13th edition Bittinger Solutions Manual

Example

Solve $4x - 1 \leq 3x - 4$ and then graph the solution.

Solution

$$4x - 1 \leq 3x - 4$$

$$4x - 1 + 1 \leq 3x - 4 + 1 \quad \text{Adding 1 to both sides}$$

$$4x \leq 3x - 3 \quad \text{Simplifying}$$

$$4x - 3x \leq 3x - 3x - 3 \quad \text{Subtracting } 3x \text{ from both sides}$$

$$x \leq -3 \quad \text{Simplifying}$$

The solution set is $\{x | x \leq -3\}$.

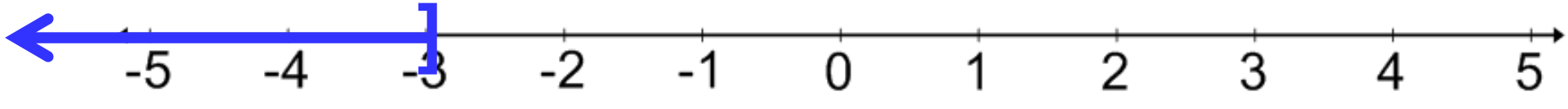

Copyright © 2019, 2015, 2011 Pearson Education, Inc.

Introductory Algebra 13th edition Bittinger Solutions Manual

The Multiplication Principle for Inequalities

For any real numbers a and b, and for any *positive* number c:

$a < b$ is equivalent to $ac < bc$, and

$a > b$ is equivalent to $ac > bc$.

For any real numbers a and b, and for any *negative* number c:

$a < b$ is equivalent to $ac > bc$, and

$a > b$ is equivalent to $ac < bc$.

Similar statements hold for $\leq$ and $\geq$.

Copyright © 2019, 2015, 2011 Pearson Education, Inc.

Introductory Algebra 13th edition Bittinger Solutions Manual

The Multiplication Principle for Inequalities (continued)

When we multiply or divide by a positive number on both sides of an inequality, the direction of the inequality symbol stays the same. When we multiply or divide by a negative number on both sides of an inequality, the direction of the inequality symbol is reversed.

Copyright © 2019, 2015, 2011 Pearson Education, Inc.

Introductory Algebra 13th edition Bittinger Solutions Manual

Example

Solve and graph each inequality:

a) $7x \le 35$ b) $-4y < 20$

Solution

a) $7x \le 35$

$$\frac{7x}{7} \le \frac{35}{7}$$ Dividing by 7

The symbol stays the same.

$x \le 5$ Simplifying

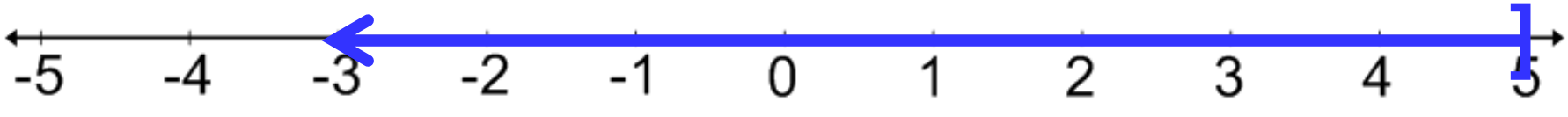

Copyright © 2019, 2015, 2011 Pearson Education, Inc.

Introductory Algebra 13th edition Bittinger Solutions Manual

Example continued

b) $-4y < 20$

$$\frac{-4y}{-4} > \frac{20}{-4}$$ Dividing both sides by -4

The symbol must be reversed!

$$y > -5$$

The solution set is $\{y|y > -5\}$. The graph is shown below.



Copyright © 2019, 2015, 2011 Pearson Education, Inc.

Introductory Algebra 13th edition Bittinger Solutions Manual

Example

Solve: $3x - 3 > x + 7$

$3x - 3 + 3 > x + 7 + 3$	Adding 3 to both sides
$3x > x + 10$	Simplifying
$3x - x > x - x + 10$	Subtracting x from both sides
$2x > 10$	Simplifying
$\frac{2x}{2} > \frac{10}{2}$	Dividing both sides by 2
$x > 5$	Simplifying

The solution set is $\{x \mid x > 5\}$.

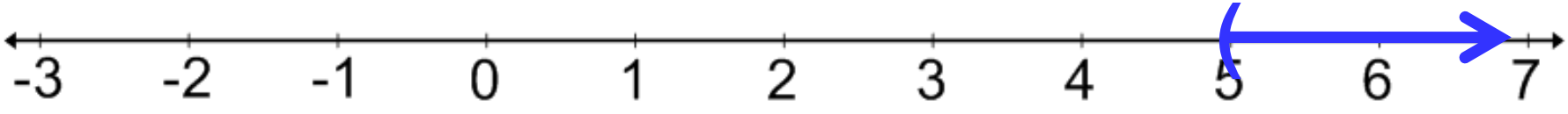

Copyright © 2019, 2015, 2011 Pearson Education, Inc.

Introductory Algebra 13th edition Bittinger Solutions Manual

Example

Solve: $5(x-3)-7x \geq 4(x-3)+9$

$5x-15-7x \geq 4x-12+9$	Using the distributive law to remove parentheses
$-2x-15 \geq 4x-3$	Simplifying
$-2x-15+3 \geq 4x-3+3$	Adding 3 to both sides
$-2x-12 \geq 4x$	Simplifying
$-2x+2x-12 \geq 4x+2x$	Adding $2x$ to both sides
$-12 \geq 6x$	Dividing both sides by 6
$-2 \geq x$	

The solution set is $\{x \mid x \leq -2\}$.

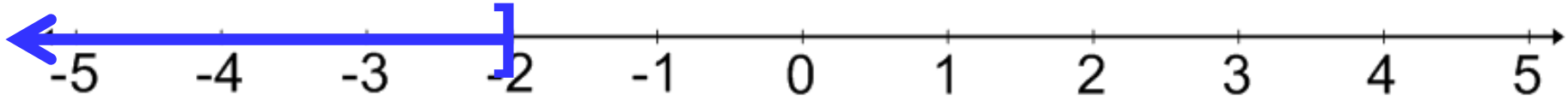

Copyright © 2019, 2015, 2011 Pearson Education, Inc.

Introductory Algebra 13th edition Bittinger Solutions Manual

Example

Solve: $15.4 - 3.2x < -6.76$

$$100(15.4 - 3.2x) < 100(-6.76)$$

$$100(15.4) - 100(3.2x) < 100(-6.76)$$

$$1540 - 320x < -676$$

$$1540 - 320x - 1540 < -676 - 1540$$

$$-320x < -2216$$

$$x > \frac{-2216}{-320}$$

Remember to reverse the symbol!

$$x > 6.925$$

The solution set is $\{x | x > 6.925\}$.

Copyright © 2019, 2015, 2011 Pearson Education, Inc.

Introductory Algebra 13th edition Bittinger Solutions Manual

Chapter 2

Solving Equations and Inequalities

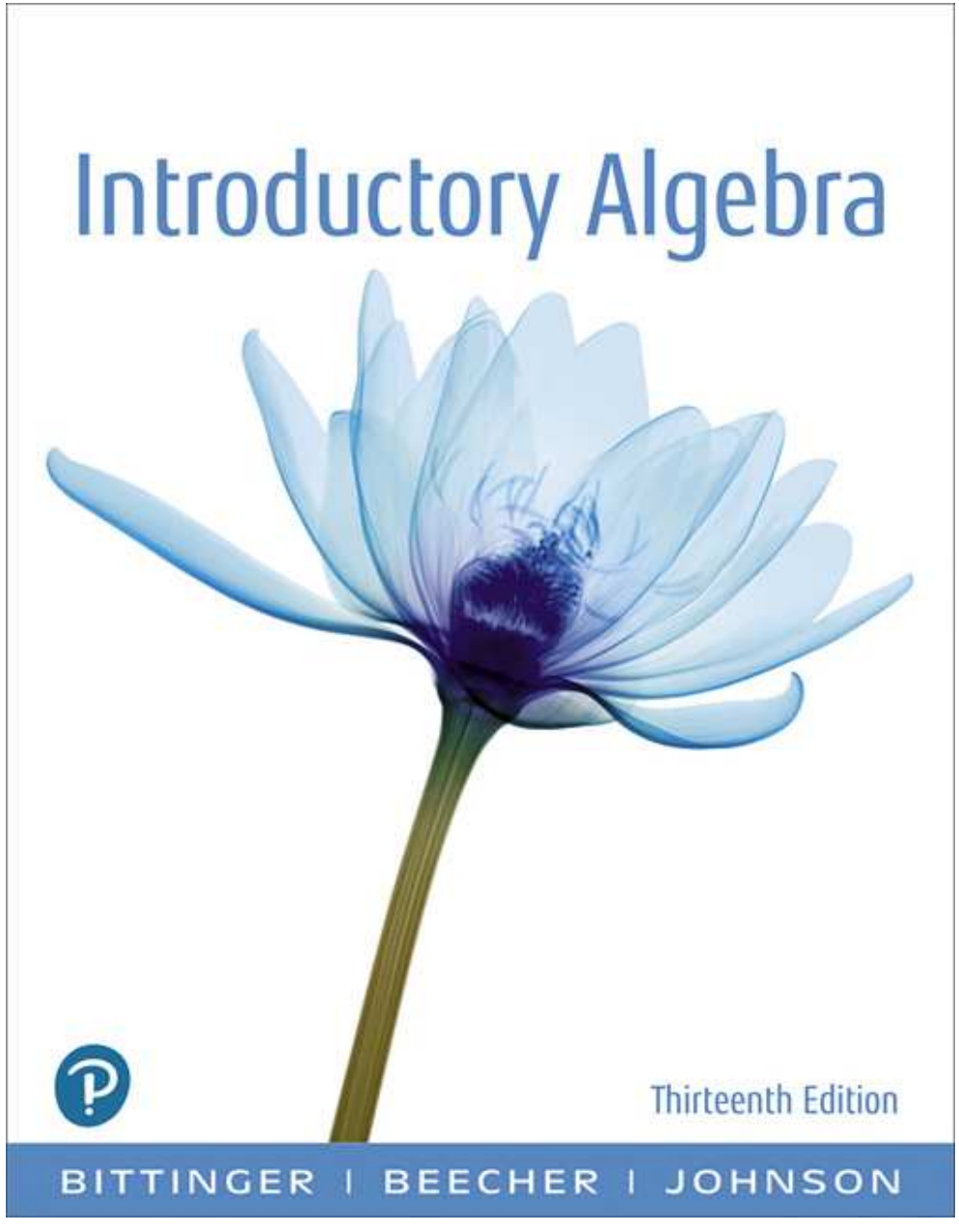

Copyright © 2019, 2015, 2011 Pearson Education, Inc.

Introductory Algebra 13th edition Bittinger Solutions Manual

2.8 APPLICATIONS AND PROBLEM SOLVING WITH INEQUALITIES

a. Translate number sentences to inequalities.

b. Solve applied problems using inequalities.

Copyright © 2019, 2015, 2011 Pearson Education, Inc.

Introductory Algebra 13th edition Bittinger Solutions Manual

Important Words	Sample Sentence	Translation
is at least	Brian is at least 16 years old	$b \geq 16$
is at most	At most 3 students failed the course	$s \leq 3$
cannot exceed	To qualify, earnings cannot exceed \$5000	$e \leq \$5000$
must exceed	The speed must exceed 20 mph	$s > 20$
is less than	Nicholas is less than 60 lb.	$n < 60$
is more than	Chicago is more than 300 miles away.	$c > 300$
is between	The movie is between 70 and 120 minutes.	$70 < m < 120$
no more than	The calf weighs no more than 560 lb.	$w \leq 560$
no less than	Carmon scored no less than 9.4.	$c \geq 9.4$

Copyright © 2019, 2015, 2011 Pearson Education, Inc.

Introductory Algebra 13th edition Bittinger Solutions Manual

Translating "at least" and "at most"

The quantity x is at least some amount q: $x \geq q$.
(If x is at least q, it cannot be less than q.)

The quantity x is at most some amount q: $x \leq q$.
(If x is at most q, it cannot be more than q.)

Copyright © 2019, 2015, 2011 Pearson Education, Inc.

Introductory Algebra 13th edition Bittinger Solutions Manual

Example

Lazer Line charges \$65 plus \$45 per hour for copier repair. Jonas remembers being billed less than \$150. How many hours was Jonas' copier worked on?

Solution

1. **Familarize.** Suppose the copier was worked on for 4 hours. The cost would be \$65 + 4(\$45), or \$245. A bill of \$150 shows that the copier was worked on for less than 4 hours. Let h = the number of hours.

2. **Translate.**

Rewording:	Initial fee	plus	hours	is	less than	150
	↓	↓	↓		↓	↓
Translating:	65	$+$	$45h$		$<$	150

Copyright © 2019, 2015, 2011 Pearson Education, Inc.

Introductory Algebra 13th edition Bittinger Solutions Manual

Example continued

3. **Carry out.**

$$65 + 45h < 150$$

$$45h < 85$$

$$h < \frac{85}{45}$$

$$h < 1\frac{8}{9}$$

Copyright © 2019, 2015, 2011 Pearson Education, Inc.

Introductory Algebra 13th edition Bittinger Solutions Manual

Example continued

4. **Check**. Since the time represents hours, we round down to the whole hour. If the copier was worked on for one hour, the cost would be $110, and if worked on for two hours the cost would exceed $150.

5. **State.** Jonas' copier was worked on for less than two hours.

Copyright © 2019, 2015, 2011 Pearson Education, Inc.

Introductory Algebra 13th edition Bittinger Solutions Manual

Average or mean

To find the **average** or **mean** of a set of numbers, add the numbers and then divide by the number of addends.

Copyright © 2019, 2015, 2011 Pearson Education, Inc.

Introductory Algebra 13th edition Bittinger Solutions Manual

Example

Samantha has test grades of 86, 88, and 78 on her first three math tests. If she wants an average of at least 80 after the fourth test, what possible scores can she earn on the fourth test?

Solution

1. **Familarize.** Suppose she earned an 85 on her fourth test. Her test average would be

$$\frac{86+88+78+85}{4}=84.25$$

This shows she could score an 85. Let's let x represent the fourth test score.

Copyright © 2019, 2015, 2011 Pearson Education, Inc.

Introductory Algebra 13th edition Bittinger Solutions Manual

Example continued

2. **Translate.**

Rewording: $\underbrace{\text{Average test scores}}_{\downarrow}$ should be $\underbrace{\text{at least}}_{\downarrow}$ $\underbrace{80}_{\downarrow}$

Translating: $\dfrac{86+88+78+x}{4} \geq 80$

3. **Carry out.**

$$\frac{86+88+78+x}{4} \geq 80$$

$$4\left(\frac{86+88+78+x}{4}\right) \geq 80 \cdot 4$$

$$252 + x \geq 320$$

$$x \geq 68$$

Copyright © 2019, 2015, 2011 Pearson Education, Inc.

Introductory Algebra 13th edition Bittinger Solutions Manual

Example continued

4. **Check.**

As a partial check, we show that Samantha can earn a 68 on the fourth test and average 80 for the four tests.

$$\frac{86+88+78+68}{4}=\frac{320}{4}=80.$$

5. **State.**

Samantha's test average will not drop below 80 if she earns at least a 68 on the fourth test.

Copyright © 2019, 2015, 2011 Pearson Education, Inc.

Introductory Algebra 13th edition Bittinger Solutions Manual