College Algebra 4th edition Ratti Test Bank

SKU: 9780134696485-TEST-BANK

College Algebra 4th edition Ratti Test Bank

1) Give the coordinates of the points on the following graph.

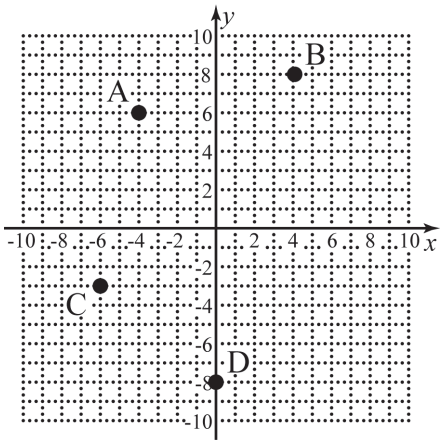

1) _____

2) Determine the a) domain and b) range of the function graphed below.

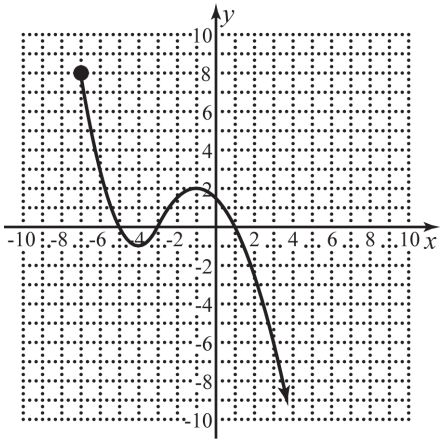

2) _____

3) Find the distance and midpoint between $(-4,3)$ and $(10,-11)$. 3) _____

4) Write the equation of the circle centered at $(-5,7)$ with a radius of 9. 4) _____

5) Find the equation of the line passing through $(5,-3)$ with slope -2. Write the solution in slope-intercept form. 5) _____

6) Find the x- and y-intercepts of $y = x^2 - x - 20$. 6) _____

7) Determine the equation of the circle in standard form described by $x^2 - 4x + y^2 + 6y - 36 = 0$. 7) _____

8) Find the equation of the line passing through $(-3,7)$ and $(1,5)$. Write the solution in slope-intercept form. 8) _____

9) Find the domain of $f(x) = \sqrt{x^2 + 2x - 15}$. Write the answer using interval notation. 9) _____

Copyright © 2019 Pearson Education, Inc.

College Algebra 4th edition Ratti Test Bank

10) Find $f^{-1}(x)$ for $f(x)=4x-11$. 10) _____

11) Find the equation of the line parallel to $-3x+2y=-5$ passing through $(3,-2)$. Write the solution in slope-intercept form. 11) _____

12) Given the following graph determine: a) where is the graph increasing, b) where is the graph decreasing, and c) where is the graph constant.

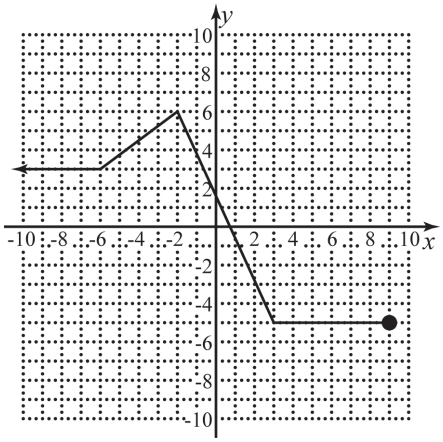

12) _____

13) Determine which symmetries the graph of $x^4+3y^2=4$ possesses. 13) _____

14) For $f(x)=-2(x-3)^2+9$, list the transformations to the basic graph and graph the function.

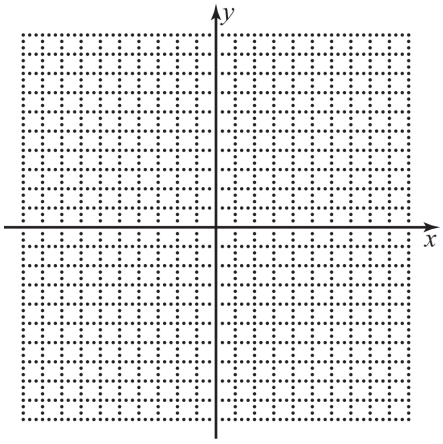

14) _____

15) Find the linear regression equation for the following data. Round the constants to two decimal places.

x	2	8	16	18	24	26
y	4	13	18	27	31	34

15) _____

16) Given $f(x)=2x^2-5$ and $g(x)=\sqrt{x-5}$, find $(f\circ g)(x)$, and determine its domain. 16) _____

Copyright © 2019 Pearson Education, Inc.

College Algebra 4th edition Ratti Test Bank

17) Write the formula for the graph of $f(x)$ below.

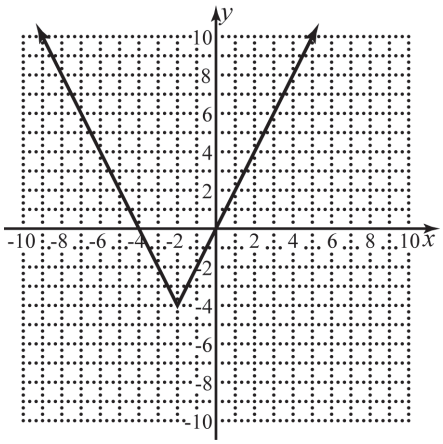

17) _____

18) Find the average rate of change of $f(x) = x^2 + 9$ as x changes from $a = -1$ to $b = 5$. 18) _____

19) Graph $f(x) = \begin{cases} -x-1 & \text{if} \quad x \le 3 \\ 5 & \text{if} \quad x > 3 \end{cases}$. Find the value of $f(-3)$ $f(3)$, and $f(6)$.

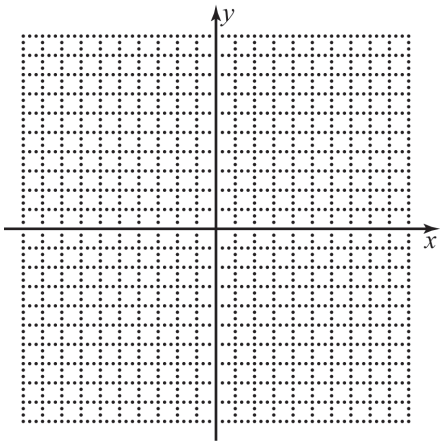

19) _____

20) Find $\frac{f(x+h)-f(x)}{h}$ for $f(x) = x^2 + 2x$. 20) _____

21) A company that produces toy cars has a monthly a monthly cost of 1500 dollars and a marginal cost of 3 dollars per toy car. The company makes 8 dollars per toy car in revenue.

a) Find the function, $C(x)$, that represents the cost of producing x toy cars.

b) Find the function, $R(x)$, that represents the revenue from selling x toy cars.

c) Find the function, $P(x)$, that represents the profit from selling x toy cars.

d) What would the profit be from selling 2500 toy cars? 21) _____

Copyright © 2019 Pearson Education, Inc.

College Algebra 4th edition Ratti Test Bank

1) Give the coordinates of the points on the following graph.

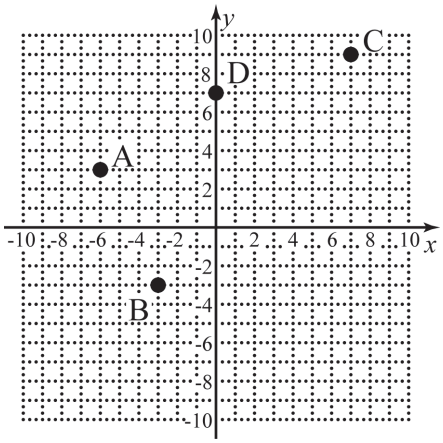

1) _____

2) Determine the a) domain and b) range of the function graphed below.

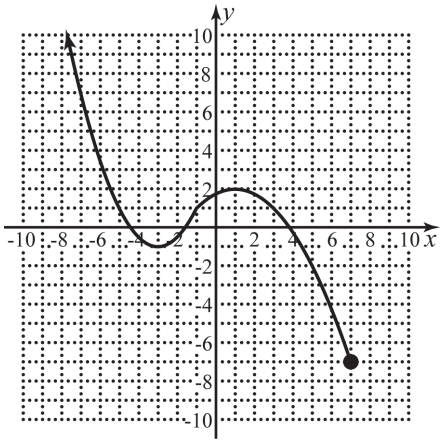

2) _____

3) Find the distance and midpoint between $(5,-7)$ and $(1,1)$. 3) _____

4) Write the equation of the circle centered at $(7,-9)$ with a radius of 6. 4) _____

5) Find the equation of the line passing through $(-4,3)$ with slope 5. Write the solution in slope-intercept form. 5) _____

6) Find the x- and y-intercepts of $y=\sqrt{5x+100}$. 6) _____

7) Determine the equation of the circle in standard form described by $x^2+10x+y^2-8y+5=0$. 7) _____

8) Find the equation of the line passing through $(4,1)$ and $(-1,-3)$. Write the solution in slope-intercept form. 8) _____

9) Find the domain of $f(x)=\sqrt{x^2+4x-12}$. Write the answer using interval notation. 9) _____

Copyright © 2019 Pearson Education, Inc.

College Algebra 4th edition Ratti Test Bank

10) Find $f^{-1}(x)$ for $f(x)=3x-8$. 10) _____

11) Find the equation of the line perpendicular to $2x+3y=7$ passing through $(4,7)$. Write the solution in slope-intercept form. 11) _____

12) Given the following graph determine: a) where is the graph increasing, b) where is the graph decreasing, and c) where is the graph constant.

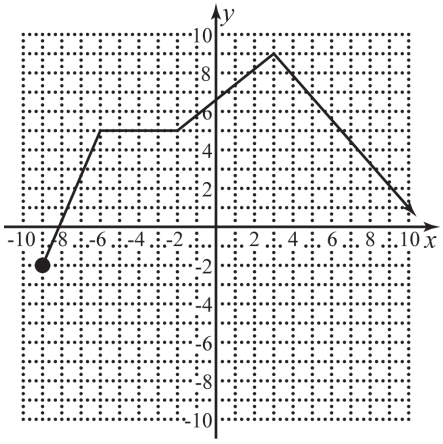

12) _____

13) Determine which symmetries the graph of $y=5x^2-x^4$ possesses. 13) _____

14) For $f(x)=\frac{1}{2}(x+5)^2-4$, list the transformations to the basic graph and graph the function.

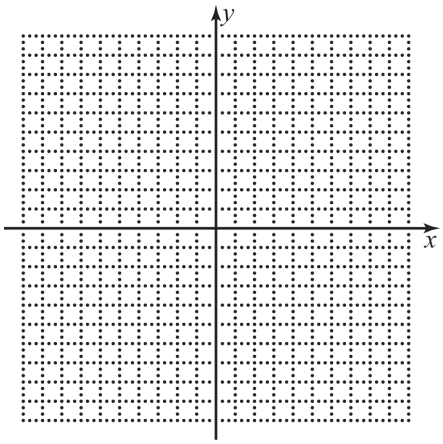

14) _____

15) Find the linear regression equation for the following data. Round the constants to two decimal places.

x	3	5	13	17	26	37
y	9	7	22	18	30	45

15) _____

16) Given $f(x)=\dfrac{x^2+1}{x^2+7}$ and $g(x)=\sqrt{x+7}$, find $(f\circ g)(x)$, and determine its domain. 16) _____

Copyright © 2019 Pearson Education, Inc.

College Algebra 4th edition Ratti Test Bank

17) Write the formula for the graph of $f(x)$ below.

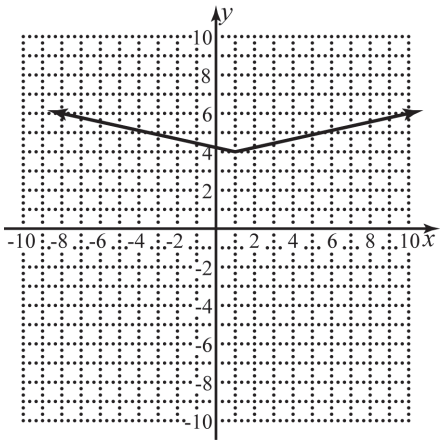

17) _____

18) Find the average rate of change of $f(x) = -3x^3 - 14$ as x changes from $a = -1$ to $b = 2$. 18) _____

19) Graph $f(x) = \begin{cases} -x+3 & \text{if} \quad x > -2 \\ -3 & \text{if} \quad x \le -2 \end{cases}$. Find the values of $f(-4)$, $f(-2)$, and $f(2)$.

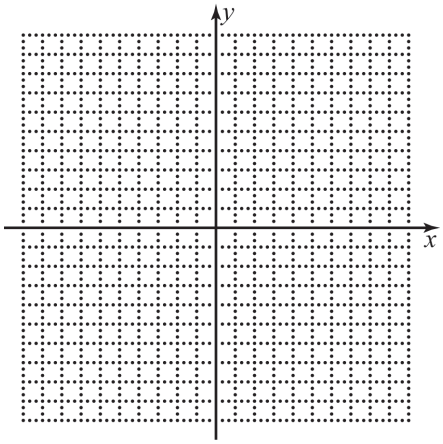

19) _____

20) Find $\frac{f(x+h)-f(x)}{h}$ for $f(x) = 3x - 2x^2$. 20) _____

21) A company that produces toy cars has a monthly a monthly cost of 2000 dollars and a marginal cost of 8 dollars per toy car. The company makes 15 dollars per toy car in revenue.

a) Find the function, $C(x)$, that represents the cost of producing x toy cars.

b) Find the function, $R(x)$, that represents the revenue from selling x toy cars.

c) Find the function, $P(x)$, that represents the profit from selling x toy cars.

d) What would the profit be from selling 3250 toy cars? 21) _____

Copyright © 2019 Pearson Education, Inc.

College Algebra 4th edition Ratti Test Bank

1) Give the coordinates of the points on the following graph.

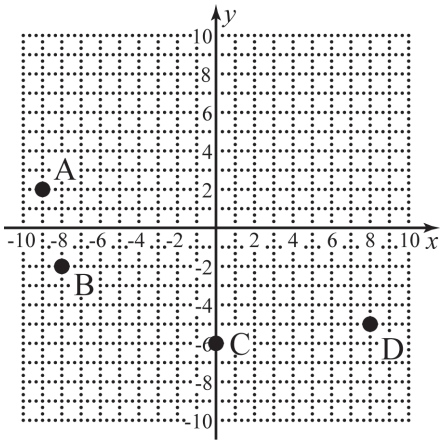

1) _____

2) Determine the a) domain and b) range of the function graphed below.

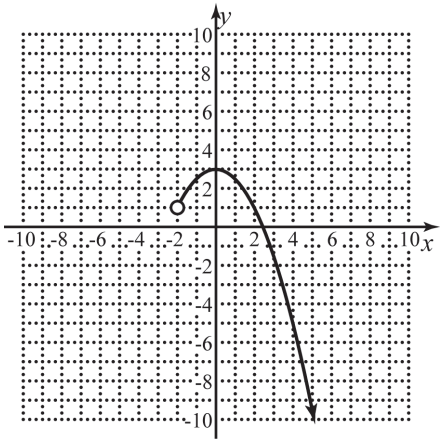

2) _____

3) Find the distance and midpoint between $(8,5)$ and $(4,-9)$. 3) _____

4) Write the equation of the circle centered at $(-2,9)$ with a radius of 3. 4) _____

5) Find the equation of the line passing through $(1,-2)$ with slope -3. Write the solution in slope-intercept form. 5) _____

6) Find the x- and y-intercepts of $y=\sqrt[5]{2x-32}$. 6) _____

7) Determine the equation of the circle in standard form described by $x^2-6x+y^2+10y+9=0$. 7) _____

8) Find the equation of the line passing through $(-2,1)$ and $(4,-4)$. Write the solution in slope-intercept form. 8) _____

9) Find the domain of $f(x)=\sqrt{x^2+2x-24}$. Write the answer using interval notation. 9) _____

Copyright © 2019 Pearson Education, Inc.

College Algebra 4th edition Ratti Test Bank

10) Find $f^{-1}(x)$ for $f(x)=8x-5$. 10) _____

11) Find the equation of the line parallel to $5x-3y=4$ passing through $(-10,3)$. Write the solution in slope-intercept form. 11) _____

12) Given the following graph determine: a) where is the graph increasing, b) where is the graph decreasing, and c) where is the graph constant.

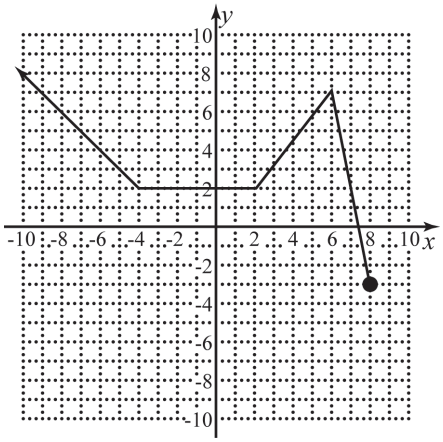

12) _____

13) Determine which symmetries the graph of $x^3y^2=4-8x$ possesses. 13) _____

14) For $f(x)=3(x+2)^2-9$, list the transformations to the basic graph and graph the function.

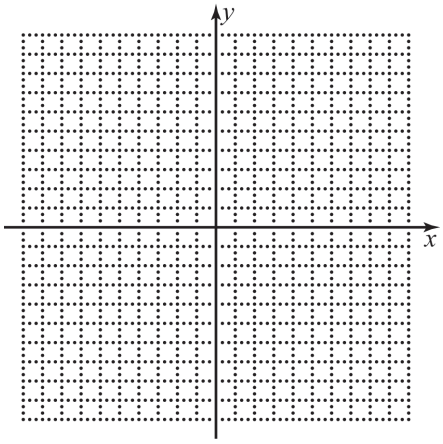

14) _____

15) Find the linear regression equation for the following data. Round the constants to two decimal places.

x	8	10	15	16	22	35
y	11	14	19	19	25	41

15) _____

16) Given $f(x)=3x^2+2$ and $g(x)=\sqrt{7-x}$, find $(f\circ g)(x)$, and determine its domain. 16) _____

Copyright © 2019 Pearson Education, Inc.

College Algebra 4th edition Ratti Test Bank

17) Write the formula for the graph of $f(x)$ below.

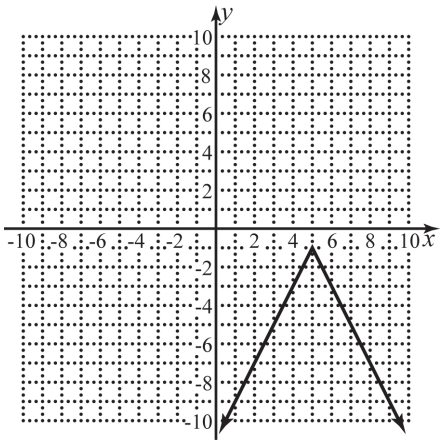

17) _____

18) Find the average rate of change of $f(x)=11-5x^2$ as x changes from $a=-3$ to $b=5$. 18) _____

19) Graph $f(x)=\begin{cases} 3 & \text{if} \quad x>4 \\ -x+1 & \text{if} \quad x\le 4 \end{cases}$. Find the values of $f(-4)$, $f(4)$, and $f(8)$.

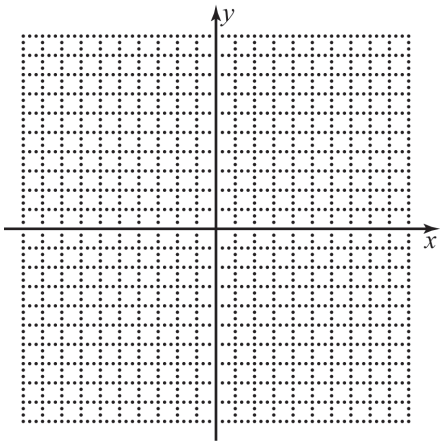

19) _____

20) Find $\frac{f(x+h)-f(x)}{h}$ for $f(x)=4x^2-7x$. 20) _____

21) A company that produces toy cars has a monthly a monthly cost of 1800 dollars and a marginal cost of 5 dollars per toy car. The company makes 13 dollars per toy car in revenue.

a) Find the function, $C(x)$, that represents the cost of producing x toy cars.

b) Find the function, $R(x)$, that represents the revenue from selling x toy cars.

c) Find the function, $P(x)$, that represents the profit from selling x toy cars.

d) What would the profit be from selling 1500 toy cars? 21) _____

Copyright © 2019 Pearson Education, Inc.

College Algebra 4th edition Ratti Test Bank

1) Give the coordinates of the points on the following graph.

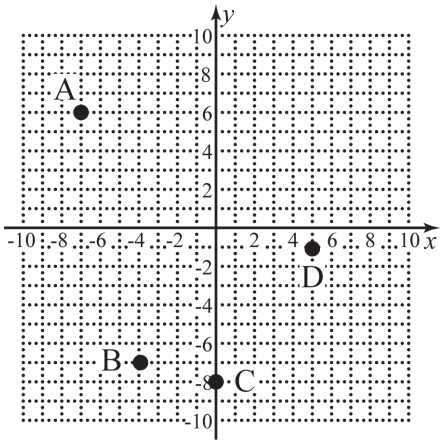

1) _____

2) Determine the a) domain and b) range of the function graphed below.

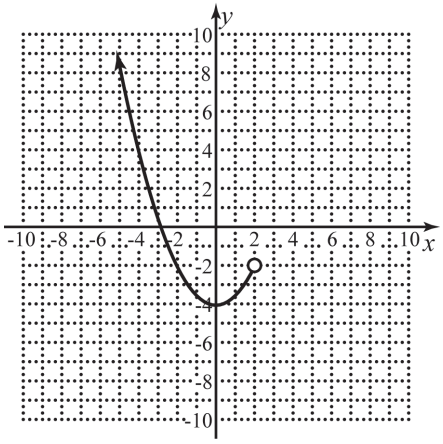

2) _____

3) Find the distance and midpoint between $(-6,1)$ and $(4,-9)$. 3) _____

4) Write the equation of the circle centered at $(-7,8)$ with a radius of 11. 4) _____

5) Find the equation of the line passing through $(-2,3)$ with slope 4. Write the solution in slope-intercept form. 5) _____

6) Find the x- and y-intercepts of $y = x^3 + 27$. 6) _____

7) Determine the equation of the circle in standard form described by $x^2 - 14x + y^2 + 8y + 56 = 0$. 7) _____

8) Find the equation of the line passing through $(-1,-2)$ and $(4,2)$. Write the solution in slope-intercept form. 8) _____

9) Find the domain of $f(x) = \sqrt{x^2 - 3x - 10}$. Write the answer using interval notation. 9) _____

Copyright © 2019 Pearson Education, Inc.

College Algebra 4th edition Ratti Test Bank

10) Find $f^{-1}(x)$ for $f(x)=11-5x$. 10) _____

11) Find the equation of the line perpendicular to $-4x-3y=5$ passing through $(-8,5)$. Write the solution in slope-intercept form. 11) _____

12) Given the following graph determine: a) where is the graph increasing, b) where is the graph decreasing, and c) where is the graph constant.

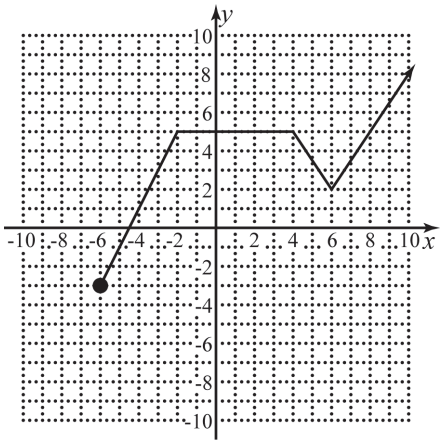

12) _____

13) Determine which symmetries the graph of $y=2x^5+7x^3$ possesses. 13) _____

14) For $f(x)=-2(x+5)^2+6$, list the transformations to the basic graph and graph the function.

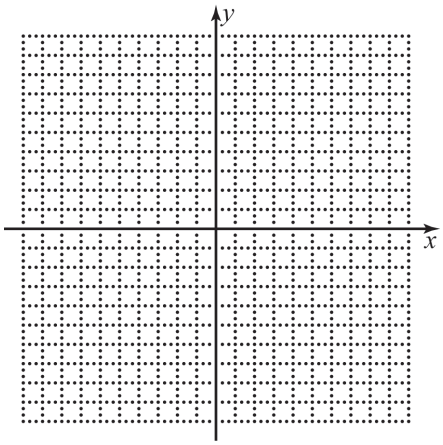

14) _____

15) Find the linear regression equation for the following data. Round the constants to two decimal places.

x	10	18	22	29	30	39
y	19	22	28	30	38	45

15) _____

16) Given $f(x)=\dfrac{x^2}{x^2+3}$ and $g(x)=\sqrt{x-2}$, find $(f\circ g)(x)$, and determine its domain. 16) _____

Copyright © 2019 Pearson Education, Inc.

College Algebra 4th edition Ratti Test Bank

17) Write the formula for the graph of $f(x)$ below.

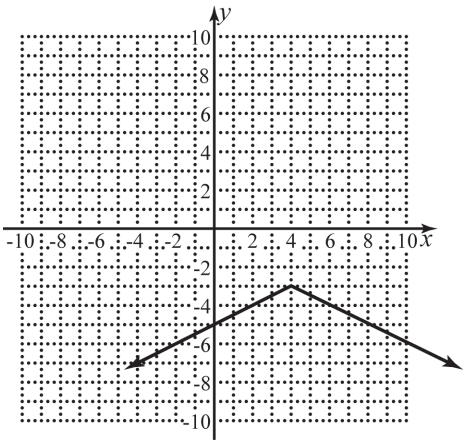

17) _____

18) Find the average rate of change of $f(x) = -2x^2 - 7$ as x changes from $a = -5$ to $b = 4$. 18) _____

19) Graph $f(x) = \begin{cases} -x+3 & \text{if} \quad x < 1 \\ -5 & \text{if} \quad x \geq 1 \end{cases}$. Find the values of $f(-1)$, $f(1)$, and $f(5)$.

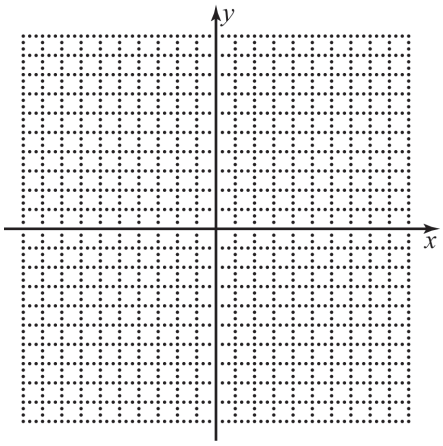

19) _____

20) Find $\frac{f(x+h)-f(x)}{h}$ for $f(x) = x^3 + x$. 20) _____

21) A company that produces toy cars has a monthly a monthly cost of 2400 dollars and a marginal cost of 10 dollars per toy car. The company makes 25 dollars per toy car in revenue.

a) Find the function, $C(x)$, that represents the cost of producing x toy cars.

b) Find the function, $R(x)$, that represents the revenue from selling x toy cars.

c) Find the function, $P(x)$, that represents the profit from selling x toy cars.

d) What would the profit be from selling 600 toy cars? 21) _____

Copyright © 2019 Pearson Education, Inc.

College Algebra 4th edition Ratti Test Bank

In exercises 1–2, refer to the graph to the right.

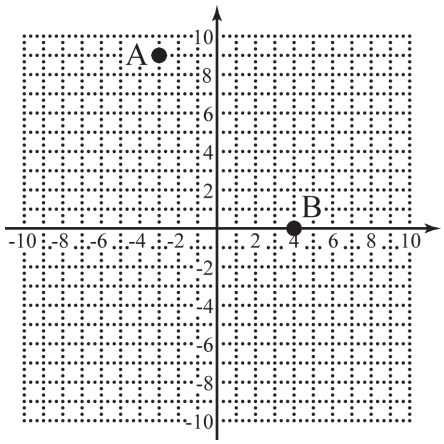

1) What are the coordinates of point A? 1) _____

a) $(-3,9)$ b) $(3,-9)$

c) $(9,-3)$ d) $(-9,3)$

2) What are the coordinates of point B? 2) _____

a) $(-4,0)$ b) $(4,0)$

c) $(0,4)$ d) $(0,-4)$

In exercises 3–4, refer to the graph to the right.

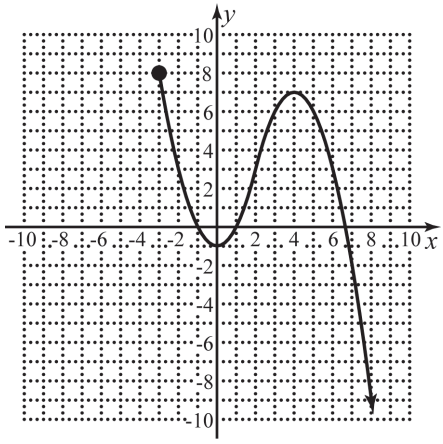

3) Determine the domain of the function. 3) _____

a) $(-3,\infty)$ b) $[-3,\infty)$

c) $(-\infty,8)$ d) $(-\infty,8]$

4) Determine the range of the function. 4) _____

a) $(-3,\infty)$ b) $[-3,\infty)$

c) $(-\infty,8)$ d) $(-\infty,8]$

In exercises 5–6 use the points $(-2,3)$ and $(6,-5)$.

5) Find the distance between the points. 5) _____

a) $4\sqrt{5}$ b) 4 c) $2\sqrt{13}$ d) $8\sqrt{2}$

6) Find the midpoint between the points. 6) _____

a) $(4,-4)$ b) $(2,-1)$ c) $(-4,4)$ d) $(-2,1)$

7) Write the equation of the circle centered at $(7,-1)$ with a radius of 2. 7) _____

a) $(x+7)^2+(y-1)^2=4$ b) $(x-7)^2+(y+1)^2=4$

c) $(x+7)^2+(y-1)^2=2$ d) $(x-7)^2+(y+1)^2=2$

8) Find the equation of the line passing through $(-1,4)$ with slope 3. 8) _____

a) $y=3x+7$ b) $y=3x+4$ c) $y=3x-1$ d) $y=3x-13$

Copyright © 2019 Pearson Education, Inc.

College Algebra 4th edition Ratti Test Bank

9) Find the coordinates of the x- and y-intercepts of $y = x^2 - x - 42$. 9) _____

a) $(42,0),(0,-6),(0,7)$ b) $(42,0),(0,-7),(0,6)$
c) $(0,-42),(-7,0),(6,0)$ d) $(0,-42),(-6,0),(7,0)$

10) Determine the equation of the circle described by $x^2 - 8x + y^2 + 10y - 59 = 0$. 10) _____

a) $(x-8)^2 + (y+10)^2 = 59$ b) $(x-4)^2 + (y+5)^2 = 41$
c) $(x-4)^2 + (y+5)^2 = 100$ d) $(x-4)^2 + (y+5)^2 = 59$

11) Find the equation of the line passing through $(-4,3)$ and $(2,4)$. 11) _____

a) $y = 6x + 27$ b) $y = -6x - 21$ c) $y = \frac{1}{6}x + \frac{11}{3}$ d) $y = -\frac{1}{6}x + \frac{7}{3}$

12) Find the domain of $f(x) = \sqrt{x^2 + 5x - 14}$. 12) _____

a) $[-7,2]$ b) $[-2,7]$
c) $(-\infty,-7]\cup[2,\infty)$ d) $(-\infty,-2]\cup[7,\infty)$

13) Given $f(x) = \sqrt[3]{x-27}$, find $f^{-1}(x)$. 13) _____

a) $f^{-1}(x) = \sqrt[3]{x+27}$ b) $f^{-1}(x) = \dfrac{1}{\sqrt[3]{x-27}}$
c) $f^{-1}(x) = x^3 + 27$ d) $f^{-1}(x) = -\sqrt[3]{x-27}$

14) Find the equation of the line parallel to $2x + 5y = 13$ passing through $(5,-3)$. 14) _____

a) $y = \frac{5}{2}x - \frac{31}{2}$ b) $y = \frac{2}{5}x - 5$ c) $y = -\frac{5}{2}x + \frac{19}{2}$ d) $y = -\frac{2}{5}x - 1$

In exercises 15–17, refer to the graph to the right.

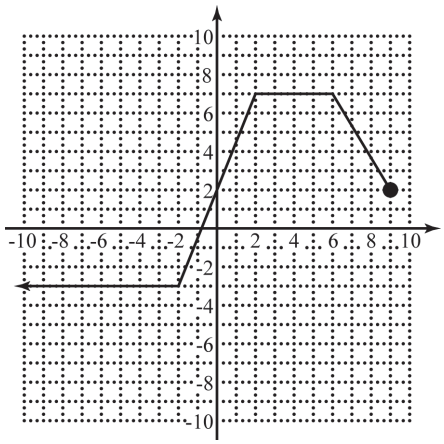

15) When is the graph increasing? 15) _____

a) $(-2,2)$ b) $(6,9)$
c) $(-\infty,-2)\cup(2,6)$ d) never

16) When is the graph decreasing? 16) _____

a) $(-2,2)$ b) $(6,9)$
c) $(-\infty,-2)\cup(2,6)$ d) never

17) When is the graph constant? 17) _____

a) $(-2,2)$ b) $(6,9)$
c) $(-\infty,-2)\cup(2,6)$ d) never

18) Determine which symmetries the graph of $xy^2 + x^3 = xy^4$ possesses. 18) _____

a) x-axis b) y-axis c) origin d) all

Copyright © 2019 Pearson Education, Inc.

College Algebra 4th edition Ratti Test Bank

19) Graph $f(x) = -2(x-3)^2 + 2$. 19) _____

a)
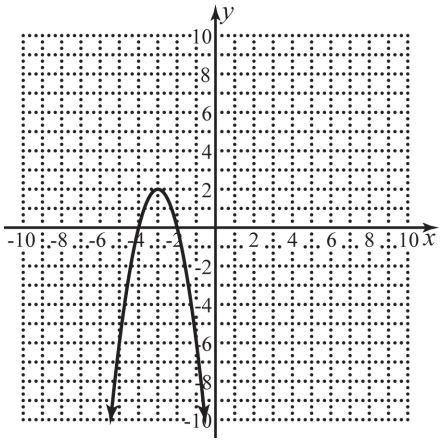

b)
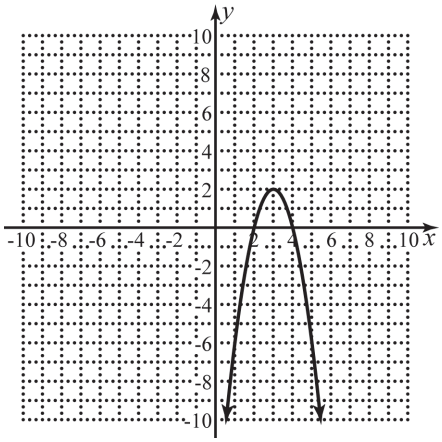

c)
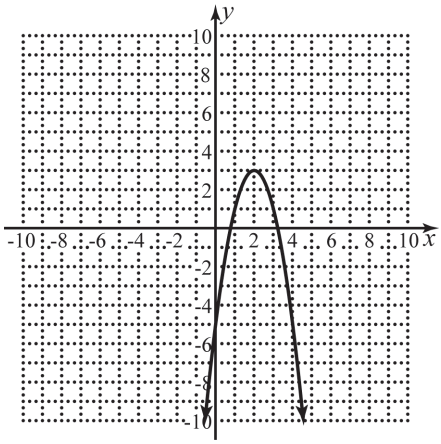

d)
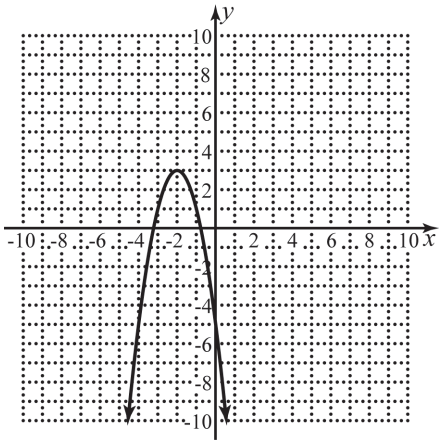

20) Which of the following is not a transformation of the basic function in $g(x) = \frac{1}{2}(x+3)^2 - 1$? 20) _____

a) vertical shift of 1 down
b) vertical reflection
c) vertical stretch of $\frac{1}{2}$
d) horizontal shift of 3 to the left

21) Find the linear regression equation for the following data. 21) _____

x	19	23	29	30	37	38
y	24	32	30	38	44	41

a) $y = 0.92x - 2.59$
b) $y = 8.00x + 0.91$
c) $y = -2.59x + 0.92$
d) $y = 0.91x + 8.00$

22) Given $f(x) = 7x^2 + 4$ and $g(x) = \sqrt{8-x}$, find $(f \circ g)(x)$ and determine its domain. 22) _____

a) $\sqrt{4-7x^2}$; $(-\infty, \infty)$
b) $\sqrt{4-7x^2}$; $(-\infty, 8]$
c) $60 - 7x$; $(-\infty, 8]$
d) $60 - 7x$; $[8, \infty)$

Copyright © 2019 Pearson Education, Inc.

College Algebra 4th edition Ratti Test Bank

23) Write the formula for the function graphed to the right. 23) _____

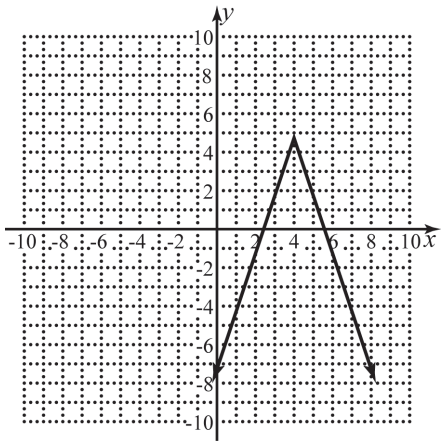

a) $f(x) = -3|x+4|+5$

b) $f(x) = \frac{1}{3}|x-4|+5$

c) $f(x) = -2|x-4|+5$

d) $f(x) = -3|x-4|+5$

24) Find the average rate of change of $f(x) = x^2 - 2x$ as x changes from $a = -4$ to $b = 3$. 24) _____

a) 27/7 b) −5/7 c) −3 d) 21

In exercises 25–27, use $f(x) = \begin{cases} -x-2 & \text{if } x \le 4 \\ 3 & \text{if } x > 4 \end{cases}$.

25) Graph $f(x)$. 25) _____

a)

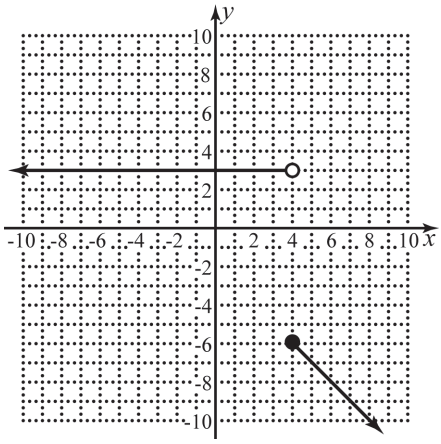

b)

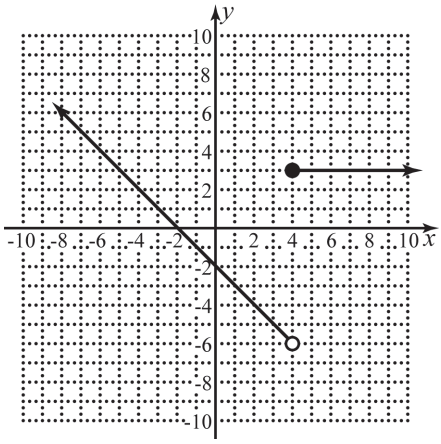

c)

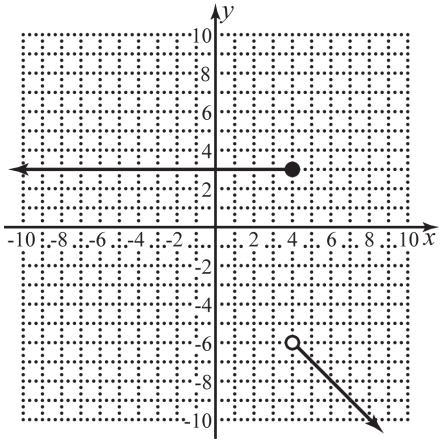

d)

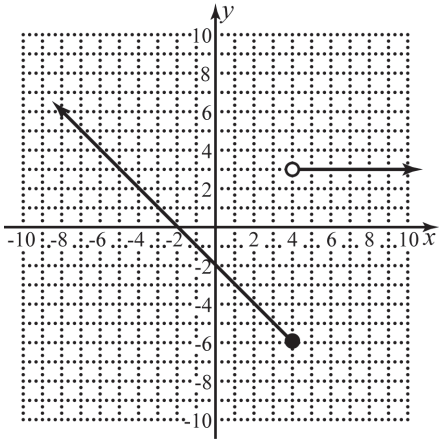

Copyright © 2019 Pearson Education, Inc.

College Algebra 4th edition Ratti Test Bank

26) Determine the value of $f(4)$. 26) _____

a) 3 b) -6 c) 2 d) -1

27) Determine the value of $f(-7)$. 27) _____

a) 5 b) -9 c) 3 d) -5

28) Find $\frac{f(x+h)-f(x)}{h}$ for $f(x)=x^3-x$. 28) _____

a) h^2-1 b) $h^2+3hx+3x^2-1$

c) $h^2+3hx+3x^2+1$ d) $3x^2-1$

A company that produces toy cars has a monthly a monthly cost of 2300 dollars and a marginal cost of 4 dollars per toy car. The company makes 11 dollars per toy car in revenue. With this information, answer exercises 29–32.

29) Find the function, $C(x)$, that represents the total cost of producing x toy cars. 29) _____

a) $C(x)=4x$ b) $C(x)=11x+2300$

c) $C(x)=4x+2300$ d) $C(x)=2300x+4$

30) Find the function, $R(x)$, that represents the revenue from selling x toy cars. 30) _____

a) $R(x)=11x-2300$ b) $R(x)=11x$

c) $R(x)=4x$ d) $R(x)=7x$

31) Find the function, $P(x)$, that represents the profit from selling x toy cars. 31) _____

a) $P(x)=11x-2300$ b) $P(x)=7x-2300$

c) $P(x)=7x$ d) $P(x)=2300-7x$

32) What would the profit be from selling 1150 toy cars? 32) _____

a) \$8050 b) $-$\$5750 c) \$10,350 d) \$5750

Copyright © 2019 Pearson Education, Inc.

College Algebra 4th edition Ratti Test Bank

In exercises 1–2, refer to the graph to the right.

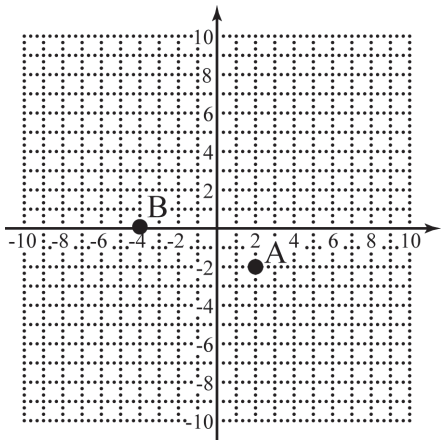

1) What are the coordinates of point A? 1) _____

a) $(2,-2)$ b) $(-2,2)$
c) $(-2,-2)$ d) $(2,2)$

2) What are the coordinates of point B? 2) _____

a) $(-4,0)$ b) $(4,0)$
c) $(0,4)$ d) $(0,-4)$

In exercises 3–4, refer to the graph to the right.

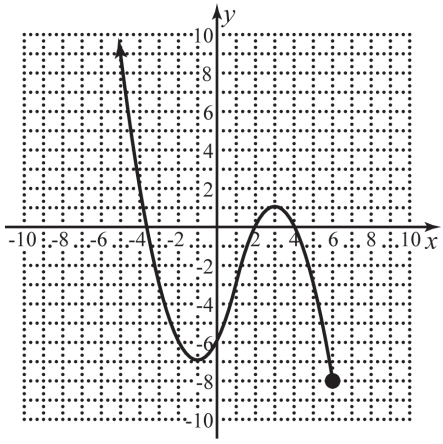

3) Determine the domain of the function. 3) _____

a) $(-\infty,6]$ b) $(-\infty,6)$
c) $[-8,\infty)$ d) $(-8,\infty)$

4) Determine the range of the function. 4) _____

a) $(-\infty,6]$ b) $(-\infty,6)$
c) $[-8,\infty)$ d) $(-8,\infty)$

In exercises 5–6, use the points $(4,-4)$ and $(-8,10)$.

5) Find the distance between the points. 5) _____

a) $2\sqrt{85}$ b) $2\sqrt{13}$ c) $\sqrt{26}$ d) $2\sqrt{10}$

6) Find the midpoint between the points. 6) _____

a) $(-2,3)$ b) $(6,-7)$ c) $(-7,6)$ d) $(2,-3)$

7) Write the equation of the circle centered at $(-5,2)$ with a radius of 5. 7) _____

a) $(x-5)^2+(y+2)^2=5$ b) $(x-5)^2+(y+2)^2=25$
c) $(x+5)^2+(y-2)^2=5$ d) $(x+5)^2+(y-2)^2=25$

8) Find the equation of the line passing through $(-5,4)$ with slope -3. 8) _____

a) $y=-3x+17$ b) $y=-3x-1$ c) $y=-3x+4$ d) $y=-3x-11$

Copyright © 2019 Pearson Education, Inc.

College Algebra 4th edition Ratti Test Bank

9) Find the coordinates of the x- and y-intercepts of $y=\sqrt[3]{9x+216}$. 9) _____

a) $(24,0),(0,6)$ b) $(-24,0),(0,6)$ c) $(0,24),(6,0)$ d) $(0,-24),(6,0)$

10) Determine the equation of the circle described by $x^2+6x+y^2-8y-56=0$. 10) _____

a) $(x+6)^2+(y-8)^2=56$ b) $(x+3)^2+(y-4)^2=81$

c) $(x+3)^2+(y-4)^2=25$ d) $(x+3)^2+(y-4)^2=56$

11) Find the equation of the line passing through $(-3,-2)$ and $(2,5)$. 11) _____

a) $y=-\frac{7}{5}x+\frac{39}{5}$ b) $y=\frac{7}{5}x+\frac{11}{5}$ c) $y=-\frac{5}{7}x+\frac{45}{7}$ d) $y=\frac{5}{7}x-\frac{25}{7}$

12) Find the domain of $f(x)=\sqrt{x^2-5x-24}$. Write your answer using interval notation. 12) _____

a) $[-8,3]$ b) $[-3,8]$

c) $(-\infty,-8]\cup[3,\infty)$ d) $(-\infty,-3]\cup[8,\infty)$

13) Given $f(x)=\dfrac{4}{x-5}$, find $f^{-1}(x)$. 13) _____

a) $f^{-1}(x)=\dfrac{5x+4}{x}$ b) $f^{-1}(x)=\dfrac{x-5}{4}$

c) $f^{-1}(x)=-\dfrac{4}{x-5}$ d) $f^{-1}(x)=\dfrac{4}{x+5}$

14) Find the equation of the line perpendicular to $-4x+3y=11$ passing through $(6,5)$. 14) _____

a) $y=-\frac{3}{4}x+\frac{19}{2}$ b) $y=\frac{3}{4}x+\frac{1}{2}$ c) $y=-\frac{1}{4}x+\frac{13}{2}$ d) $y=\frac{1}{4}x+\frac{7}{2}$

In exercises 15–17, refer to the graph to the right.

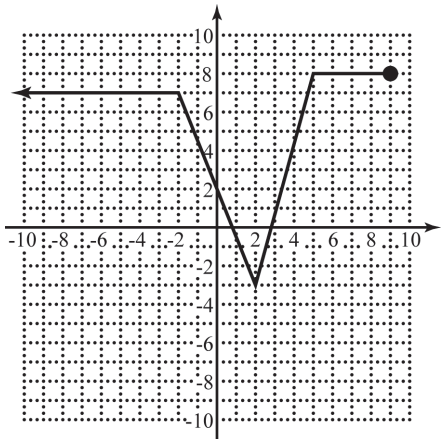

15) When is the graph increasing? 15) _____

a) $(-\infty,-2)\cup(5,9)$ b) $(2,5)$

c) $(-2,2)$ d) never

16) When is the graph decreasing? 16) _____

a) $(-\infty,-2)\cup(5,9)$ b) $(2,5)$

c) $(-2,2)$ d) never

17) When is the graph constant? 17) _____

a) $(-\infty,-2)\cup(5,9)$ b) $(2,5)$

c) $(-2,2)$ d) never

18) Determine which symmetries the graph of $x^2y^2-y^4=x$ possesses. 18) _____

a) x-axis b) y-axis c) origin d) all

Copyright © 2019 Pearson Education, Inc.

College Algebra 4th edition Ratti Test Bank

19) Graph $f(x)=\frac{1}{2}(x+3)^2-5$. 19) _____

a)
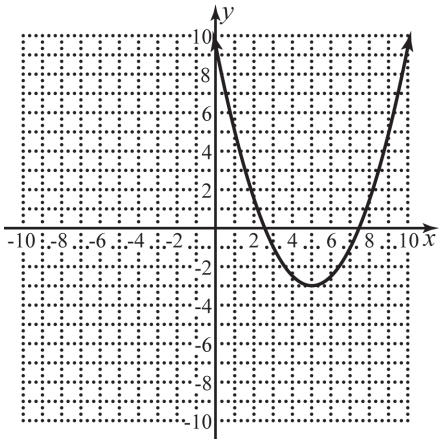

b)
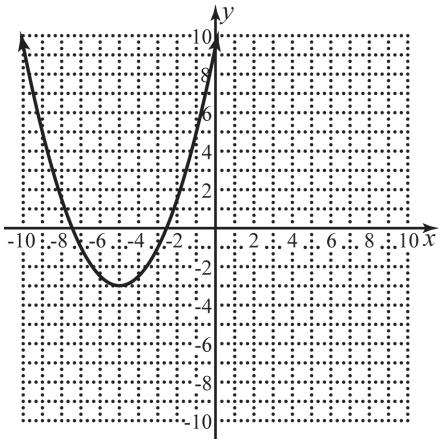

c)
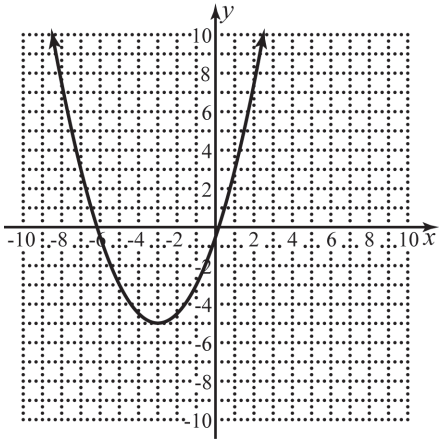

d)
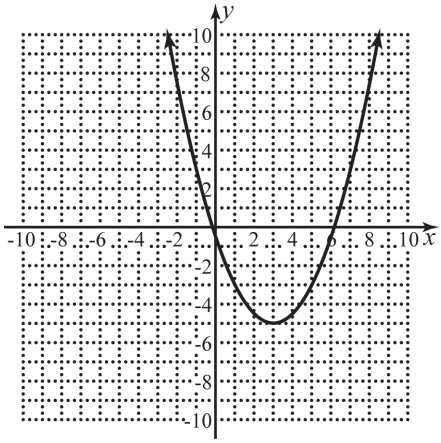

20) Which of the following is not a transformation of the basic function in $g(x)=-3(x-2)^2+7$? 20) _____

a) vertical stretch of $\frac{1}{3}$
b) vertical reflection
c) horizontal shift of 2 to the right
d) vertical shift of 7 up

21) Find the linear regression equation for the following data. 21) _____

x	10	14	16	17	25	35
y	16	23	22	20	32	39

a) $y=0.92x+7.48$
b) $y=-6.65x+1.03$
c) $y=7.48x+0.92$
d) $y=1.03x-6.65$

22) Given $f(x)=\dfrac{x^2-3}{x^2+2}$ and $g(x)=\sqrt{x+3}$, find $(f\circ g)(x)$ and determine its domain. 22) _____

a) $\sqrt{\dfrac{4x^2+3}{x^2+2}}$; $(-\infty,\infty)$
b) $\sqrt{\dfrac{4x^2+3}{x^2+2}}$; $[-3,\infty)$
c) $\dfrac{x}{x+5}$; $(-\infty,-3]$
d) $\dfrac{x}{x+5}$; $[-3,\infty)$

Copyright © 2019 Pearson Education, Inc.

College Algebra 4th edition Ratti Test Bank

23) Write the formula for the function graphed to the right. 23) _____

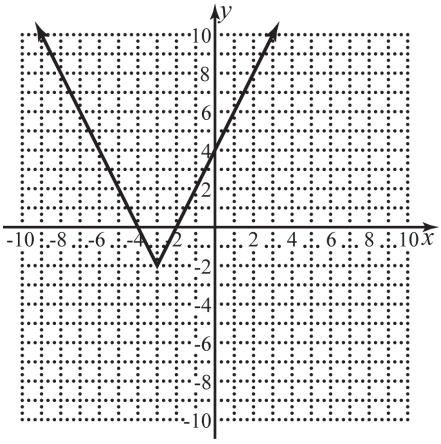

a) $f(x) = -2|x+3| - 2$

b) $f(x) = 2|x+3| - 2$

c) $f(x) = \frac{1}{2}|x+3| - 2$

d) $f(x) = 2|x-3| - 2$

24) Find the average rate of change of $f(x) = x^3 + 8x$ as x changes from $a = -2$ to $b = 1$. 24) _____

a) -33 b) $1/3$ c) -5 d) 11

In exercises 25–27, use $f(x) = \begin{cases} -x-1 & \text{if } x \ge 3 \\ 6 & \text{if } x < 3 \end{cases}$.

25) Graph $f(x)$. 25) _____

a)

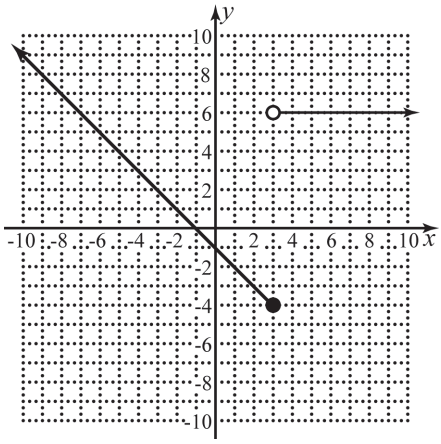

b)

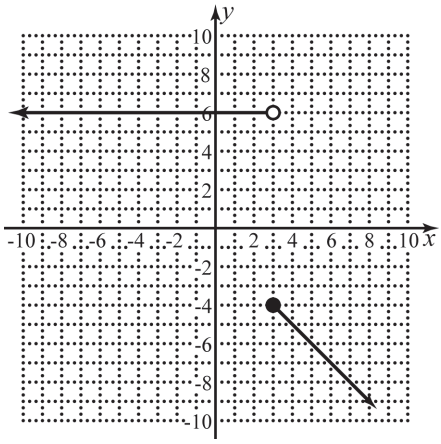

c)

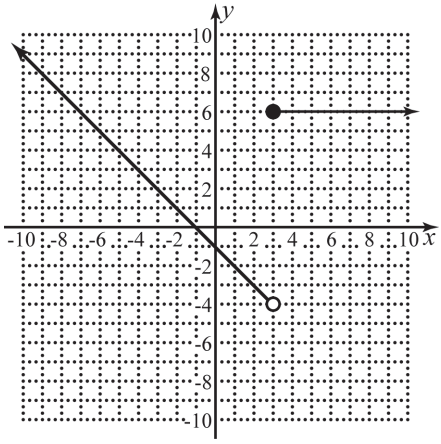

d)

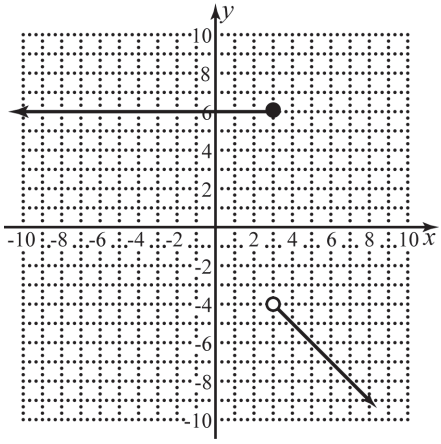

Copyright © 2019 Pearson Education, Inc.

College Algebra 4th edition Ratti Test Bank

26) Determine the value of $f(3)$. 26) _____

a) 6 b) -4 c) 2 d) -2

27) Determine the value of $f(8)$. 27) _____

a) -9 b) 7 c) 6 d) 2

28) Find $\frac{f(x+h)-f(x)}{h}$ for $f(x)=2x^2-3x$. 28) _____

a) $2h+3$ b) $4x-1$ c) $2h+4x-3$ d) $2h+4x+3$

A company that produces toy cars has a monthly a monthly cost of 3300 dollars and a marginal cost of 14 dollars per toy car. The company makes 32 dollars per toy car in revenue. With this information, answer exercises 29–32.

29) Find the function, $C(x)$, that represents the total cost of producing x toy cars. 29) _____

a) $C(x)=14x$ b) $C(x)=32x+3300$

c) $C(x)=3300x+14$ d) $C(x)=14x+3300$

30) Find the function, $R(x)$, that represents the revenue from selling x toy cars. 30) _____

a) $R(x)=32x-3300$ b) $R(x)=18x$

c) $R(x)=32x$ d) $R(x)=14x$

31) Find the function, $P(x)$, that represents the profit from selling x toy cars. 31) _____

a) $P(x)=32x-3300$ b) $P(x)=3300-18x$

c) $P(x)=18x-3300$ d) $P(x)=18x$

32) What would the profit be from selling 750 toy cars? 32) _____

a) \$10,200 b) \$20,700 c) \$13,500 d) $-$\$10,200

Copyright © 2019 Pearson Education, Inc.

College Algebra 4th edition Ratti Test Bank

Form A

1) A) $(-4,6)$; B) $(4,8)$; C) $(-6,-3)$; D) $(0,-8)$

2) a) $[-7,\infty)$ b) $(-\infty,8]$

3) Distance: $14\sqrt{2}$; Midpoint: $(3,-4)$

4) $(x+5)^2+(y-7)^2=9^2$ or
$(x+5)^2+(y-7)^2=81$

5) $y=-2x+7$

6) $(-4,0),(5,0),(0,-20)$

7) $(x-2)^2+(y+3)^2=49$

8) $y=-\frac{1}{2}x+\frac{11}{2}$

9) $(-\infty,-5]\cup[3,\infty)$

10) $f^{-1}(x)=\dfrac{x+11}{4}$

11) $y=\frac{3}{2}x-\frac{13}{2}$

12) a) $(-6,-2)$; b) $(-2,3)$; c) $(-\infty,-6)\cup(3,9)$

13) x-axis, y-axis, origin

14)

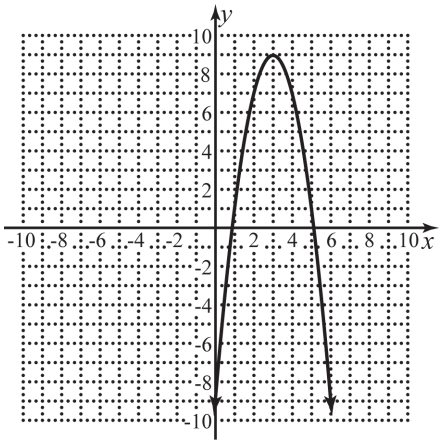

Horizontal Shift: Right 3

Vertical Shift: Up 9

Vertical Stretch: 2

Vertical Reflection: Yes

15) $y=1.23x+1.94$

16) $(f\circ g)(x)=2x-15$; $[5,\infty)$

17) $f(x)=2|x+2|-4$

18) 4

19)

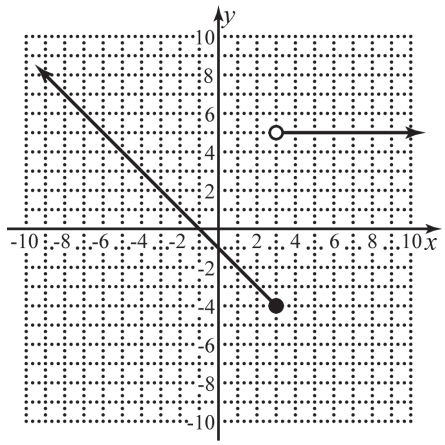

$f(-3)=2, f(3)=-4, f(6)=5$

20) $2x+2=h$

21) a) $C(x)=3x+1500$

b) $R(x)=8x$

c) $P(x)=5x-1500$

d) \$11,000

Copyright © 2019 Pearson Education, Inc.

College Algebra 4th edition Ratti Test Bank

Form B

1) A) $(-6,3)$; B) $(-3,-3)$; C) $(7,9)$; D) $(0,7)$

2) a) $(-\infty,7]$ b) $[-7,\infty)$

3) Distance: $4\sqrt{5}$; Midpoint: $(3,-3)$

4) $(x-7)^2+(y+9)^2=6^2$ or
$(x-7)^2+(y+9)^2=36$

5) $y=5x+23$

6) $(-20,0),(0,10)$

7) $(x+5)^2+(y-4)^2=36$

8) $y=\frac{4}{5}x-\frac{11}{5}$

9) $(-\infty,-6]\cup[2,\infty)$

10) $f^{-1}(x)=\dfrac{x+8}{3}$

11) $y=\frac{3}{2}x+1$

12) a) $(-9,-6)\cup(-2,3)$; b) $(3,\infty)$; c) $(-6,-2)$

13) y-axis

14)

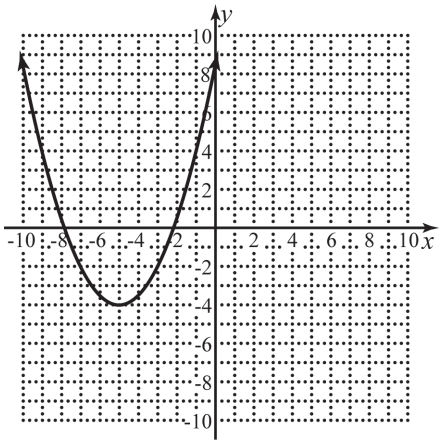

Horizontal Shift: Left 5

Vertical Shift: Down 4

Vertical Stretch: $\frac{1}{2}$

Vertical Reflection: No

15) $y=1.07x+3.85$

16) $(f\circ g)(x)=\dfrac{x+8}{x+14}$; $[-7,\infty)$

17) $f(x)=\frac{1}{5}|x-1|+4$

18) -9

19)

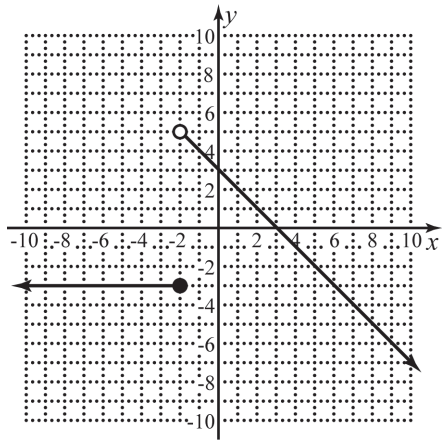

$f(-4)=-3, f(-2)=-3, f(2)=1$

20) $-4x+3-2h$

21) a) $C(x)=8x+2000$

b) $R(x)=15x$

c) $P(x)=7x-2000$

d) $\$20,750$

Copyright © 2019 Pearson Education, Inc.

College Algebra 4th edition Ratti Test Bank

Form C

1) A) $(-9,2)$; B) $(-8,-2)$; C) $(0,-6)$; D) $(8,-5)$

2) a) $(-2,\infty)$ b) $(-\infty,3]$

3) Distance: $2\sqrt{53}$; Midpoint: $(6,-2)$

4) $(x+2)^2+(y-9)^2=3^2$ or
$(x+2)^2+(y-9)^2=9$

5) $y=-3x+1$

6) $(16,0),(0,-2)$

7) $(x-3)^2+(y+5)^2=25$

8) $y=-\frac{5}{6}x-\frac{2}{3}$

9) $(-\infty,-6]\cup[4,\infty)$

10) $f^{-1}(x)=\dfrac{x+5}{8}$

11) $y=\frac{5}{3}x+\frac{59}{3}$

12) a) $(2,6)$; b) $(-\infty,-4)\cup(6,8)$; c) $(-4,2)$

13) x-axis

14)

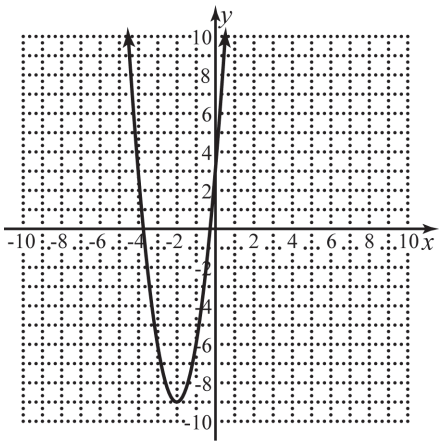

Horizontal Shift: Left 2

Vertical Shift: Down 9

Vertical Stretch: 3

Vertical Reflection: No

15) $y=1.09x+2.30$

16) $(f\circ g)(x)=23-3x$; $(-\infty,7]$

17) $f(x)=-2|x-5|-1$

18) -10

19)

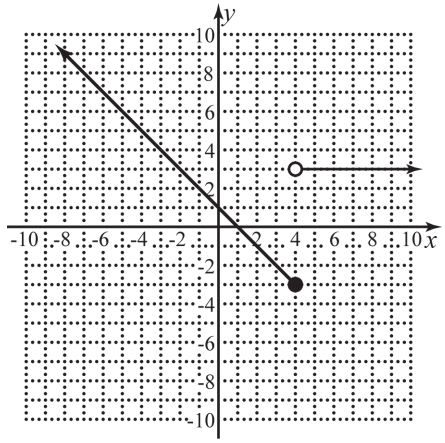

$f(-4)=5, f(4)=-3, f(8)=3$

20) $8x-7+4h$

21) a) $C(x)=5x+1800$

b) $R(x)=13x$

c) $P(x)=8x-1800$

d) $\$10,200$

Copyright © 2019 Pearson Education, Inc.

College Algebra 4th edition Ratti Test Bank

Form D

1) A) $(-7,6)$; B) $(-4,-7)$; C) $(0,-8)$; D) $(5,-1)$

2) a) $(-\infty,-2)$ b) $[-4,\infty)$

3) Distance: $10\sqrt{2}$; Midpoint: $(-1,-4)$

4) $(x+7)^2+(y-8)^2=11^2$ or
$(x+7)^2+(y-8)^2=121$

5) $y=4x+11$

6) $(-3,0),(0,27)$

7) $(x-7)^2+(y+4)^2=9$

8) $y=\frac{4}{5}x-\frac{6}{5}$

9) $(-\infty,-2]\cup[5,\infty)$

10) $f^{-1}(x)=\dfrac{11-x}{5}$

11) $y=\frac{3}{4}x+11$

12) a) $(-6,-2)\cup(6,\infty)$; b) $(4,6)$; c) $(-2,4)$

13) origin

14)

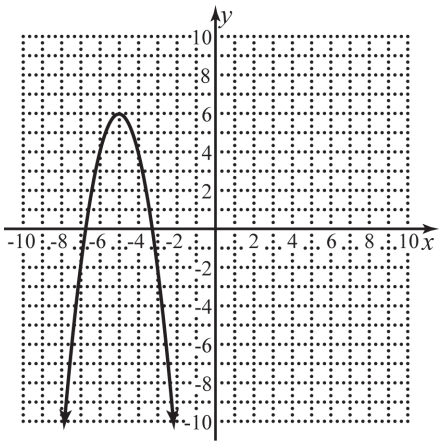

Horizontal Shift: Left 5;

Vertical Shift: Up 6

Vertical Stretch: 2

Vertical Reflection: Yes

15) $y=0.92x+7.65$

16) $(f\circ g)(x)=\dfrac{x-2}{x+1}$; $[2,\infty)$

17) $f(x)=-\frac{1}{2}|x-4|-3$

18) 2

19)

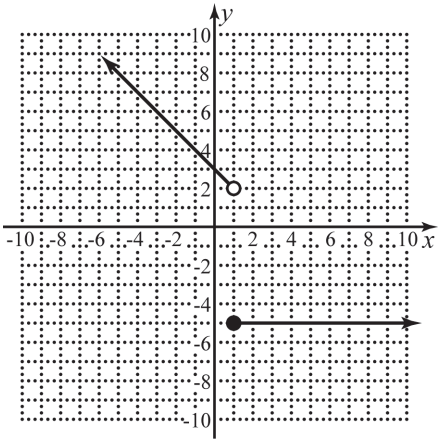

$f(-1)=4, f(1)=-5, f(5)=-5$

20) $3x^2+1+3hx+h^2$

21) a) $C(x)=10x+2400$

b) $R(x)=25x$

c) $P(x)=15x-2400$

d) \$6600

Copyright © 2019 Pearson Education, Inc.

College Algebra 4th edition Ratti Test Bank

Form E

1) A	17) C
2) B	18) D
3) B	19) B
4) D	20) B
5) D	21) D
6) B	22) C
7) B	23) D
8) A	24) C
9) D	25) D
10) C	26) B
11) C	27) A
12) C	28) B
13) C	29) C
14) D	30) B
15) A	31) B
16) B	32) D

Form F

1) A	17) A
2) A	18) A
3) A	19) C
4) C	20) A
5) A	21) A
6) A	22) D
7) D	23) B
8) D	24) D
9) B	25) B
10) B	26) B
11) B	27) A
12) D	28) C
13) A	29) D
14) A	30) C
15) B	31) C
16) C	32) A

Copyright © 2019 Pearson Education, Inc.

College Algebra 4th edition Ratti Test Bank