Organic Chemistry 8th edition Brown Test Bank

SKU: 9781305580350-TEST-BANK

Organic Chemistry 8th edition Brown Test Bank

Chapter 02 - Alkanes and Cycloalkanes

1. Approximately how long is a C−C single bond of an alkane?
   a. 111 pm
   b. 134 pm
   c. 142 pm
   d. 153 pm

ANSWER: d
POINTS: 1
QUESTION TYPE: Multiple Choice
HAS VARIABLES: False
DATE CREATED: 3/12/2015 3:24 PM
DATE MODIFIED: 3/12/2015 3:24 PM

2. What is the approximate C−C−C bond angle in propane?
   a. 90°
   b. 109°
   c. 120°
   d. 180°

ANSWER: b
POINTS: 1
QUESTION TYPE: Multiple Choice
HAS VARIABLES: False
DATE CREATED: 3/12/2015 3:24 PM
DATE MODIFIED: 3/12/2015 3:24 PM

3. What is the name of the linear hydrocarbon with the molecular formula C_7H_{16}?
   a. hexane
   b. heptane
   c. decane
   d. undecane

ANSWER: b
POINTS: 1
QUESTION TYPE: Multiple Choice
HAS VARIABLES: False
DATE CREATED: 3/12/2015 3:24 PM
DATE MODIFIED: 3/12/2015 3:24 PM

4. What is the name of the linear hydrocarbon with the molecular formula $C_{11}H_{24}$?
   a. heptane
   b. decane
   c. undecane
   d. eicosane

ANSWER: c
POINTS: 1
QUESTION TYPE: Multiple Choice

Copyright Cengage Learning. Powered by Cognero.

Organic Chemistry 8th edition Brown Test Bank

HAS VARIABLES: False
DATE CREATED: 3/12/2015 3:24 PM
DATE MODIFIED: 3/12/2015 3:24 PM

5. How many hydrogen atoms are there in nonane, the linear hydrocarbon with nine carbon atoms?
   a. 16
   b. 18
   c. 20
   d. 22

ANSWER: c
POINTS: 1
QUESTION TYPE: Multiple Choice
HAS VARIABLES: False
DATE CREATED: 3/12/2015 3:24 PM
DATE MODIFIED: 3/12/2015 3:24 PM

6. How many hydrogen atoms are there in dodecane, the linear hydrocarbon with twelve carbon atoms?
   a. 12
   b. 20
   c. 24
   d. 26

ANSWER: d
POINTS: 1
QUESTION TYPE: Multiple Choice
HAS VARIABLES: False
DATE CREATED: 3/12/2015 3:24 PM
DATE MODIFIED: 3/12/2015 3:24 PM

7. How many constitutional isomers are there with the molecular formula C_4H_{10}?
   a. 2
   b. 3
   c. 4
   d. 5

ANSWER: a
POINTS: 1
QUESTION TYPE: Multiple Choice
HAS VARIABLES: False
DATE CREATED: 3/12/2015 3:24 PM
DATE MODIFIED: 3/12/2015 3:24 PM

8. How many constitutional isomers are there with the molecular formula C_5H_{12}?
   a. 2
   b. 3
   c. 4

Copyright Cengage Learning. Powered by Cognero.

Organic Chemistry 8th edition Brown Test Bank

d. 5

ANSWER: b
POINTS: 1
QUESTION TYPE: Multiple Choice
HAS VARIABLES: False
DATE CREATED: 3/12/2015 3:24 PM
DATE MODIFIED: 3/12/2015 3:24 PM

9. How many constitutional isomers are there with the molecular formula C_6H_{14}?

a. 3
b. 4
c. 5
d. 8

ANSWER: c
POINTS: 1
QUESTION TYPE: Multiple Choice
HAS VARIABLES: False
DATE CREATED: 3/12/2015 3:24 PM
DATE MODIFIED: 3/12/2015 3:24 PM

10. What is the IUPAC name of the following compound?

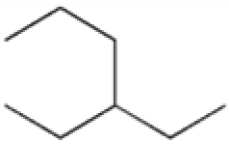

a. 3-propylpentane
b. 1,1-diethylpropane
c. 3-ethylhexane
d. isooctane

ANSWER: c
POINTS: 1
QUESTION TYPE: Multiple Choice
HAS VARIABLES: False
DATE CREATED: 3/12/2015 3:24 PM
DATE MODIFIED: 3/12/2015 3:24 PM

11. What is the IUPAC name of the following compound?

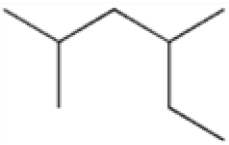

a. 2-ethyl-4-methylpentane
b. 2,4-dimethylhexane

Copyright Cengage Learning. Powered by Cognero.

Organic Chemistry 8th edition Brown Test Bank

c. 3,5-dimethylhexane
d. 1,1,3-trimethylpentane

ANSWER: b
POINTS: 1
QUESTION TYPE: Multiple Choice
HAS VARIABLES: False
DATE CREATED: 3/12/2015 3:24 PM
DATE MODIFIED: 3/12/2015 3:24 PM

12. What is the IUPAC name of the following compound?

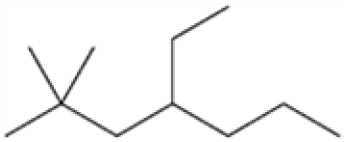

a. 2,2-dimethyl-4-ethylheptane
b. 4-ethyl-2,2-dimethyl-heptane
c. 6,6-dimethyl-4-ethylheptane
d. 4-ethyl-6,6-dimethyl-heptane

ANSWER: b
POINTS: 1
QUESTION TYPE: Multiple Choice
HAS VARIABLES: False
DATE CREATED: 3/12/2015 3:24 PM
DATE MODIFIED: 3/12/2015 3:24 PM

13. What is the IUPAC name of the following compound?

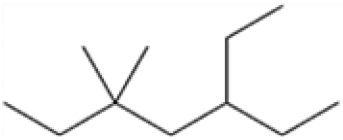

a. 5,5-dimethyl-3-ethylheptane
b. 5-ethyl-3,3-dimethyl-heptane
c. 3,3-dimethyl-5-ethylheptane
d. 3-ethyl-5,5-dimethyl-heptane

ANSWER: d
POINTS: 1
QUESTION TYPE: Multiple Choice
HAS VARIABLES: False
DATE CREATED: 3/12/2015 3:24 PM
DATE MODIFIED: 3/12/2015 3:24 PM

14. What is the IUPAC name of the following compound?

Copyright Cengage Learning. Powered by Cognero.

Organic Chemistry 8th edition Brown Test Bank

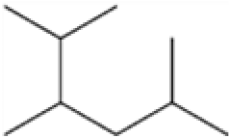

a. 2-isopropyl-5-methylpentane
b. 5-isopropyl-2-methylpentane
c. 2,3,5-trimethylhexane
d. 1,2-diisopropylpropane

ANSWER: c
POINTS: 1
QUESTION TYPE: Multiple Choice
HAS VARIABLES: False
DATE CREATED: 3/12/2015 3:24 PM
DATE MODIFIED: 3/12/2015 3:24 PM

15. What is the IUPAC name of the following compound?

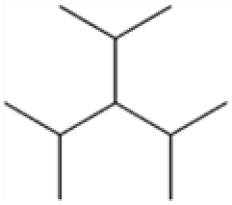

a. 2,4-dimethyl-3-isopropyl-pentane
b. 3-isopropyl-1,5-dimethylpentane
c. 3-isopropyl-2,4-dimethylpentane
d. triisopropylmethane

ANSWER: c
POINTS: 1
QUESTION TYPE: Multiple Choice
HAS VARIABLES: False
DATE CREATED: 3/12/2015 3:24 PM
DATE MODIFIED: 3/12/2015 3:24 PM

16. Which of the following compounds has 1°, 2°, 3° and 4° carbon atoms?
a. hexane
b. 2-methylhexane
c. 2,2-dimethylhexane
d. 2,2,3-trimethylhexane

ANSWER: d
POINTS: 1
QUESTION TYPE: Multiple Choice
HAS VARIABLES: False
DATE CREATED: 3/12/2015 3:24 PM
DATE MODIFIED: 3/12/2015 3:24 PM

Copyright Cengage Learning. Powered by Cognero.

Organic Chemistry 8th edition Brown Test Bank

17. Which of the following compounds has only 1° and 3° carbon atoms?

a. hexane
b. 2-methylpentane
c. 3-methylpentane
d. 2,3-dimethylbutane

ANSWER: d
POINTS: 1
QUESTION TYPE: Multiple Choice
HAS VARIABLES: False
DATE CREATED: 3/12/2015 3:24 PM
DATE MODIFIED: 3/12/2015 3:24 PM

18. What is the correct assignment of common names for the following molecules?

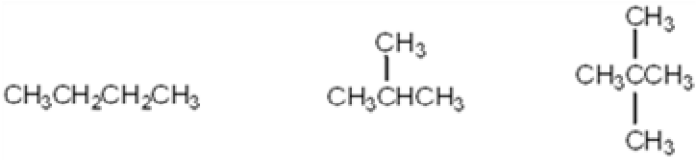

i *ii* *iii*

a. *i* = butane; *ii* = neopentane; *iii* = isopentane
b. *i* = neobutane; *ii* = isobutane; *iii* = pentane
c. *i* = butane; *ii* = isobutane; *iii* = isopentane
d. *i* = butane; *ii* = isobutane; *iii* = neopentane

ANSWER: d
POINTS: 1
QUESTION TYPE: Multiple Choice
HAS VARIABLES: False
DATE CREATED: 3/12/2015 3:24 PM
DATE MODIFIED: 3/12/2015 3:24 PM

19. What is the correct assignment of common names for the following molecules?

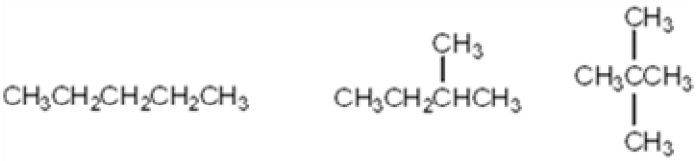

i *ii* *iii*

a. *i* = pentane; *ii* = isopentane; *iii* = neopentane
b. *i* = neopentane; *ii* = isopentane; *iii* = pentane
c. *i* = pentane; *ii* = neopentane; *iii* = isopentane
d. *i* = neopentane; *ii* = pentane; *iii* = isopentane

ANSWER: a
POINTS: 1
QUESTION TYPE: Multiple Choice

Copyright Cengage Learning. Powered by Cognero.

Organic Chemistry 8th edition Brown Test Bank

HAS VARIABLES: False
DATE CREATED: 3/12/2015 3:24 PM
DATE MODIFIED: 3/12/2015 3:24 PM

20. What is the IUPAC name of the following compound?

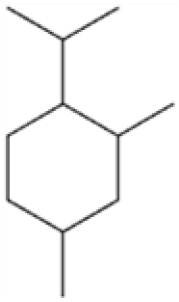

a. 1-isopropyl-4,6-dimethylcyclohexane
b. 1-isopropyl-2,4-dimethylcyclohexane
c. 4-isopropyl-1,3-dimethylcyclohexane
d. 4-isopropyl-1,5-dimethylcyclohexane

ANSWER: b
POINTS: 1
QUESTION TYPE: Multiple Choice
HAS VARIABLES: False
DATE CREATED: 3/12/2015 3:24 PM
DATE MODIFIED: 3/12/2015 3:24 PM

21. What is the IUPAC name of the following compound?

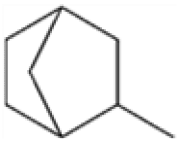

a. 1-methylbicyclo[2.2.1]heptane
b. 2-methylbicyclo[2.2.1]heptane
c. 3-methylbicyclo[2.2.1]heptane
d. 4-methylbicyclo[2.2.1]heptane

ANSWER: b
POINTS: 1
QUESTION TYPE: Multiple Choice
HAS VARIABLES: False
DATE CREATED: 3/12/2015 3:24 PM
DATE MODIFIED: 3/12/2015 3:24 PM

22. What is the IUPAC name of the following compound?

Copyright Cengage Learning. Powered by Cognero.

Organic Chemistry 8th edition Brown Test Bank

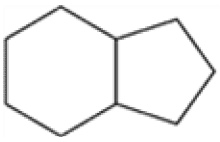

a. bicyclo[4.3]nonane
b. bicyclo[4.3.0]nonane
c. bicyclo[6.5]nonane
d. bicyclo[6.5.0]nonane

ANSWER: b
POINTS: 1
QUESTION TYPE: Multiple Choice
HAS VARIABLES: False
DATE CREATED: 3/12/2015 3:24 PM
DATE MODIFIED: 3/12/2015 3:24 PM

23. What is the IUPAC name for the following compound?

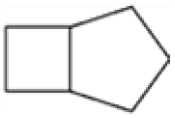

a. cycloheptane
b. bicyclo[3.2.0]heptane
c. bicyclo[5.4]heptane
d. cyclobutylcyclopentane

ANSWER: b
POINTS: 1
QUESTION TYPE: Multiple Choice
HAS VARIABLES: False
DATE CREATED: 3/12/2015 3:24 PM
DATE MODIFIED: 3/12/2015 3:24 PM

24. What is the IUPAC name for the following compound?

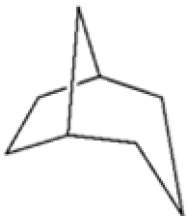

a. bicyclo[5.4.3]octane
b. bicyclo[3.2.1]octane
c. bicyclo[3.2.1]hexane
d. bicyclo[2.2.1]octane

ANSWER: b
POINTS: 1
QUESTION TYPE: Multiple Choice

Copyright Cengage Learning. Powered by Cognero.

Organic Chemistry 8th edition Brown Test Bank

HAS VARIABLES: False
DATE CREATED: 3/12/2015 3:24 PM
DATE MODIFIED: 3/12/2015 3:24 PM

25. Which of the following Newman projections does *not* represent 2-methylhexane?

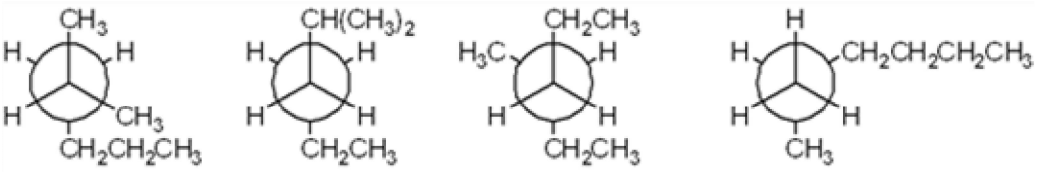

1 **2** **3** **4**

a. **1**
b. **2**
c. **3**
d. **4**

ANSWER: c
POINTS: 1
QUESTION TYPE: Multiple Choice
HAS VARIABLES: False
DATE CREATED: 3/12/2015 3:24 PM
DATE MODIFIED: 3/12/2015 3:24 PM

26. Which of the following Newman projections represents 2,4-dimethylpentane?

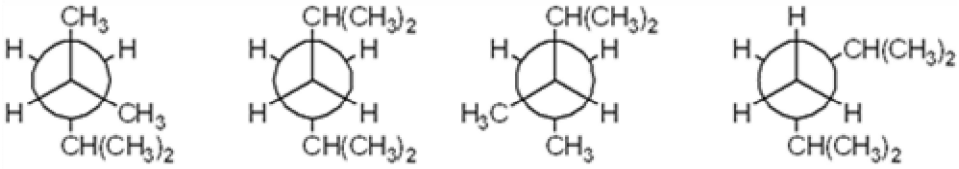

1 **2** **3** **4**

a. **1**
b. **2**
c. **3**
d. **4**

ANSWER: a
POINTS: 1
QUESTION TYPE: Multiple Choice
HAS VARIABLES: False
DATE CREATED: 3/12/2015 3:24 PM
DATE MODIFIED: 3/12/2015 3:24 PM

27. Which of the following Newman projections represents the most stable conformation of 2,3-dimethylbutane?

Copyright Cengage Learning. Powered by Cognero.

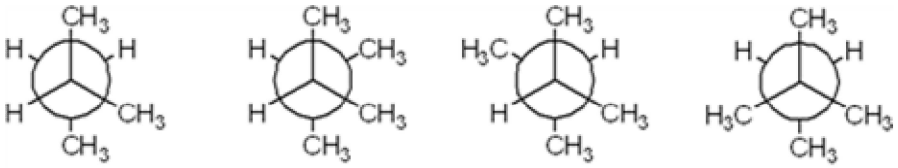

1 **2** **3** **4**

a. **1**
b. **2**
c. **3**
d. **4**

ANSWER: c
POINTS: 1
QUESTION TYPE: Multiple Choice
HAS VARIABLES: False
DATE CREATED: 3/12/2015 3:24 PM
DATE MODIFIED: 3/12/2015 3:24 PM

28. Which of the following Newman projections represents the most stable conformation of 2-methylbutane?

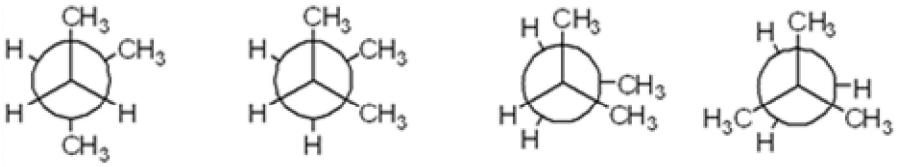

1 **2** **3** **4**

a. **1**
b. **2**
c. **3**
d. **4**

ANSWER: a
POINTS: 1
QUESTION TYPE: Multiple Choice
HAS VARIABLES: False
DATE CREATED: 3/12/2015 3:24 PM
DATE MODIFIED: 3/12/2015 3:24 PM

29. Which of the following cycloalkanes has the most ring strain?
a. cyclopropane
b. cyclobutane
c. cyclopentane
d. cyclohexane

ANSWER: a
POINTS: 1
QUESTION TYPE: Multiple Choice
HAS VARIABLES: False
DATE CREATED: 3/12/2015 3:24 PM

Copyright Cengage Learning. Powered by Cognero.

Organic Chemistry 8th edition Brown Test Bank

DATE MODIFIED: 3/12/2015 3:24 PM

30. Which of the following cycloalkanes has the least ring strain?
    a. cyclopropane
    b. cyclopentane
    c. cyclohexane
    d. cycloheptane

ANSWER: c
POINTS: 1
QUESTION TYPE: Multiple Choice
HAS VARIABLES: False
DATE CREATED: 3/12/2015 3:24 PM
DATE MODIFIED: 3/12/2015 3:24 PM

31. Which of the following structures represents *trans*-1,3-dimethylcyclohexane?

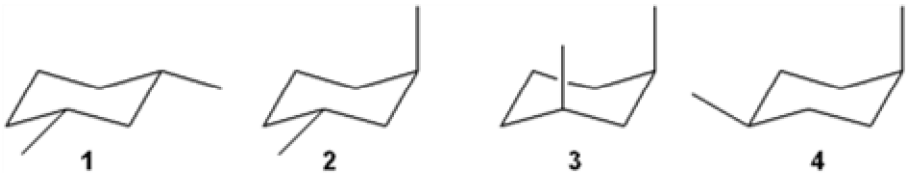

    a. **1**
    b. **2**
    c. **3**
    d. **4**

ANSWER: b
POINTS: 1
QUESTION TYPE: Multiple Choice
HAS VARIABLES: False
DATE CREATED: 3/12/2015 3:24 PM
DATE MODIFIED: 3/12/2015 3:24 PM

32. Which of the following structures represents *trans*-1,2-dimethylcyclohexane?

    a. **1**
    b. **2**
    c. **3**
    d. **4**

ANSWER: b
POINTS: 1
QUESTION TYPE: Multiple Choice

Copyright Cengage Learning. Powered by Cognero.

Organic Chemistry 8th edition Brown Test Bank

HAS VARIABLES: False
DATE CREATED: 3/12/2015 3:24 PM
DATE MODIFIED: 3/12/2015 3:24 PM

33. Which of the following is the most stable conformation of *cis*-1-isopropyl-3-methylcyclohexane?

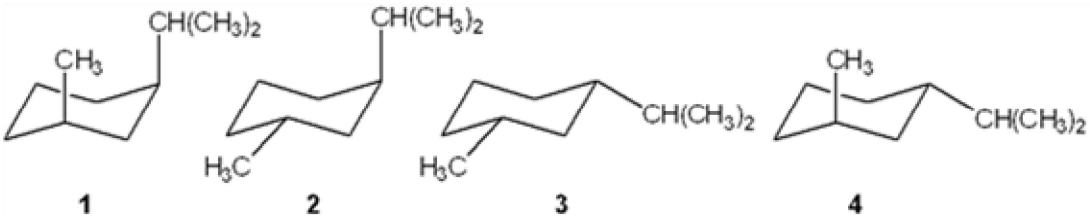

a. **1**
b. **2**
c. **3**
d. **4**

ANSWER: c
POINTS: 1
QUESTION TYPE: Multiple Choice
HAS VARIABLES: False
DATE CREATED: 3/12/2015 3:24 PM
DATE MODIFIED: 3/12/2015 3:24 PM

34. Which of the following is the most stable conformation of *trans*-1-ethyl-3-methylcyclohexane?

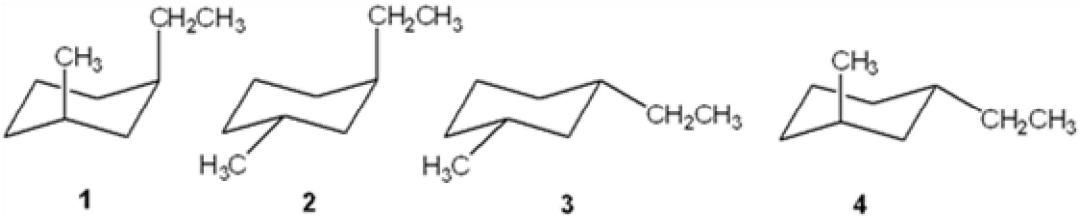

a. **1**
b. **2**
c. **3**
d. **4**

ANSWER: d
POINTS: 1
QUESTION TYPE: Multiple Choice
HAS VARIABLES: False
DATE CREATED: 3/12/2015 3:24 PM
DATE MODIFIED: 3/12/2015 3:24 PM

35. Which of the following alkanes has the highest boiling point?
a. propane
b. butane
c. pentane

Copyright Cengage Learning. Powered by Cognero.

Organic Chemistry 8th edition Brown Test Bank

d. hexane

ANSWER: d
POINTS: 1
QUESTION TYPE: Multiple Choice
HAS VARIABLES: False
DATE CREATED: 3/12/2015 3:24 PM
DATE MODIFIED: 3/12/2015 3:24 PM

36. Which of the following alkanes has the highest boiling point?
a. 2,3-dimethylbutane
b. 2-methylpentane
c. 3-methylpentane
d. hexane

ANSWER: d
POINTS: 1
QUESTION TYPE: Multiple Choice
HAS VARIABLES: False
DATE CREATED: 3/12/2015 3:24 PM
DATE MODIFIED: 3/12/2015 3:24 PM

37. What is the IUPAC name of the following compound?

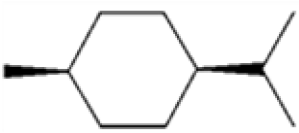

a. *trans*-1-isopropyl-4-methylcyclohexane
b. *cis*-1-isopropyl-4-methylcyclohexane
c. *cis*-2-isopropyl-5-methylcyclohexane
d. *cis*-1-*tert*-butyl-4-methylcyclohexane

ANSWER: b
POINTS: 1
QUESTION TYPE: Multiple Choice
HAS VARIABLES: False
DATE CREATED: 3/12/2015 3:24 PM
DATE MODIFIED: 3/12/2015 3:24 PM

38. What is the IUPAC name of the following compound?

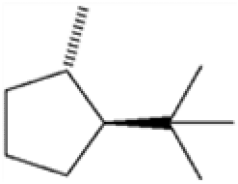

a. *trans*-1-isopropyl-4-methylcyclopentane
b. *cis*-1-*tert*-butyl-2-methylcyclopentane

Copyright Cengage Learning. Powered by Cognero.

Organic Chemistry 8th edition Brown Test Bank

c. *trans*-1-*tert*-butyl-2-methylcyclopentane
d. *cis*-1-isopropyl-2-methylcyclopentane

ANSWER: c
POINTS: 1
QUESTION TYPE: Multiple Choice
HAS VARIABLES: False
DATE CREATED: 3/12/2015 3:24 PM
DATE MODIFIED: 3/12/2015 3:24 PM

39. Which one of the following structures represents a different compound from the other three?

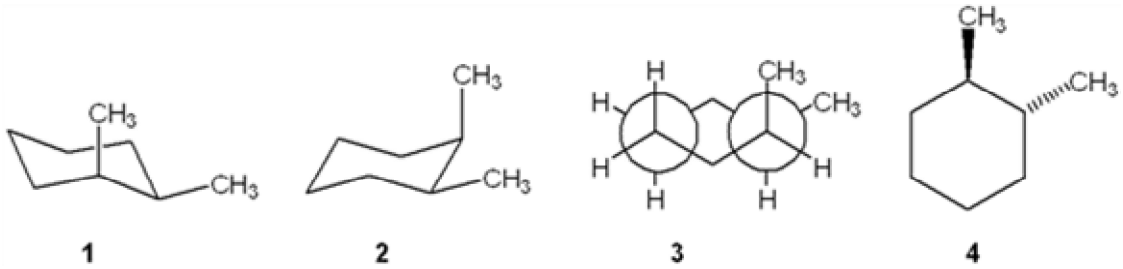

a. **1**
b. **2**
c. **3**
d. **4**

ANSWER: d
POINTS: 1
QUESTION TYPE: Multiple Choice
HAS VARIABLES: False
DATE CREATED: 3/12/2015 3:24 PM
DATE MODIFIED: 3/12/2015 3:24 PM

40. Which one of the following structures represents a different compound from the other three?

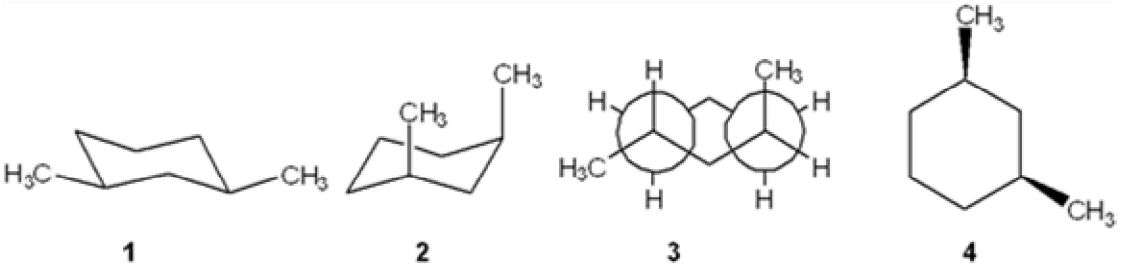

a. **1**
b. **2**
c. **3**
d. **4**

ANSWER: c
POINTS: 1
QUESTION TYPE: Multiple Choice

Copyright Cengage Learning. Powered by Cognero.

Organic Chemistry 8th edition Brown Test Bank

HAS VARIABLES: False
DATE CREATED: 3/12/2015 3:24 PM
DATE MODIFIED: 3/12/2015 3:24 PM

41. In which of the following compounds are all of the carbon atoms in the same plane?
    a. cyclopropane
    b. cyclobutane
    c. cyclopentane
    d. cyclohexane

ANSWER: a
POINTS: 1
QUESTION TYPE: Multiple Choice
HAS VARIABLES: False
DATE CREATED: 3/12/2015 3:24 PM
DATE MODIFIED: 3/12/2015 3:24 PM

42. Which of the following compounds can adopt a chair conformation in which there are no axial methyl groups?
    a. 1,1-dimethylcyclohexane
    b. *cis*-1,2-dimethylcyclohexane
    c. *trans*-1,2-dimethylcyclohexane
    d. *cis*-1,3-dimethylcyclohexane

ANSWER: c
POINTS: 1
QUESTION TYPE: Multiple Choice
HAS VARIABLES: False
DATE CREATED: 3/12/2015 3:24 PM
DATE MODIFIED: 3/12/2015 3:24 PM

43. Which of the following compounds can adopt a chair conformation in which there are no axial methyl groups?
    a. *cis*-1,2-dimethylcyclohexane
    b. *cis*-1,3-dimethylcyclohexane
    c. *trans*-1,3-dimethylcyclohexane
    d. *cis*-1,4-dimethylcyclohexane

ANSWER: b
POINTS: 1
QUESTION TYPE: Multiple Choice
HAS VARIABLES: False
DATE CREATED: 3/12/2015 3:24 PM
DATE MODIFIED: 3/12/2015 3:24 PM

44. Which of the following statements is not true regarding the conformation of substituted cyclohexanes?
    a. ring inversion of cyclohexane between two chair conformations takes place via a boat conformation
    b. substituted cyclohexanes are destabilized by 1,3-diaxial interactions
    c. the boat conformation of cyclohexane is usually more stable than the chair conformation

Copyright Cengage Learning. Powered by Cognero.

Organic Chemistry 8th edition Brown Test Bank

d. the relative amount of two conformations of substituted cyclohexanes can be determined from the difference in strain energy

ANSWER: c
POINTS: 1
QUESTION TYPE: Multiple Choice
HAS VARIABLES: False
DATE CREATED: 3/12/2015 3:24 PM
DATE MODIFIED: 3/12/2015 3:24 PM

45. What is the approximate dihedral angle between the two chlorine atoms in *cis*-1,2-dichlorocyclohexane?

a. 0°
b. 60°
c. 120°
d. 180°

ANSWER: b
POINTS: 1
QUESTION TYPE: Multiple Choice
HAS VARIABLES: False
DATE CREATED: 3/12/2015 3:24 PM
DATE MODIFIED: 3/12/2015 3:24 PM

46. What is the approximate dihedral angle between the two chlorine atoms in the diequatorial conformation of *trans*-1,2-dichlorocyclohexane?

a. 0°
b. 60°
c. 120°
d. 180°

ANSWER: b
POINTS: 1
QUESTION TYPE: Multiple Choice
HAS VARIABLES: False
DATE CREATED: 3/12/2015 3:24 PM
DATE MODIFIED: 3/12/2015 3:24 PM

47. What is the approximate dihedral angle between the two chlorine atoms in the diaxial conformation of *trans*-1,2-dichlorocyclohexane?

a. 0°
b. 60°
c. 120°
d. 180°

ANSWER: d
POINTS: 1
QUESTION TYPE: Multiple Choice
HAS VARIABLES: False

Copyright Cengage Learning. Powered by Cognero.

Organic Chemistry 8th edition Brown Test Bank

DATE CREATED: 3/12/2015 3:24 PM
DATE MODIFIED: 3/12/2015 3:24 PM

48. Which of the following is *not* true regarding the properties of alkanes?
    a. alkanes are nonpolar
    b. alkanes burn in air to give H_2O and CO_2
    c. alkanes are highly miscible with water
    d. the strongest intermolecular force between alkane molecules is the van der Waals interaction

ANSWER: c
POINTS: 1
QUESTION TYPE: Multiple Choice
HAS VARIABLES: False
DATE CREATED: 3/12/2015 3:24 PM
DATE MODIFIED: 3/12/2015 3:24 PM

49. Which of the following undergoes the most exothermic combustion?
    a. octane
    b. 2-methylheptane
    c. 2,2-dimethylhexane
    d. 2,2,3,3-tetramethylbutane

ANSWER: a
POINTS: 1
QUESTION TYPE: Multiple Choice
HAS VARIABLES: False
DATE CREATED: 3/12/2015 3:24 PM
DATE MODIFIED: 3/12/2015 3:24 PM

50. How many moles of molecular oxygen (O_2) are consumed in the complete combustion of one mole of octane (C_8H_{18})?
    a. 12.5
    b. 13
    c. 17
    d. 26

ANSWER: a
POINTS: 1
QUESTION TYPE: Multiple Choice
HAS VARIABLES: False
DATE CREATED: 3/12/2015 3:24 PM
DATE MODIFIED: 3/12/2015 3:24 PM

51. How many moles of molecular oxygen (O_2) are consumed in the complete combustion of one mole of hexane (C_6H_{14})?
    a. 6
    b. 9.5

Copyright Cengage Learning. Powered by Cognero.

Organic Chemistry 8th edition Brown Test Bank

c. 12.5
d. 14

ANSWER: b
POINTS: 1
QUESTION TYPE: Multiple Choice
HAS VARIABLES: False
DATE CREATED: 3/12/2015 3:24 PM
DATE MODIFIED: 3/12/2015 3:24 PM

52. Which of the following statements is *not* true?
a. Combustion of an alkane is an exothermic reaction.
b. The heat of combustion of propane is three times that of methane.
c. The constitutional isomers of C_7H_{16} have different heats of combustion from one another
d. The products of combustion of an alkane are H_2O and CO_2.

ANSWER: b
POINTS: 1
QUESTION TYPE: Multiple Choice
HAS VARIABLES: False
DATE CREATED: 3/12/2015 3:24 PM
DATE MODIFIED: 3/12/2015 3:24 PM

53. Which of the following is the steroid nucleus?

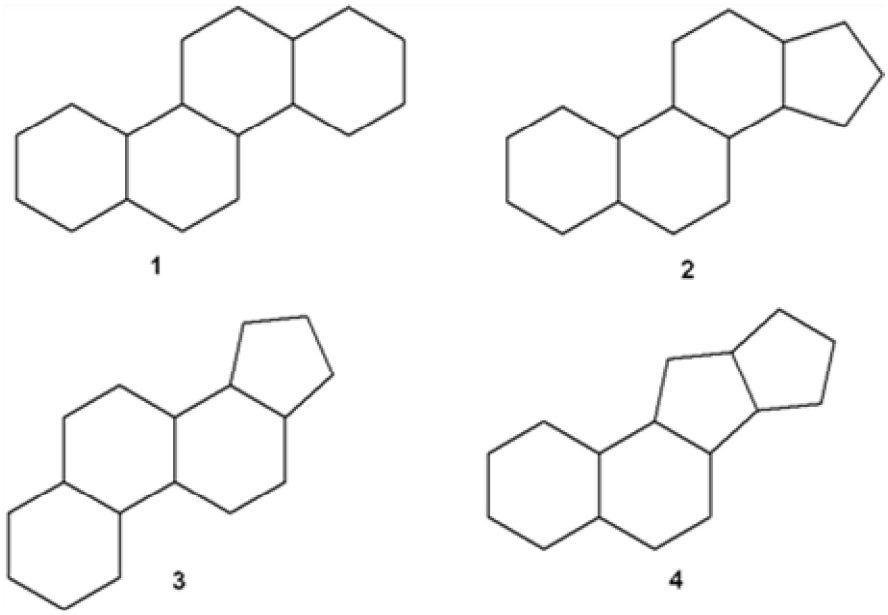

a. **1**
b. **2**
c. **3**
d. **4**

ANSWER: b
POINTS: 1

Copyright Cengage Learning. Powered by Cognero.

Organic Chemistry 8th edition Brown Test Bank

QUESTION TYPE: Multiple Choice
HAS VARIABLES: False
DATE CREATED: 3/12/2015 3:24 PM
DATE MODIFIED: 3/12/2015 3:24 PM

54. Which of the following cycloalkanes has the largest heat of combustion?
    a. cyclopropane
    b. cyclobutane
    c. cyclopentane
    d. cyclohexane

ANSWER: d
POINTS: 1
QUESTION TYPE: Multiple Choice
HAS VARIABLES: False
DATE CREATED: 3/12/2015 3:24 PM
DATE MODIFIED: 3/12/2015 3:24 PM

55. Which of the following cycloalkanes has the largest heat of combustion per carbon atom?
    a. cyclopropane
    b. cyclopentane
    c. cyclohexane
    d. cycloheptane

ANSWER: a
POINTS: 1
QUESTION TYPE: Multiple Choice
HAS VARIABLES: False
DATE CREATED: 3/12/2015 3:24 PM
DATE MODIFIED: 3/12/2015 3:24 PM

56. Which of the following cycloalkanes has the smallest heat of combustion per carbon atom?
    a. cyclopropane
    b. cyclopentane
    c. cyclohexane
    d. cycloheptane

ANSWER: c
POINTS: 1
QUESTION TYPE: Multiple Choice
HAS VARIABLES: False
DATE CREATED: 3/12/2015 3:24 PM
DATE MODIFIED: 3/12/2015 3:24 PM

57. Which of the following structures is different from the other three?

Copyright Cengage Learning. Powered by Cognero.

Organic Chemistry 8th edition Brown Test Bank

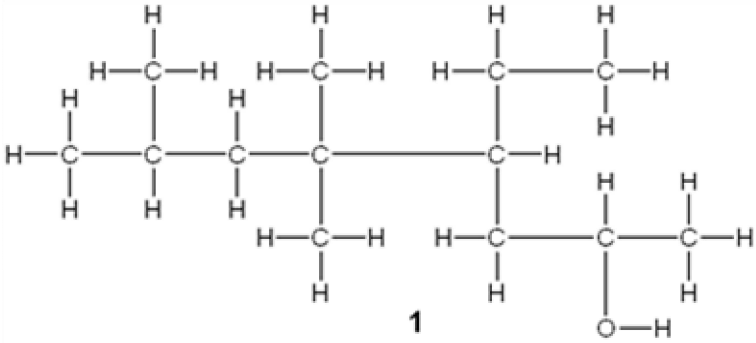

1

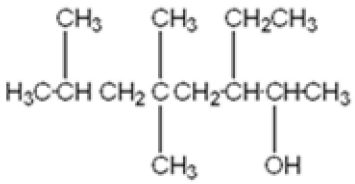

2

$(CH_3)_2CHCH_2C(CH_3)_2CH(CH_2CH_3)CH_2CH(OH)CH_3$

3

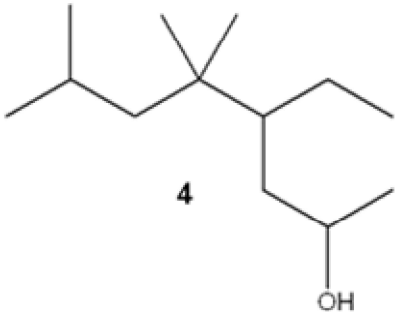

4

a. **1**
b. **2**
c. **3**
d. **4**

ANSWER: b
POINTS: 1
QUESTION TYPE: Multiple Choice
HAS VARIABLES: False
DATE CREATED: 3/12/2015 3:24 PM
DATE MODIFIED: 3/12/2015 3:24 PM

58. Which of the following structures is different from the other three?

$(CH_3)_2CHC(CH_3)CH_2CH(CH_2CH_3)CH_2CH(OH)CH_3$

1

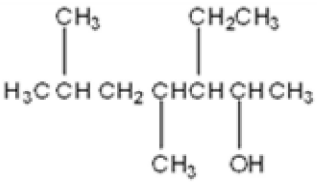

2

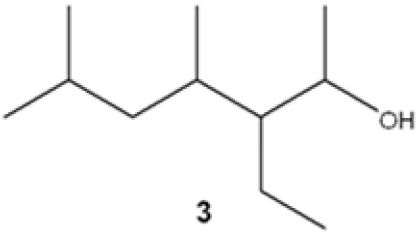

3

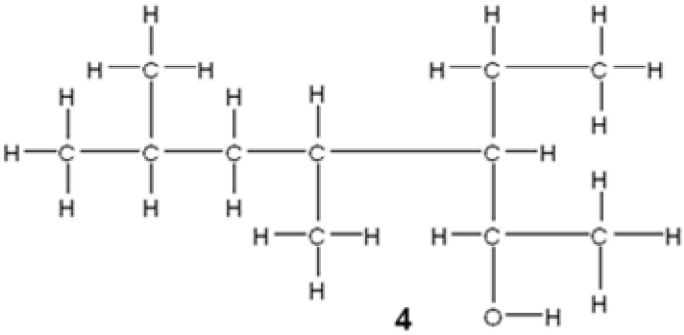

4

Copyright Cengage Learning. Powered by Cognero.

Organic Chemistry 8th edition Brown Test Bank

a. **1**
b. **2**
c. **3**
d. **4**

ANSWER: a
POINTS: 1
QUESTION TYPE: Multiple Choice
HAS VARIABLES: False
DATE CREATED: 3/12/2015 3:24 PM
DATE MODIFIED: 3/12/2015 3:24 PM

59. Which of the following substituted cyclohexanes has the most negative value of $\Delta G°$ for ring flipping from the conformation in which the substituent is axial to the one where it is equatorial?

a. methylcyclohexane
b. chlorocyclohexane
c. isopropylcyclohexane
d. ethynylcyclohexane

ANSWER: c
POINTS: 1
QUESTION TYPE: Multiple Choice
HAS VARIABLES: False
DATE CREATED: 3/12/2015 3:24 PM
DATE MODIFIED: 3/12/2015 3:24 PM

60. Which of the following substituted cyclohexanes has the most negative value of $\Delta G°$ for ring flipping from the conformation in which the substituent is axial to the one where it is equatorial?

a. fluorocyclohexane
b. methylcyclohexane
c. ethylcyclohexane
d. *tert*-butylcyclohexane

ANSWER: d
POINTS: 1
QUESTION TYPE: Multiple Choice
HAS VARIABLES: False
DATE CREATED: 3/12/2015 3:24 PM
DATE MODIFIED: 3/12/2015 3:24 PM

61. The Newman projection of the gauche conformation of 1,2-dichloroethane is shown below.

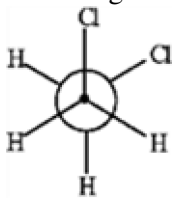

a. True
b. False

Copyright Cengage Learning. Powered by Cognero.

Organic Chemistry 8th edition Brown Test Bank

ANSWER: True
POINTS: 1
QUESTION TYPE: True / False
HAS VARIABLES: False
DATE CREATED: 3/12/2015 3:24 PM
DATE MODIFIED: 3/10/2017 1:33 AM

62. The most stable conformation of an alkane occurs when carbon−carbon bonds are staggered and bulky groups are anti.
    a. True
    b. False

ANSWER: True
POINTS: 1
QUESTION TYPE: True / False
HAS VARIABLES: False
DATE CREATED: 3/12/2015 3:24 PM
DATE MODIFIED: 3/12/2015 3:24 PM

63. The following pairs of Newman projections represent the same compound but in differing conformations.

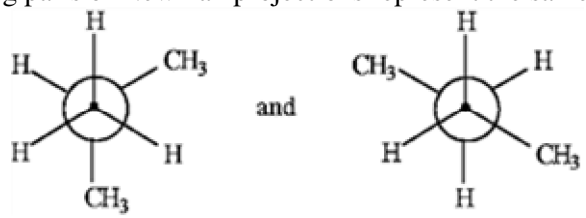

    a. True
    b. False

ANSWER: False
POINTS: 1
QUESTION TYPE: True / False
HAS VARIABLES: False
DATE CREATED: 3/12/2015 3:24 PM
DATE MODIFIED: 3/10/2017 1:38 AM

64. There are four constitutional isomers for the molecular formula C_6H_{14}.
    a. True
    b. False

ANSWER: False
POINTS: 1
QUESTION TYPE: True / False
HAS VARIABLES: False
DATE CREATED: 3/12/2015 3:24 PM
DATE MODIFIED: 3/12/2015 3:24 PM

65. The following Newman projection represents 2-methylhexane.

Copyright Cengage Learning. Powered by Cognero.

Organic Chemistry 8th edition Brown Test Bank

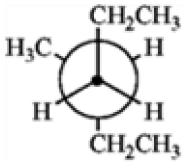

a. True
b. False

ANSWER: False
POINTS: 1
QUESTION TYPE: True / False
HAS VARIABLES: False
DATE CREATED: 3/12/2015 3:24 PM
DATE MODIFIED: 3/10/2017 1:37 AM

66. The following structures represent, from left to right, a *cis* and a *trans* isomer.

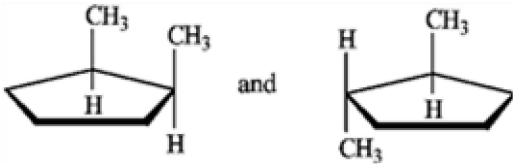

a. True
b. False

ANSWER: True
POINTS: 1
QUESTION TYPE: True / False
HAS VARIABLES: False
DATE CREATED: 3/12/2015 3:24 PM
DATE MODIFIED: 3/10/2017 1:37 AM

67. The following structures represent a pair of constitutional isomers.



a. True
b. False

ANSWER: False
POINTS: 1
QUESTION TYPE: True / False
HAS VARIABLES: False
DATE CREATED: 3/12/2015 3:24 PM
DATE MODIFIED: 3/10/2017 1:38 AM

68. 3-methylhexylcyclopentane represents a correct IUPAC name.
a. True
b. False

ANSWER: False

Copyright Cengage Learning. Powered by Cognero.

Organic Chemistry 8th edition Brown Test Bank

POINTS: 1
QUESTION TYPE: True / False
HAS VARIABLES: False
DATE CREATED: 3/12/2015 3:24 PM
DATE MODIFIED: 3/12/2015 3:24 PM

69. In the following structure the positions labeled a and d are equatorial positions.

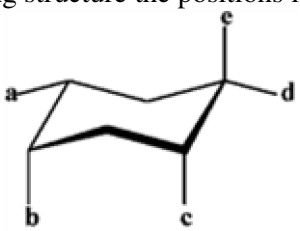

a. True
b. False

ANSWER: True
POINTS: 1
QUESTION TYPE: True / False
HAS VARIABLES: False
DATE CREATED: 3/12/2015 3:24 PM
DATE MODIFIED: 3/13/2017 2:28 AM

70. In the following conversion, the conformations are of equal stability.

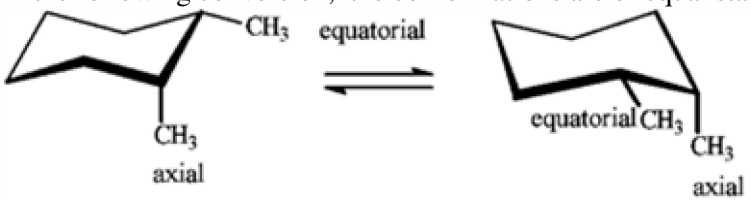

a. True
b. False

ANSWER: True
POINTS: 1
QUESTION TYPE: True / False
HAS VARIABLES: False
DATE CREATED: 3/12/2015 3:24 PM
DATE MODIFIED: 3/10/2017 4:39 AM

71. The correct IUPAC name for the following compound is_____.

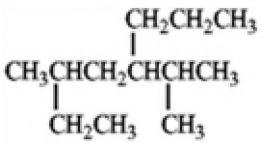

ANSWER: 3-methyl-5-(1-methylethyl)octane
3-methyl-5-isopropyloctane
POINTS: 1

Copyright Cengage Learning. Powered by Cognero.

Organic Chemistry 8th edition Brown Test Bank

QUESTION TYPE: Completion
HAS VARIABLES: False
DATE CREATED: 3/12/2015 3:24 PM
DATE MODIFIED: 3/13/2017 2:29 AM

72. The tertiary carbon atom in the following structure is indicated by the letter_____.

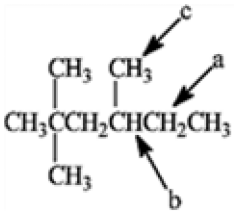

ANSWER: b
B
POINTS: 1
QUESTION TYPE: Completion
HAS VARIABLES: False
DATE CREATED: 3/12/2015 3:24 PM
DATE MODIFIED: 3/13/2017 2:30 AM

Match the Newman projection for the conformation of 2-methylbutane to the indicated position on the potential energy diagram.

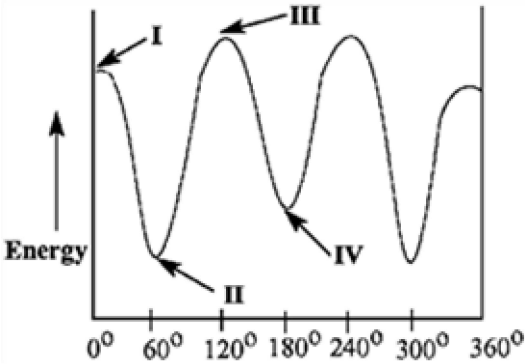

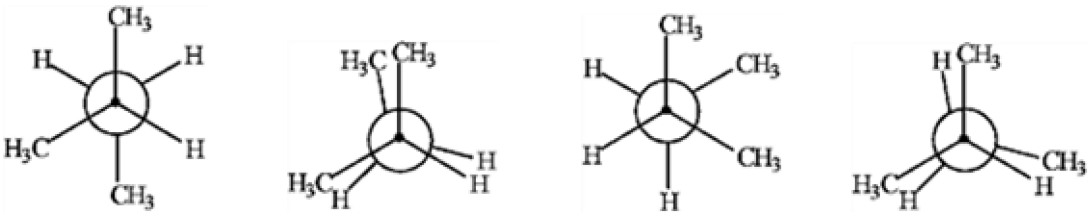

73. Conformation A is represented by Roman numeral ____.
ANSWER: II
POINTS: 1
QUESTION TYPE: Completion
HAS VARIABLES: False
PREFACE NAME: PE Diagram

Copyright Cengage Learning. Powered by Cognero.

Organic Chemistry 8th edition Brown Test Bank

DATE CREATED: 3/12/2015 3:24 PM
DATE MODIFIED: 3/12/2015 3:24 PM

74. Conformation B is represented by Roman numeral ____.
ANSWER: III
POINTS: 1
QUESTION TYPE: Completion
HAS VARIABLES: False
PREFACE NAME: PE Diagram
DATE CREATED: 3/12/2015 3:24 PM
DATE MODIFIED: 3/12/2015 3:24 PM

75. Conformation C is represented by Roman numeral ____.
ANSWER: IV
POINTS: 1
QUESTION TYPE: Completion
HAS VARIABLES: False
PREFACE NAME: PE Diagram
DATE CREATED: 3/12/2015 3:24 PM
DATE MODIFIED: 3/12/2015 3:24 PM

76. Conformation D is represented by Roman numeral ____.
ANSWER: I
POINTS: 1
QUESTION TYPE: Completion
HAS VARIABLES: False
PREFACE NAME: PE Diagram
DATE CREATED: 3/12/2015 3:24 PM
DATE MODIFIED: 3/12/2015 3:24 PM

77. What is the IUPAC name of the following compound?

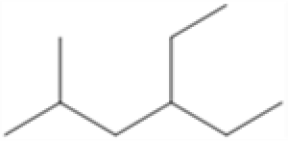

ANSWER: 4-ethyl-2-methylhexane
POINTS: 1
QUESTION TYPE: Subjective Short Answer
HAS VARIABLES: False
DATE CREATED: 3/12/2015 3:24 PM
DATE MODIFIED: 3/12/2015 3:24 PM

78. What is the IUPAC name of the following compound?

Copyright Cengage Learning. Powered by Cognero.

Organic Chemistry 8th edition Brown Test Bank

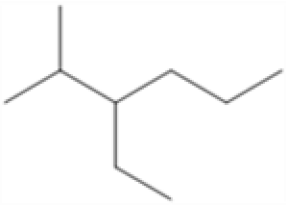

ANSWER: 3-ethyl-2-methylhexane
POINTS: 1
QUESTION TYPE: Subjective Short Answer
HAS VARIABLES: False
DATE CREATED: 3/12/2015 3:24 PM
DATE MODIFIED: 3/12/2015 3:24 PM

79. What is the IUPAC name of the following compound?

ANSWER: 2,4,4-trimethylhexane
POINTS: 1
QUESTION TYPE: Subjective Short Answer
HAS VARIABLES: False
DATE CREATED: 3/12/2015 3:24 PM
DATE MODIFIED: 3/12/2015 3:24 PM

80. What is the IUPAC name of the following compound?

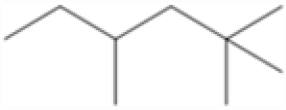

ANSWER: 2,2,4-trimethylhexane
POINTS: 1
QUESTION TYPE: Subjective Short Answer
HAS VARIABLES: False
DATE CREATED: 3/12/2015 3:24 PM
DATE MODIFIED: 3/12/2015 3:24 PM

81. What is the IUPAC name of the following compound?

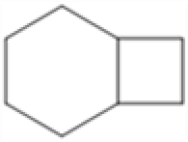

ANSWER: bicyclo[4.2.0]octane
POINTS: 1
QUESTION TYPE: Subjective Short Answer
HAS VARIABLES: False
DATE CREATED: 3/12/2015 3:24 PM
DATE MODIFIED: 3/12/2015 3:24 PM

Copyright Cengage Learning. Powered by Cognero.

Organic Chemistry 8th edition Brown Test Bank

82. What is the IUPAC name of the following compound?

ANSWER: bicyclo[2.2.1]heptane
POINTS: 1
QUESTION TYPE: Subjective Short Answer
HAS VARIABLES: False
DATE CREATED: 3/12/2015 3:24 PM
DATE MODIFIED: 3/12/2015 3:24 PM

83. What is the IUPAC name of the following compound?

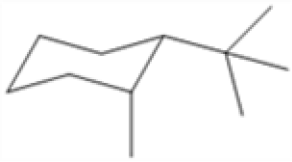

ANSWER: *cis*-1-*tert*-butyl-2-methylcyclohexane

[ignoring absolute stereochemistry in Chap 2]
POINTS: 1
QUESTION TYPE: Subjective Short Answer
HAS VARIABLES: False
DATE CREATED: 3/12/2015 3:24 PM
DATE MODIFIED: 3/12/2015 3:24 PM

84. What is the IUPAC name of the following compound?

ANSWER: *cis*-1-isopropyl-3-methylcyclohexane

[ignoring absolute stereochemistry in Chap 2]
POINTS: 1
QUESTION TYPE: Subjective Short Answer
HAS VARIABLES: False
DATE CREATED: 3/12/2015 3:24 PM
DATE MODIFIED: 3/12/2015 3:24 PM

85. How many hydrogen atoms are there in decane?
ANSWER: 22
POINTS: 1
QUESTION TYPE: Subjective Short Answer
HAS VARIABLES: False
DATE CREATED: 3/12/2015 3:24 PM
DATE MODIFIED: 3/12/2015 3:24 PM

Copyright Cengage Learning. Powered by Cognero.

Organic Chemistry 8th edition Brown Test Bank

86. How many hydrogen atoms are there in octane?

ANSWER: 18
POINTS: 1
QUESTION TYPE: Subjective Short Answer
HAS VARIABLES: False
DATE CREATED: 3/12/2015 3:24 PM
DATE MODIFIED: 3/12/2015 3:24 PM

87. What are the common and IUPAC names of the following compound?

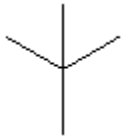

ANSWER: *common:* neopentane
IUPAC: 2,2-dimethylpropane
POINTS: 1
QUESTION TYPE: Subjective Short Answer
HAS VARIABLES: False
DATE CREATED: 3/12/2015 3:24 PM
DATE MODIFIED: 3/12/2015 3:24 PM

88. What are the common and IUPAC names of the following compound?

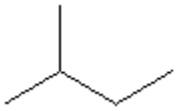

ANSWER: *common:* isopentane
IUPAC: 2-dimethylbutane
POINTS: 1
QUESTION TYPE: Subjective Short Answer
HAS VARIABLES: False
DATE CREATED: 3/12/2015 3:24 PM
DATE MODIFIED: 3/12/2015 3:24 PM

89. What is the IUPAC name of the following compound?

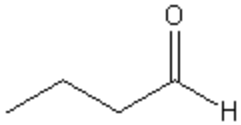

ANSWER: butanal
POINTS: 1
QUESTION TYPE: Subjective Short Answer
HAS VARIABLES: False
DATE CREATED: 3/12/2015 3:24 PM
DATE MODIFIED: 3/12/2015 3:24 PM

90. What is the IUPAC name of the following compound?

Copyright Cengage Learning. Powered by Cognero.

Organic Chemistry 8th edition Brown Test Bank

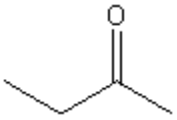

ANSWER: butanone
POINTS: 1
QUESTION TYPE: Subjective Short Answer
HAS VARIABLES: False
DATE CREATED: 3/12/2015 3:24 PM
DATE MODIFIED: 3/12/2015 3:24 PM

91. Provide a line-bond structure of hexanoic acid.
ANSWER:

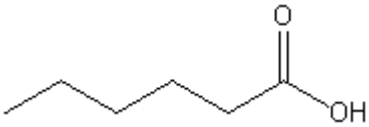

POINTS: 1
QUESTION TYPE: Subjective Short Answer
HAS VARIABLES: False
DATE CREATED: 3/12/2015 3:24 PM
DATE MODIFIED: 3/12/2015 3:24 PM

92. Provide a line-bond structure of pentanal.
ANSWER:



POINTS: 1
QUESTION TYPE: Subjective Short Answer
HAS VARIABLES: False
DATE CREATED: 3/12/2015 3:24 PM
DATE MODIFIED: 3/12/2015 3:24 PM

93. Provide a Newman projection of the most stable conformation of 2-methylpentane, $(CH_3)_2CHCH_2CH_2CH_3$, looking along the C2-C3 bond
ANSWER:

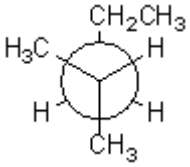

POINTS: 1
QUESTION TYPE: Subjective Short Answer
HAS VARIABLES: False
DATE CREATED: 3/12/2015 3:24 PM
DATE MODIFIED: 3/10/2017 5:50 AM

94. Provide a Newman projection of the most stable conformation of 3-methylpentane, $CH_3CH_2CH(CH_3)CH_2CH_3$ looking along the C2-C3 bond.

Copyright Cengage Learning. Powered by Cognero.

Organic Chemistry 8th edition Brown Test Bank

ANSWER:

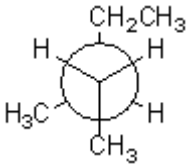

POINTS: 1
QUESTION TYPE: Subjective Short Answer
HAS VARIABLES: False
DATE CREATED: 3/12/2015 3:24 PM
DATE MODIFIED: 3/12/2015 3:24 PM

95. Provide a neatly drawn plot of energy versus dihedral angle for rotation around the C2-C3 bond of butane.

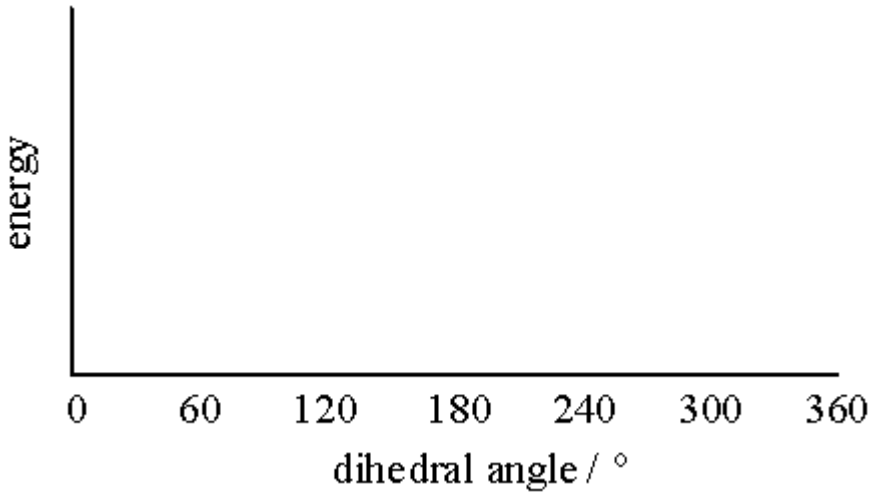

ANSWER:

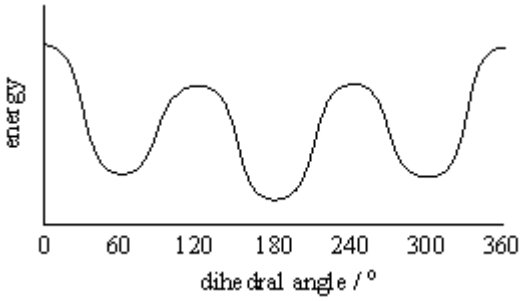

POINTS: 1
QUESTION TYPE: Subjective Short Answer
HAS VARIABLES: False
DATE CREATED: 3/12/2015 3:24 PM
DATE MODIFIED: 3/12/2015 3:24 PM

96. Provide a neatly drawn plot of energy versus dihedral angle for rotation around the C-C bond of ethane.

Copyright Cengage Learning. Powered by Cognero.

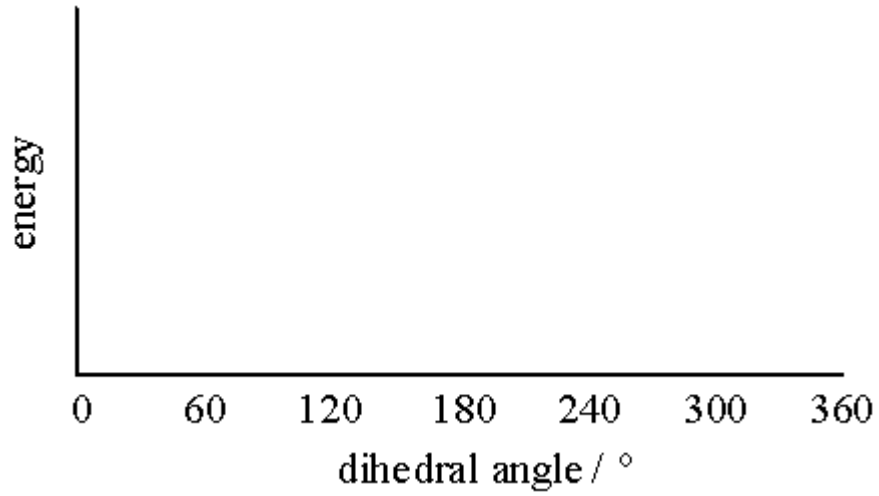

ANSWER:

POINTS: 1
QUESTION TYPE: Subjective Short Answer
HAS VARIABLES: False
DATE CREATED: 3/12/2015 3:24 PM
DATE MODIFIED: 3/12/2015 3:24 PM

97. Identify the constitutional isomer with the molecular formula C_7H_{16}.

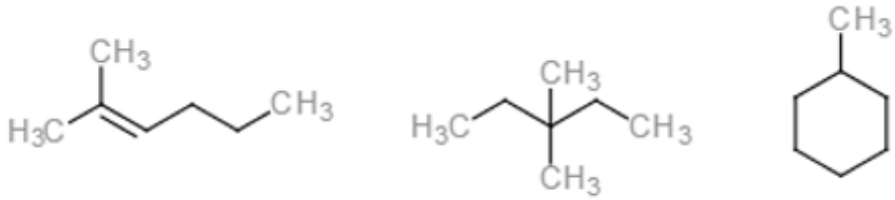

I II III

a. Only I
b. Only I and II
c. Only II
d. I, II, and III

ANSWER: c
POINTS: 1
QUESTION TYPE: Multiple Choice
HAS VARIABLES: False
DATE CREATED: 4/11/2017 7:38 AM

Copyright Cengage Learning. Powered by Cognero.

DATE MODIFIED: 4/13/2017 1:02 AM

98. The molecular formulas of neopentane and isobutane are _____ and _____, respectively.

a. C_5H_{12}; C_4H_8

b. C_5H_{10}; C_4H_{10}

c. C_5H_{12}; C_4H_{11}

d. C_5H_{12}; C_4H_{10}

ANSWER: d
POINTS: 1
QUESTION TYPE: Multiple Choice
HAS VARIABLES: False
DATE CREATED: 4/11/2017 7:54 AM
DATE MODIFIED: 4/11/2017 7:55 AM

99. The total numbers of 2º and 3º carbon atoms in the following structure are _____ and _____, respectively.

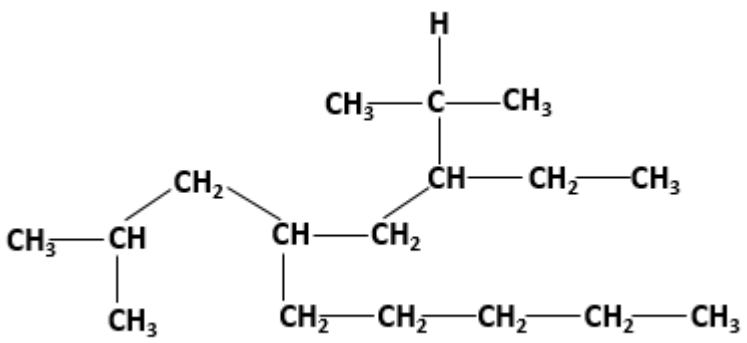

a. 3; 7

b. 7; 4

c. 4; 6

d. 6; 4

ANSWER: b
POINTS: 1
QUESTION TYPE: Multiple Choice
HAS VARIABLES: False
DATE CREATED: 4/11/2017 7:57 AM
DATE MODIFIED: 4/11/2017 8:00 AM

100. What is "X" in the following reaction?

$$H_3C{-}OH + CO \xrightarrow{\text{Catalyst}} X$$

a. $H_3C{-}\overset{\overset{\displaystyle O}{\|}}{C}{-}OH$

b. $HC{\equiv}CH$

Copyright Cengage Learning. Powered by Cognero.

Organic Chemistry 8th edition Brown Test Bank

c. 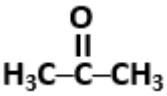

d. 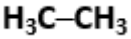

ANSWER: a
POINTS: 1
QUESTION TYPE: Multiple Choice
HAS VARIABLES: False
DATE CREATED: 4/11/2017 8:01 AM
DATE MODIFIED: 4/11/2017 8:09 AM

101. What is "X" in the following reaction?

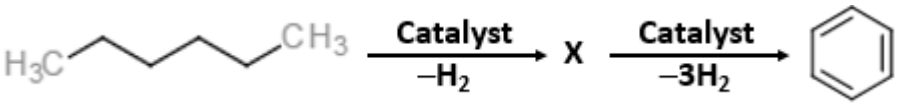

a.

b. 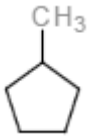

c. 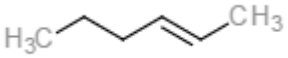

d. 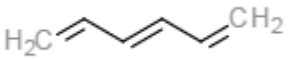

ANSWER: a
POINTS: 1
QUESTION TYPE: Multiple Choice
HAS VARIABLES: False
DATE CREATED: 4/11/2017 8:04 AM
DATE MODIFIED: 4/11/2017 8:09 AM

102. What is "X" in the following reaction?

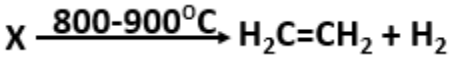

a.

b.

c. 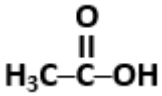

d. 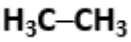

ANSWER: d

Copyright Cengage Learning. Powered by Cognero.

POINTS: 1
QUESTION TYPE: Multiple Choice
HAS VARIABLES: False
DATE CREATED: 4/11/2017 8:10 AM
DATE MODIFIED: 4/19/2017 12:56 AM

Match the structures with their IUPAC names.

a.
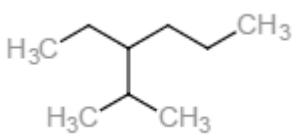

b.
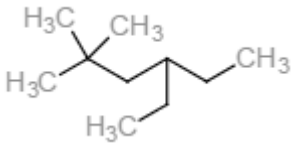

c.
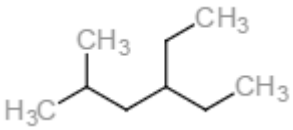

QUESTION TYPE: Matching
HAS VARIABLES: False
DATE CREATED: 4/11/2017 8:15 AM
DATE MODIFIED: 4/11/2017 8:26 AM

103. 3-ethyl-2-methylhexane
ANSWER: a
POINTS: 1

104. 4-ethyl-2,2-dimethylhexane
ANSWER: b
POINTS: 1

105. 4-ethyl-2-methylhexane
ANSWER: c
POINTS: 1

Copyright Cengage Learning. Powered by Cognero.

Organic Chemistry 8th edition Brown Test Bank